Определение площади по секторам Имя:

Определите площадь прямоугольников, разбивая на сектора. Первый уже разбит.

1)

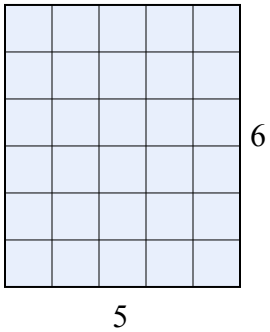

2)

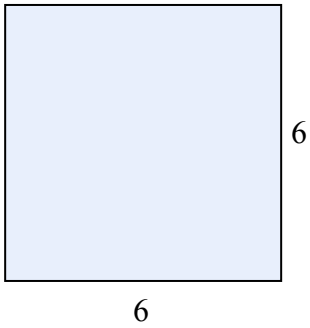

3)

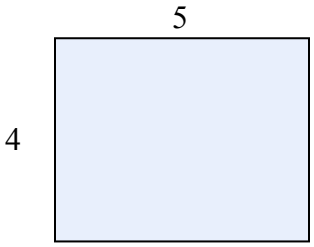

4)



5)



6)

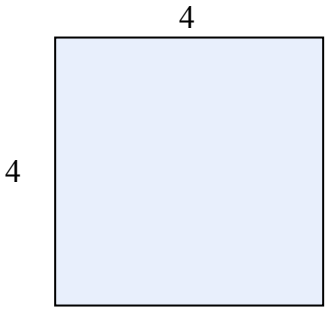

7)

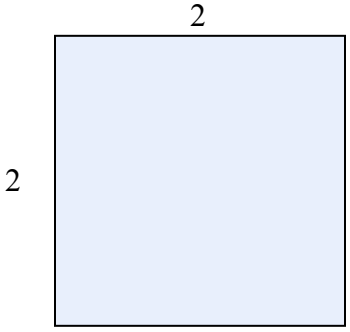

8)

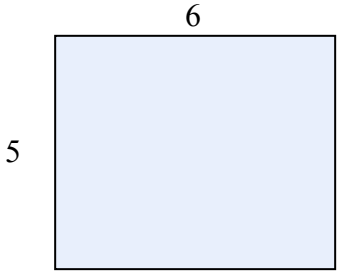

9)

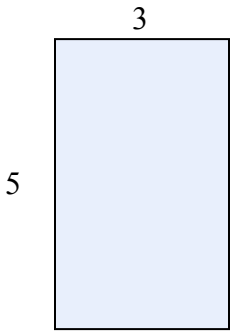

10)

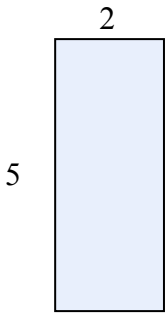

Ответы

1. _____
2. _____
3. _____
4. _____
5. _____
6. _____
7. _____
8. _____
9. _____
10. _____

1-10	90	80	70	60	50	40	30	20	10	0

Определение площади по секторам Имя: Ключ к правильным ответам

Определите площадь прямоугольников, разбивая на сектора. Первый уже разбит.

1)

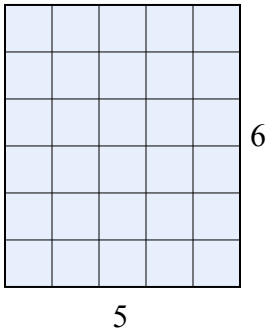

2)

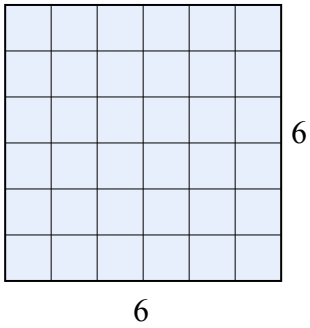

3)

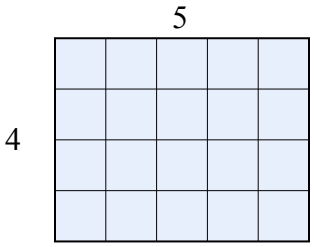

4)

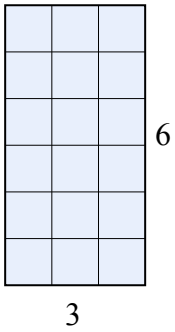

5)

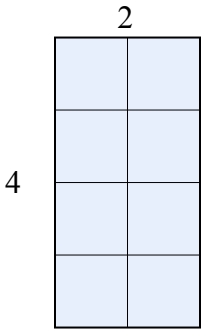

6)

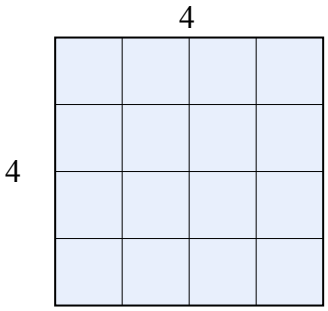

7)

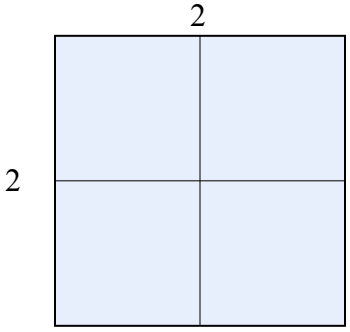

8)

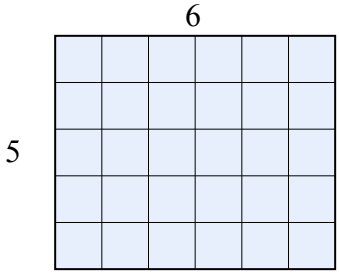

9)

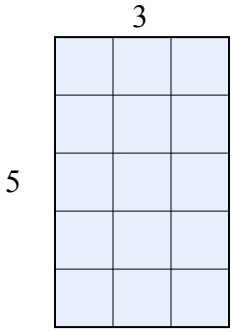

10)

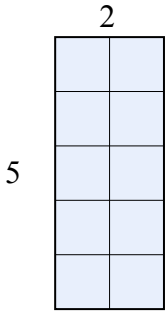

Ответы

1. 30
2. 36
3. 20
4. 18
5. 8
6. 16
7. 4
8. 30
9. 15
10. 10

1-10	90	80	70	60	50	40	30	20	10	0