Определение площади по секторам Имя:

Определите площадь прямоугольников, разбивая на сектора. Первый уже разбит.

1)

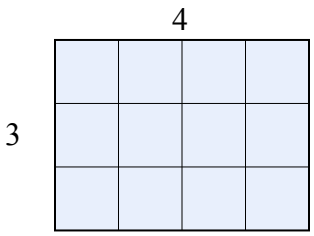

2)

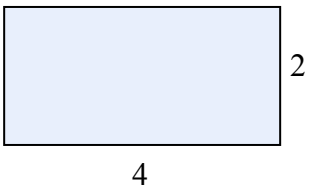

3)

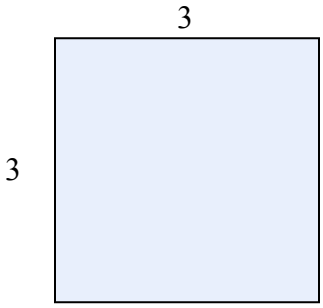

4)

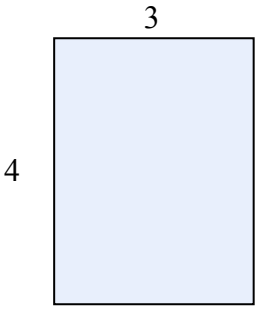

5)



6)

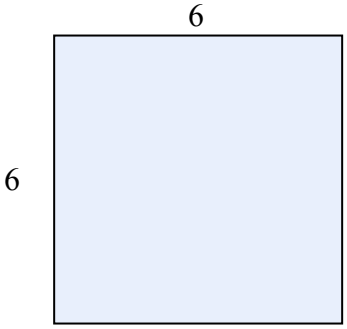

7)

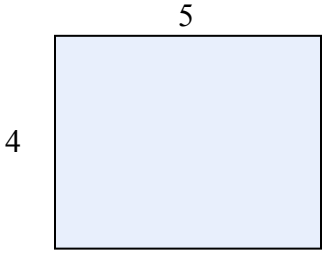

8)

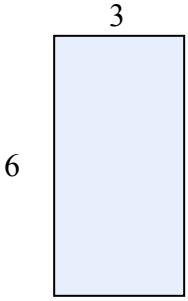

9)

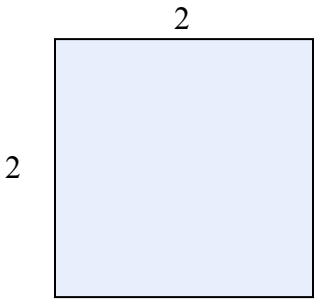

10)

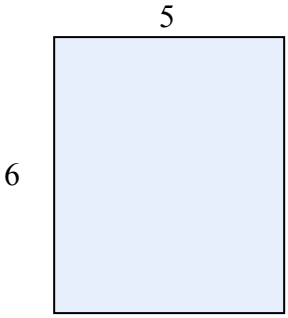

Ответы

1. _____
2. _____
3. _____
4. _____
5. _____
6. _____
7. _____
8. _____
9. _____
10. _____

1-10	90	80	70	60	50	40	30	20	10	0

Определение площади по секторам Имя: Ключ к правильным ответам

Определите площадь прямоугольников, разбивая на сектора. Первый уже разбит.

1)

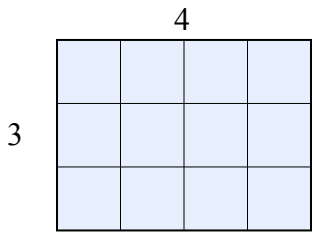

2)

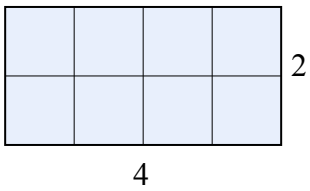

3)

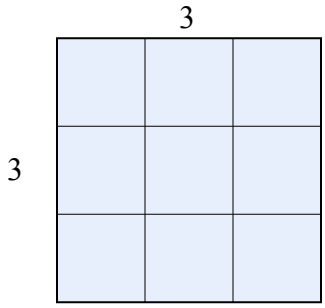

4)

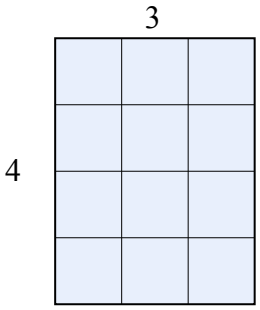

5)

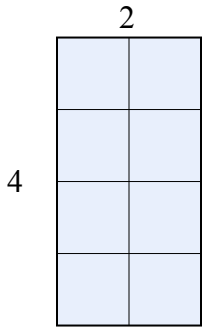

6)

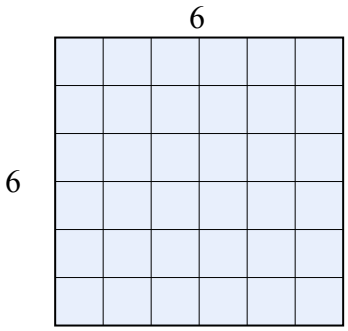

7)

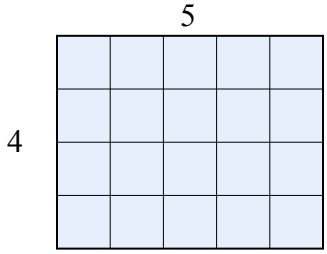

8)

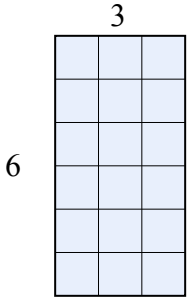

9)

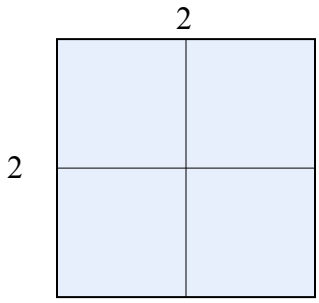

10)

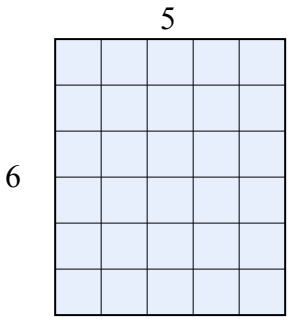

Ответы

1. 12
2. 8
3. 9
4. 12
5. 8
6. 36
7. 20
8. 18
9. 4
10. 30

1-10	90	80	70	60	50	40	30	20	10	0