Определение площади Имя:

Определите площади прямоугольников.

1)

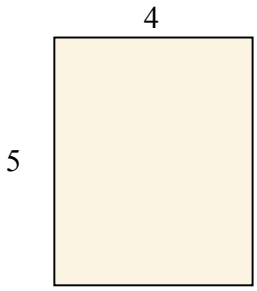

2)



3)



4)

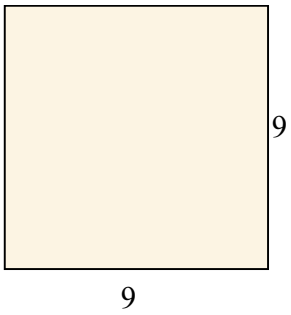

5)

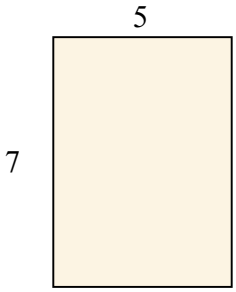

6)

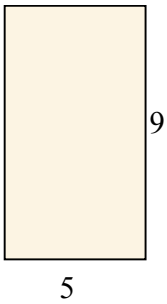

7)

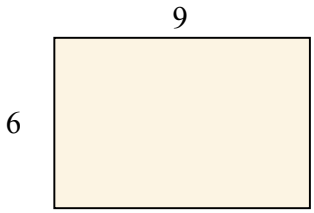

8)

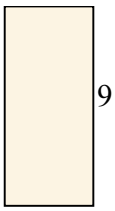

9)

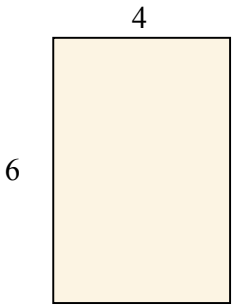

10)

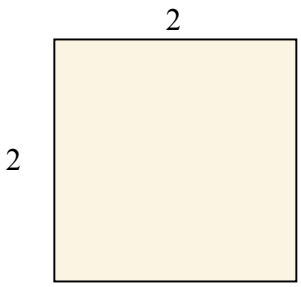

11)

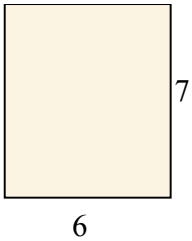

12)

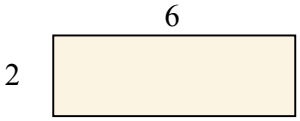

Ответы

1. _____
2. _____
3. _____
4. _____
5. _____
6. _____
7. _____
8. _____
9. _____
10. _____
11. _____
12. _____

1-10	92	83	75	67	58	50	42	33	25	17
11-12	8	0								

Определение площади

Имя: **Ключ к правильным ответам**

Определите площади прямоугольников.

1)

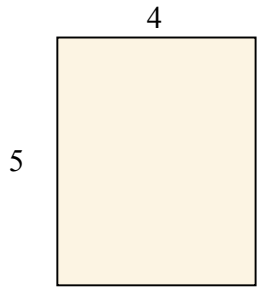

2)

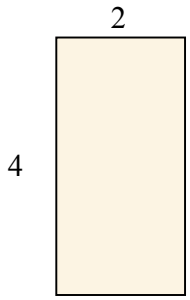

3)



4)

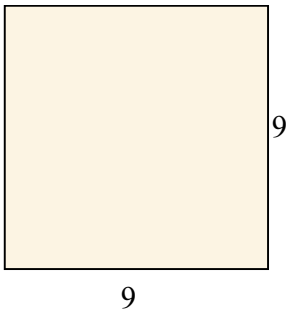

5)

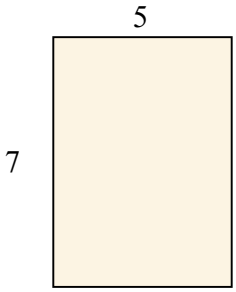

6)

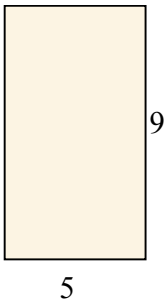

7)

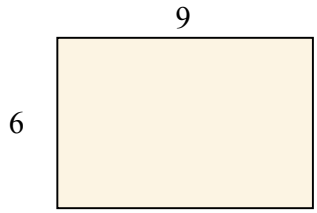

8)

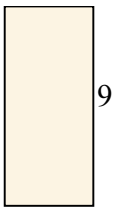

9)

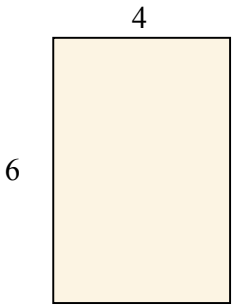

10)

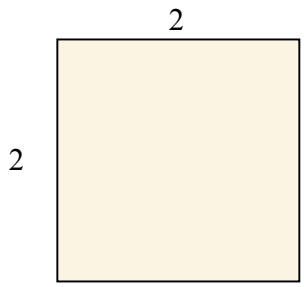

11)

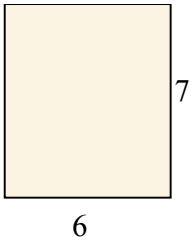

12)

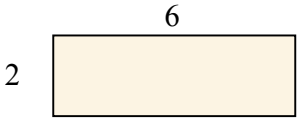

Ответы

1. **20**
2. **8**
3. **54**
4. **81**
5. **35**
6. **45**
7. **54**
8. **36**
9. **24**
10. **4**
11. **42**
12. **12**

1-10	92	83	75	67	58	50	42	33	25	17
11-12	8	0								