Определение площади треугольника. Имя:

Определите площадь каждого треугольника.Единицы не являются шкалами.

1)

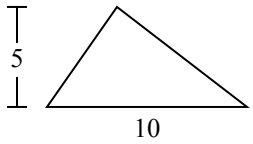

2)

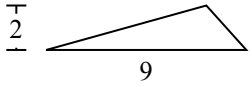

3)

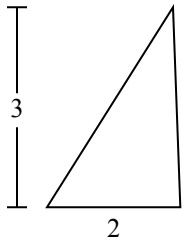

4)

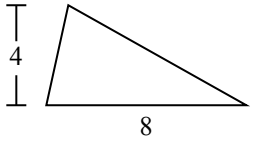

5)

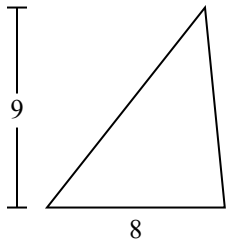

6)

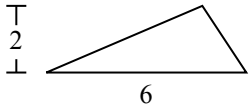

7)

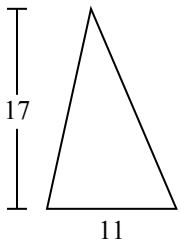

8)

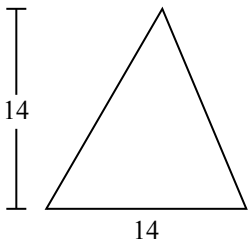

9)

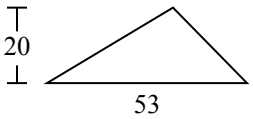

10)

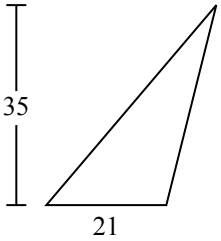

Ответы

1. _____
2. _____
3. _____
4. _____
5. _____
6. _____
7. _____
8. _____
9. _____
10. _____

1-10	90	80	70	60	50	40	30	20	10	0

Определение площади треугольника. Имя: Ключ к правильным ответам

Определите площадь каждого треугольника.Единицы не являются шкалами.

1)

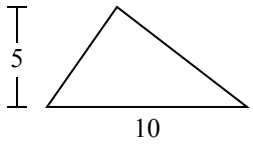

2)

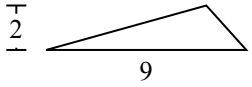

3)

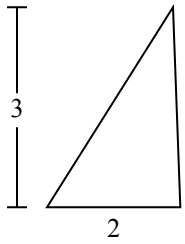

4)

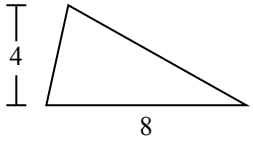

5)

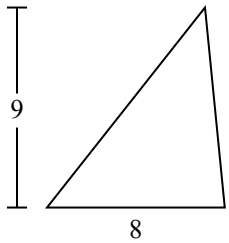

6)

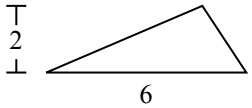

7)

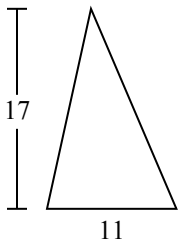

8)

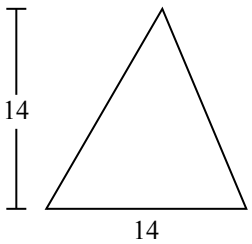

9)

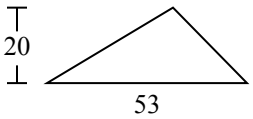

10)

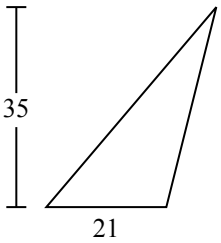

Ответы

1. 25
2. 9
3. 3
4. 16
5. 36
6. 6
7. 93,5
8. 98
9. 530
10. 367,5

1-10	90	80	70	60	50	40	30	20	10	0

Определение площади треугольника. Имя:

Определите площадь каждого треугольника.Единицы не являются шкалами.

93,5	98	530	25	9
6	36	16	3	

1)

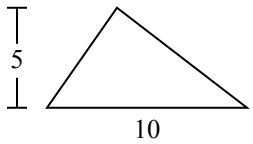

2)

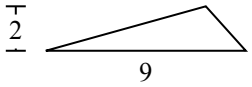

3)

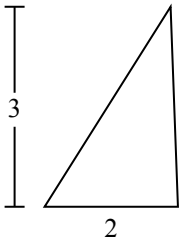

4)

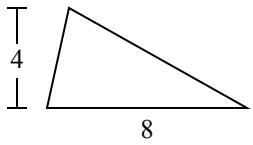

5)

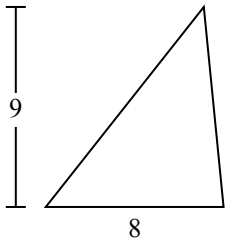

6)

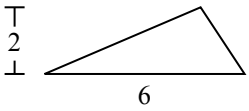

7)

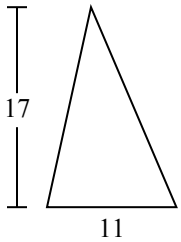

8)

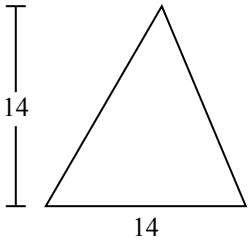

9)

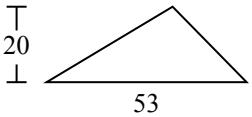

Ответы

1. _____
2. _____
3. _____
4. _____
5. _____
6. _____
7. _____
8. _____
9. _____

1-9	89	78	67	56	44	33	22	11	0

Определение площади треугольника. Имя:

Определите площадь каждого треугольника.Единицы не являются шкалами.

1)

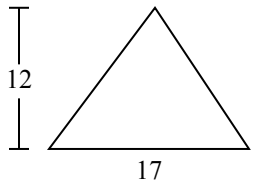

2)

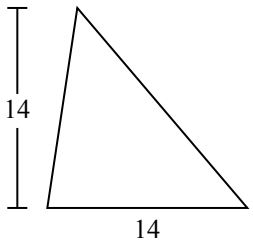

3)

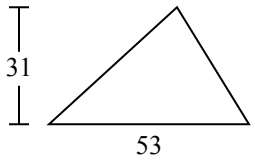

4)

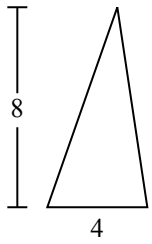

5)

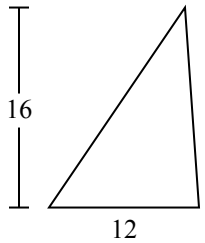

6)

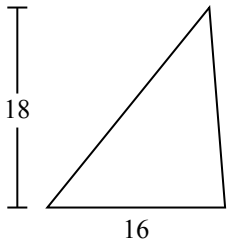

7)

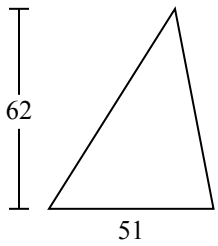

8)

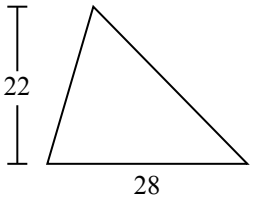

9)

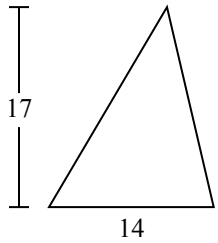

10)

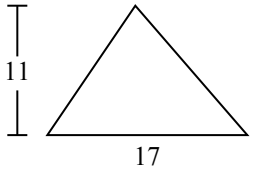

Ответы

1. _____
2. _____
3. _____
4. _____
5. _____
6. _____
7. _____
8. _____
9. _____
10. _____

1-10	90	80	70	60	50	40	30	20	10	0

Определение площади треугольника. Имя: Ключ к правильным ответам

Определите площадь каждого треугольника.Единицы не являются шкалами.

1)

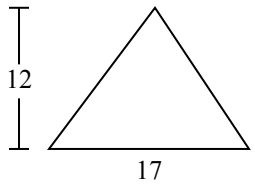

2)

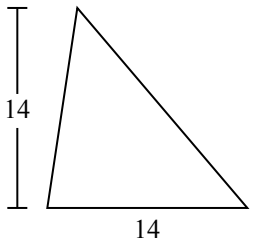

3)

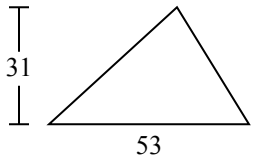

4)

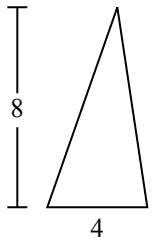

5)

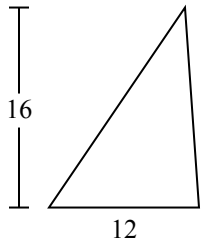

6)

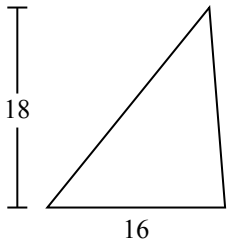

7)

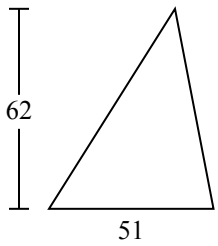

8)

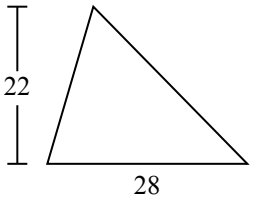

9)

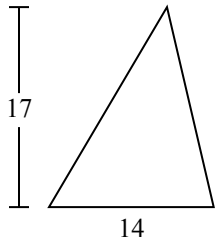

10)

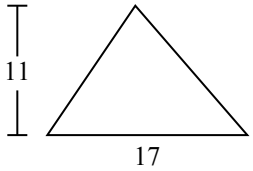

Ответы

1. 102
2. 98
3. 821,5
4. 16
5. 96
6. 144
7. 1 581
8. 308
9. 119
10. 93,5

1-10	90	80	70	60	50	40	30	20	10	0

Определение площади треугольника. Имя:

Определите площадь каждого треугольника.Единицы не являются шкалами.

102	1 581	308	144	16
119	821,5	98	96	

1)

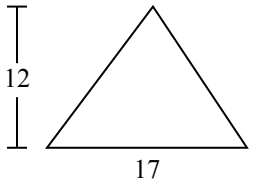

2)

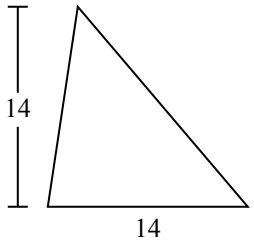

3)

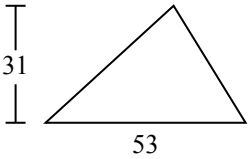

4)

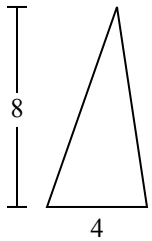

5)

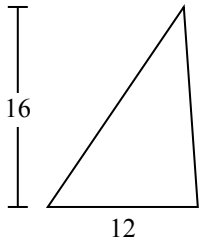

6)

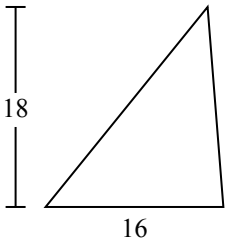

7)

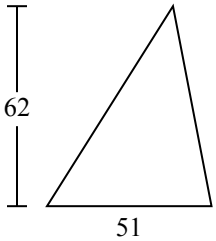

8)

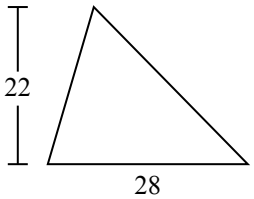

9)

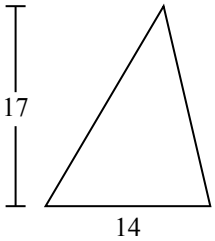

Ответы

1. _____
2. _____
3. _____
4. _____
5. _____
6. _____
7. _____
8. _____
9. _____

1-9	89	78	67	56	44	33	22	11	0

Определение площади треугольника. Имя:

Определите площадь каждого треугольника.Единицы не являются шкалами.

1)

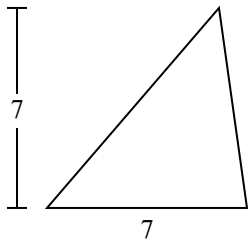

2)

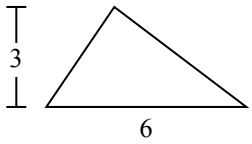

3)

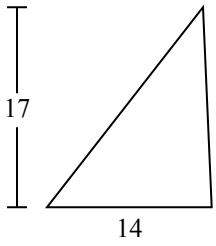

4)

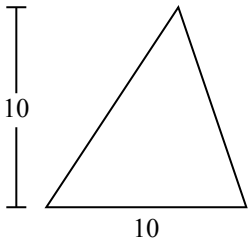

5)

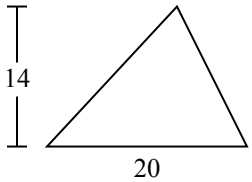

6)

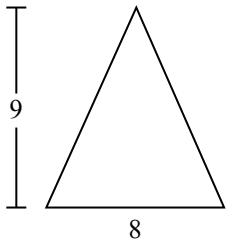

7)

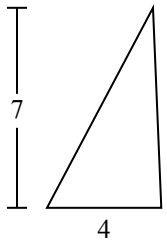

8)

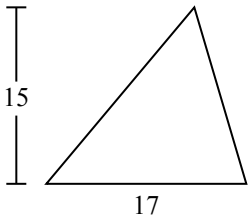

9)

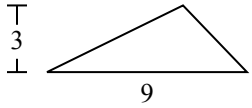

10)

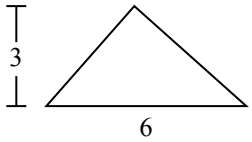

Ответы

1. _____
2. _____
3. _____
4. _____
5. _____
6. _____
7. _____
8. _____
9. _____
10. _____

1-10	90	80	70	60	50	40	30	20	10	0

Определение площади треугольника. Имя: Ключ к правильным ответам

Определите площадь каждого треугольника.Единицы не являются шкалами.

1)

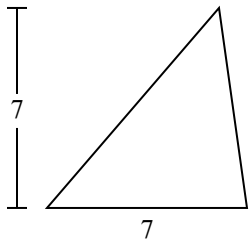

2)

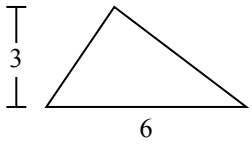

3)

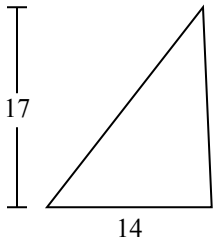

4)

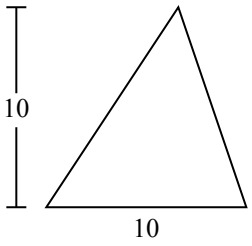

5)

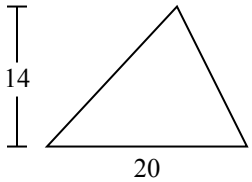

6)

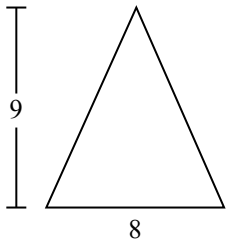

7)

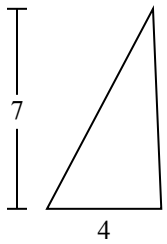

8)

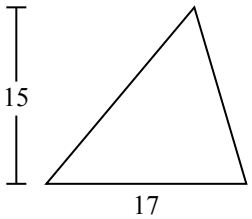

9)

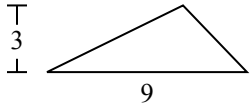

10)

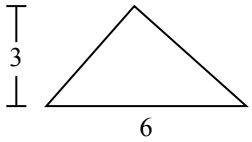

Ответы

1. 24,5
2. 9
3. 119
4. 50
5. 140
6. 36
7. 14
8. 127,5
9. 13,5
10. 9

1-10	90	80	70	60	50	40	30	20	10	0

Определение площади треугольника. Имя:

Определите площадь каждого треугольника.Единицы не являются шкалами.

127,5	13,5	119	140	14
24,5	9	36	50	

1)

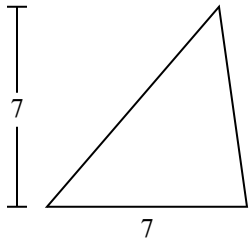

2)

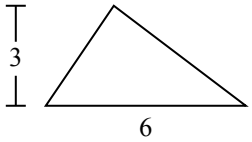

3)

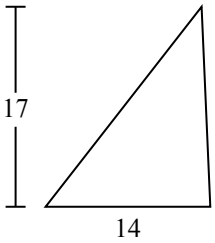

4)

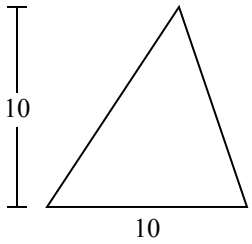

5)

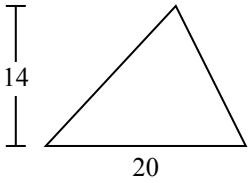

6)

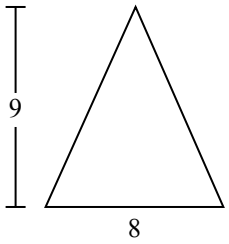

7)

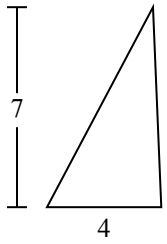

8)

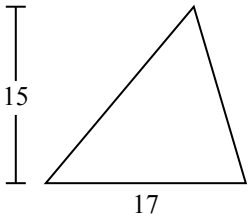

9)

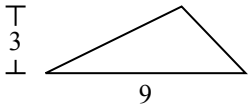

Ответы

1. _____
2. _____
3. _____
4. _____
5. _____
6. _____
7. _____
8. _____
9. _____

1-9	89	78	67	56	44	33	22	11	0

Определение площади треугольника. Имя:

Определите площадь каждого треугольника.Единицы не являются шкалами.

1)

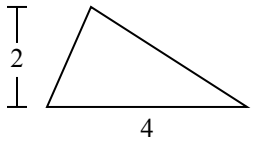

2)

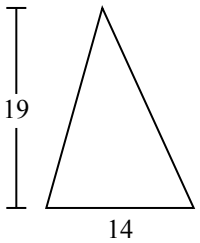

3)

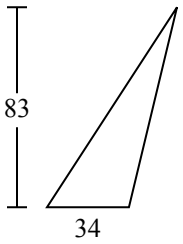

4)

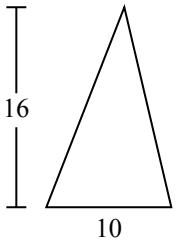

5)

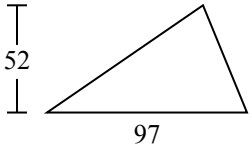

6)

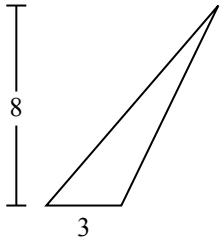

7)

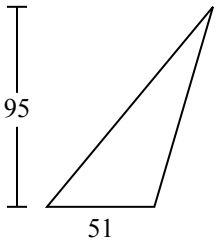

8)

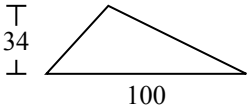

9)

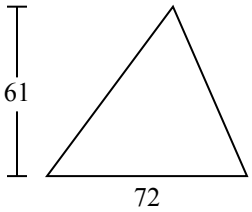

10)

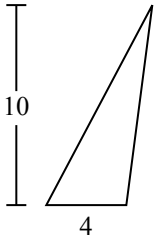

Ответы

1. _____
2. _____
3. _____
4. _____
5. _____
6. _____
7. _____
8. _____
9. _____
10. _____

1-10	90	80	70	60	50	40	30	20	10	0

Определение площади треугольника. Имя: Ключ к правильным ответам

Определите площадь каждого треугольника.Единицы не являются шкалами.

1)

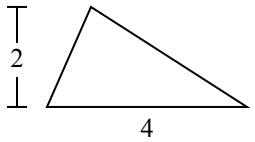

2)

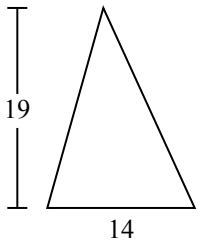

3)

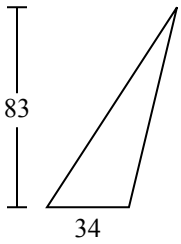

4)

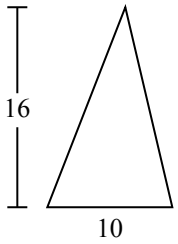

5)

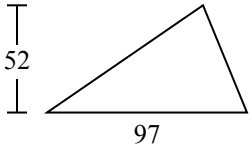

6)

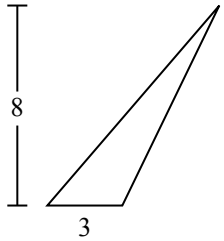

7)

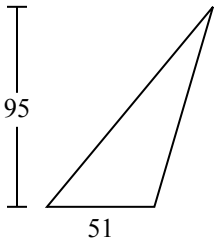

8)

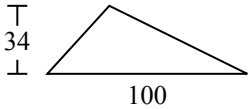

9)

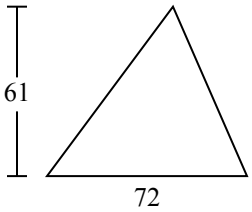

10)

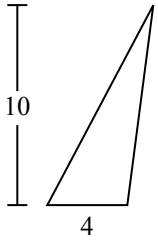

Ответы

1. 4
2. 133
3. 1 411
4. 80
5. 2 522
6. 12
7. 2 422,5
8. 1 700
9. 2 196
10. 20

1-10	90	80	70	60	50	40	30	20	10	0

Определение площади треугольника. Имя:

Определите площадь каждого треугольника.Единицы не являются шкалами.

133	4	1 411	2 522	2 196
1 700	2 422,5	80	12	

1)

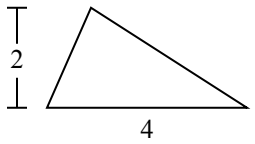

2)

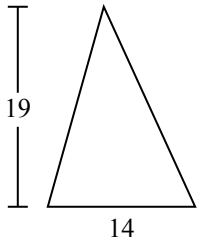

3)

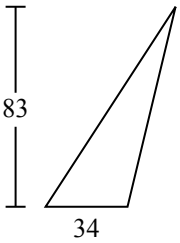

4)

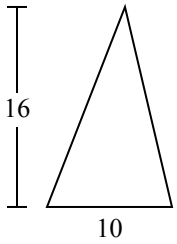

5)

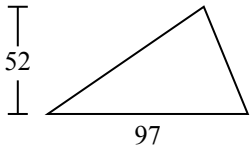

6)

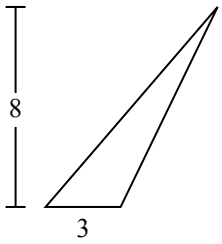

7)

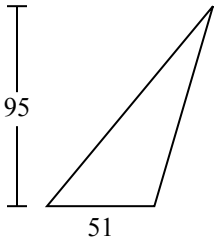

8)

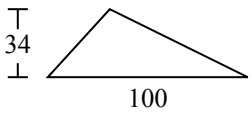

9)

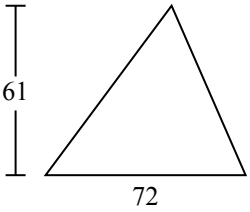

Ответы

1. _____
2. _____
3. _____
4. _____
5. _____
6. _____
7. _____
8. _____
9. _____

1-9	89	78	67	56	44	33	22	11	0

Определение площади треугольника. Имя:

Определите площадь каждого треугольника.Единицы не являются шкалами.

1)

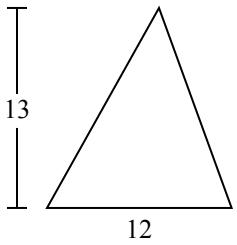

2)

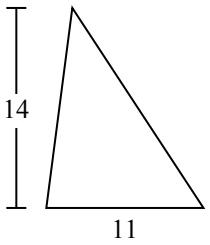

3)

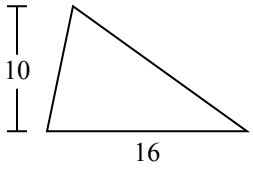

4)

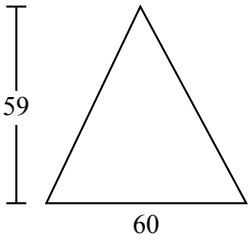

5)

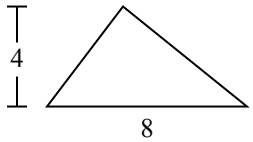

6)

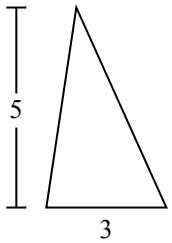

7)

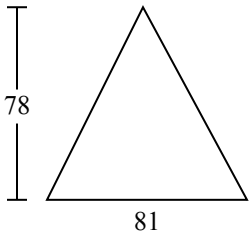

8)

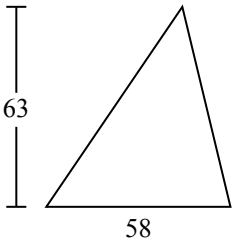

9)

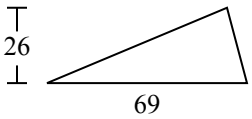

10)

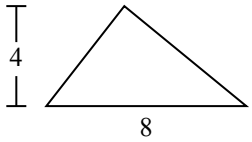

Ответы

1. _____
2. _____
3. _____
4. _____
5. _____
6. _____
7. _____
8. _____
9. _____
10. _____

1-10	90	80	70	60	50	40	30	20	10	0

Определение площади треугольника. Имя: Ключ к правильным ответам

Определите площадь каждого треугольника.Единицы не являются шкалами.

1)

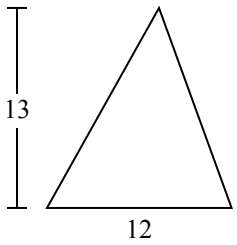

2)

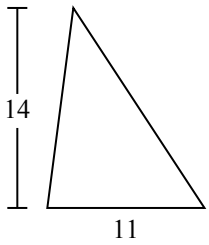

3)

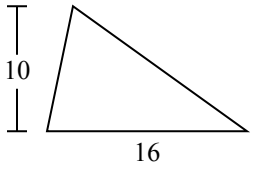

4)

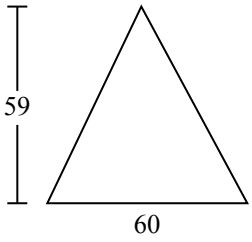

5)

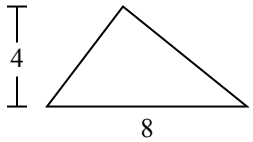

6)

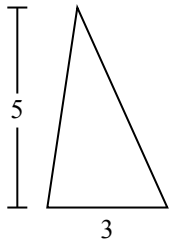

7)

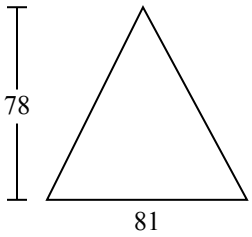

8)

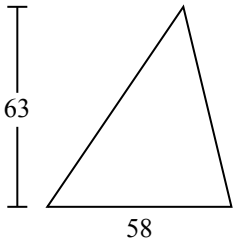

9)

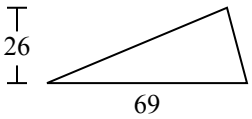

10)

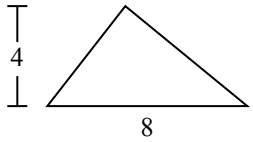

Ответы

1. 78
2. 77
3. 80
4. 1 770
5. 16
6. 7,5
7. 3 159
8. 1 827
9. 897
10. 16

1-10	90	80	70	60	50	40	30	20	10	0

Определение площади треугольника. Имя:

Определите площадь каждого треугольника.Единицы не являются шкалами.

1 827	1 770	7,5	78	3 159
80	77	897	16	

1)

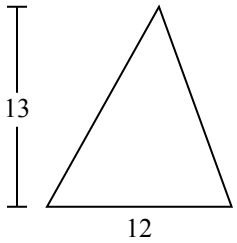

2)

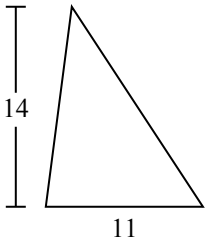

3)

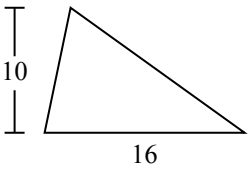

4)

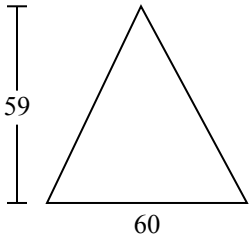

5)

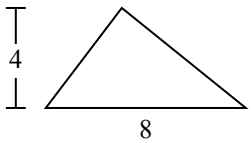

6)

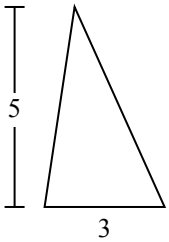

7)

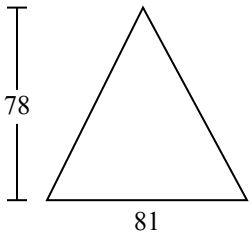

8)

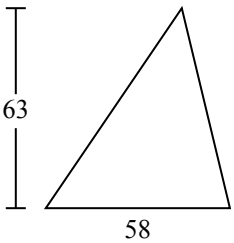

9)

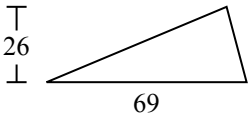

Ответы

1. _____
2. _____
3. _____
4. _____
5. _____
6. _____
7. _____
8. _____
9. _____

1-9	89	78	67	56	44	33	22	11	0

Определение площади треугольника. Имя:

Определите площадь каждого треугольника.Единицы не являются шкалами.

1)

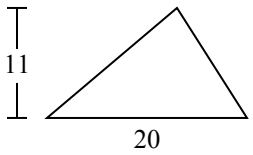

2)

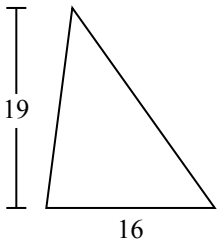

3)

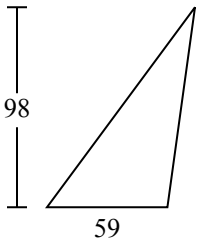

4)

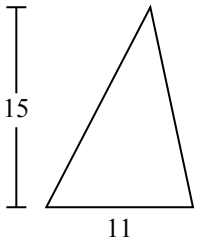

5)

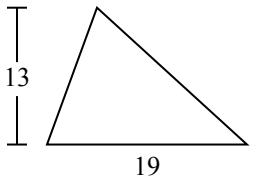

6)

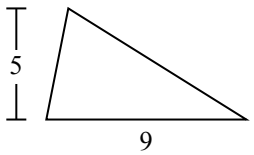

7)

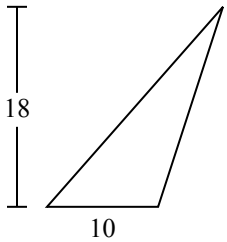

8)

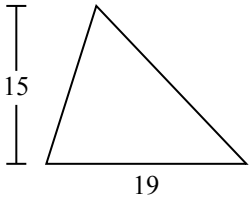

9)

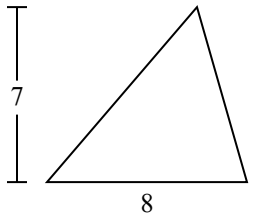

10)

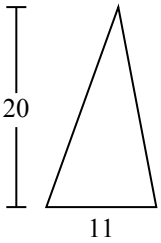

Ответы

1. _____
2. _____
3. _____
4. _____
5. _____
6. _____
7. _____
8. _____
9. _____
10. _____

1-10	90	80	70	60	50	40	30	20	10	0

Определение площади треугольника. Имя: Ключ к правильным ответам

Определите площадь каждого треугольника.Единицы не являются шкалами.

1)

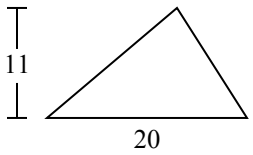

2)

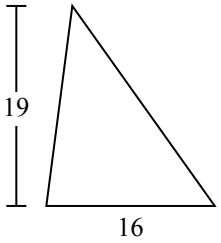

3)

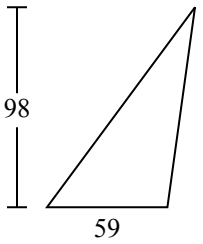

4)

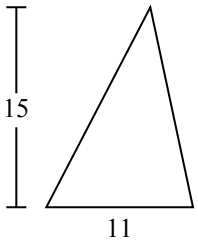

5)

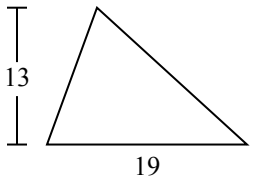

6)

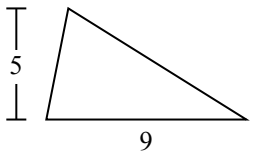

7)

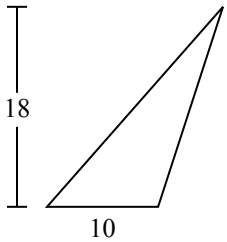

8)

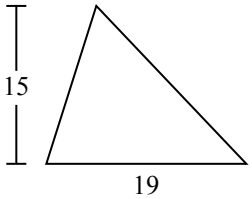

9)

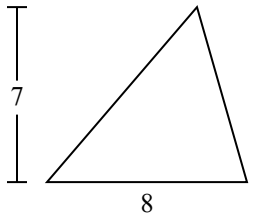

10)

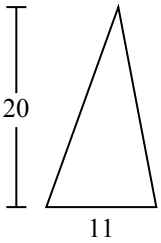

Ответы

1. 110
2. 152
3. 2 891
4. 82,5
5. 123,5
6. 22,5
7. 90
8. 142,5
9. 28
10. 110

1-10	90	80	70	60	50	40	30	20	10	0

Определение площади треугольника. Имя:

Определите площадь каждого треугольника.Единицы не являются шкалами.

22,5	152	28	90	142,5
123,5	2 891	82,5	110	

1)

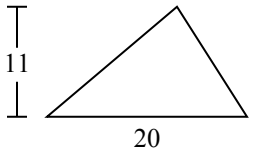

2)

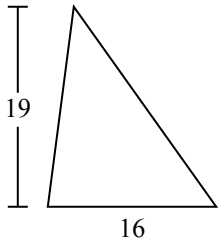

3)

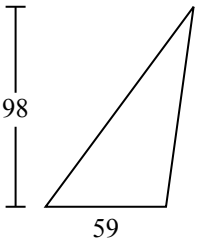

4)

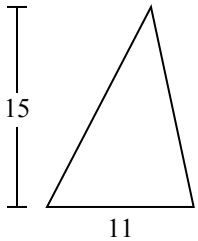

5)

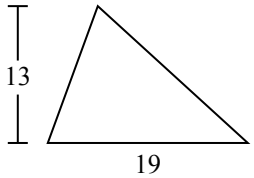

6)

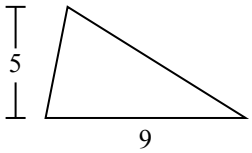

7)

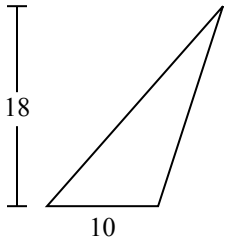

8)

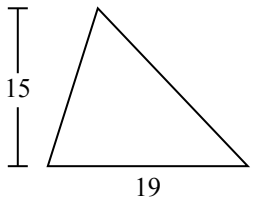

9)

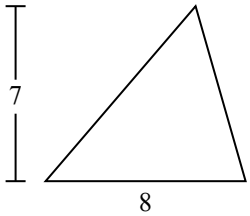

Ответы

1. _____
2. _____
3. _____
4. _____
5. _____
6. _____
7. _____
8. _____
9. _____

1-9	89	78	67	56	44	33	22	11	0

Определение площади треугольника. Имя:

Определите площадь каждого треугольника.Единицы не являются шкалами.

1)

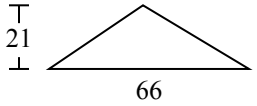

2)

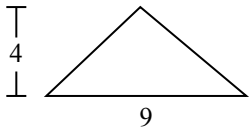

3)

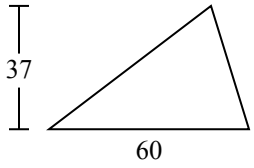

4)

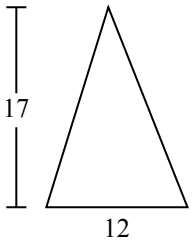

5)

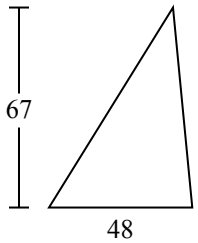

6)

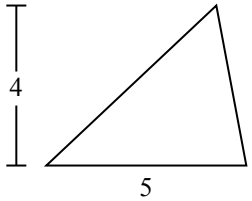

7)

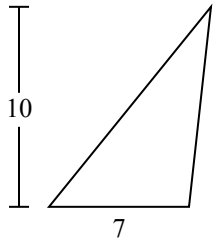

8)

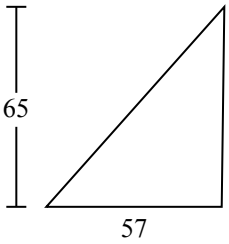

9)

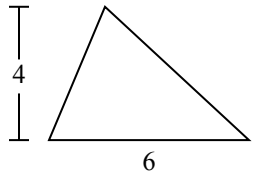

10)

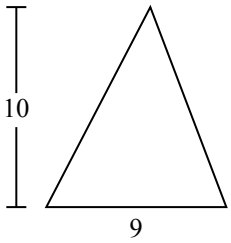

Ответы

1. _____
2. _____
3. _____
4. _____
5. _____
6. _____
7. _____
8. _____
9. _____
10. _____

1-10	90	80	70	60	50	40	30	20	10	0

Определение площади треугольника. Имя: Ключ к правильным ответам

Определите площадь каждого треугольника.Единицы не являются шкалами.

1)

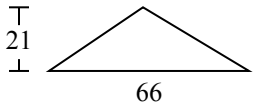

2)

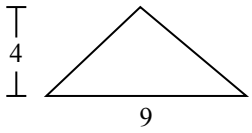

3)

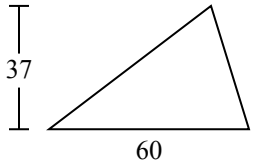

4)

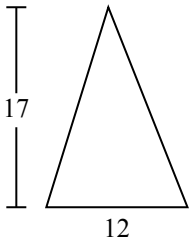

5)

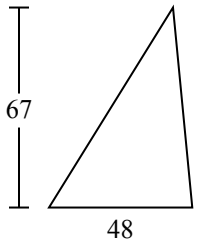

6)

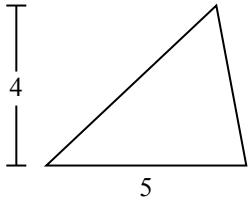

7)

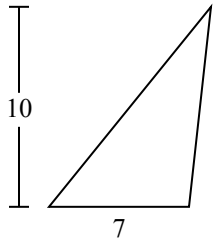

8)

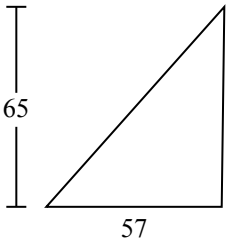

9)

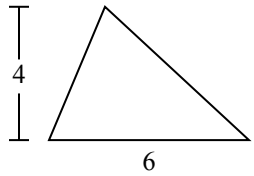

10)

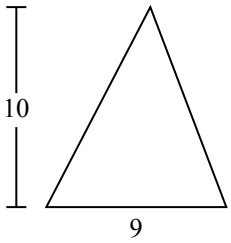

Ответы

1. 693
2. 18
3. 1 110
4. 102
5. 1 608
6. 10
7. 35
8. 1 852,5
9. 12
10. 45

1-10	90	80	70	60	50	40	30	20	10	0

Определение площади треугольника. Имя:

Определите площадь каждого треугольника.Единицы не являются шкалами.

1 110	693	102	1 852,5	10
18	12	1 608	35	

1)

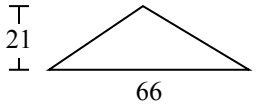

2)

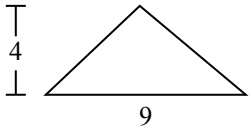

3)

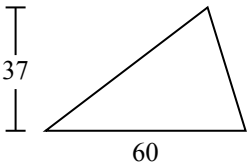

4)

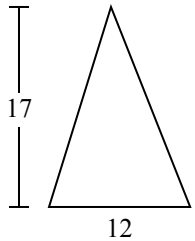

5)

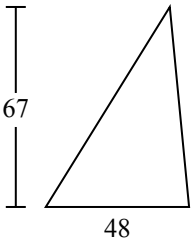

6)

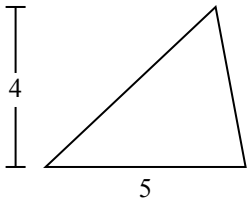

7)

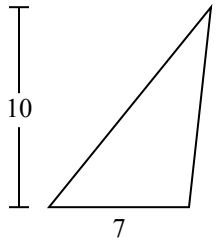

8)

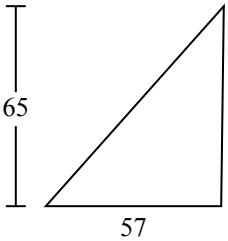

9)

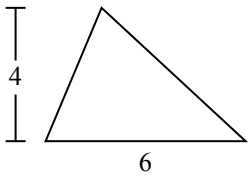

Ответы

1. _____
2. _____
3. _____
4. _____
5. _____
6. _____
7. _____
8. _____
9. _____

1-9	89	78	67	56	44	33	22	11	0

Определение площади треугольника. Имя:

Определите площадь каждого треугольника.Единицы не являются шкалами.

1)

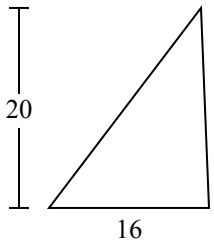

2)

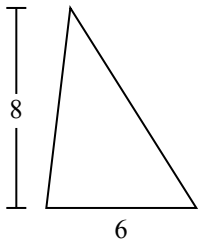

3)

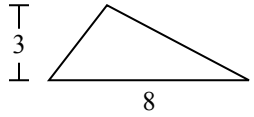

4)

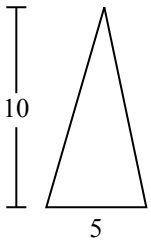

5)

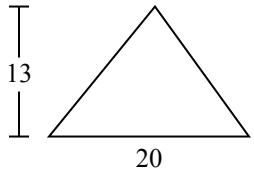

6)

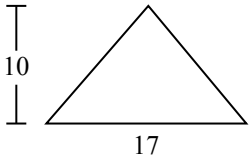

7)

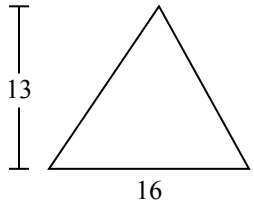

8)

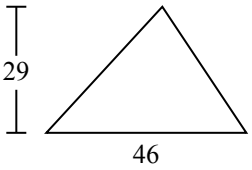

9)

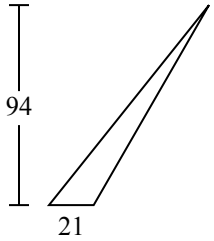

10)

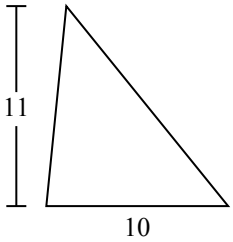

Ответы

1. _____
2. _____
3. _____
4. _____
5. _____
6. _____
7. _____
8. _____
9. _____
10. _____

1-10	90	80	70	60	50	40	30	20	10	0

Определение площади треугольника. Имя: Ключ к правильным ответам

Определите площадь каждого треугольника.Единицы не являются шкалами.

1)

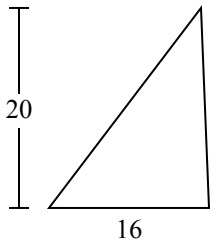

2)

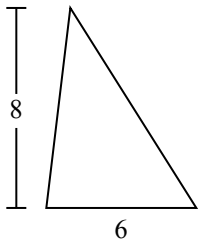

3)

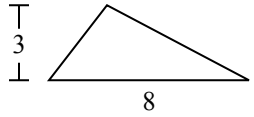

4)

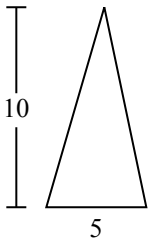

5)

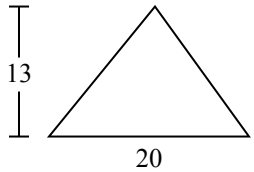

6)

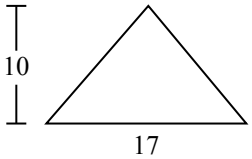

7)

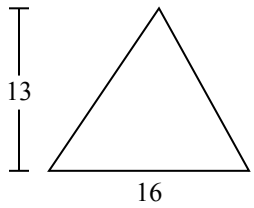

8)

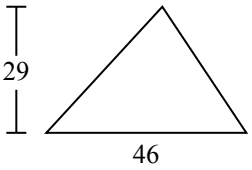

9)

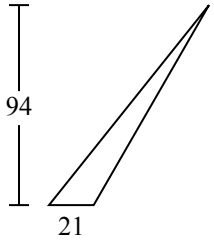

10)

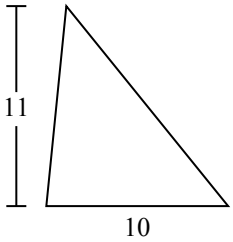

Ответы

1. 160
2. 24
3. 12
4. 25
5. 130
6. 85
7. 104
8. 667
9. 987
10. 55

1-10	90	80	70	60	50	40	30	20	10	0

Определение площади треугольника. Имя:

Определите площадь каждого треугольника.Единицы не являются шкалами.

25	160	85	24	667
987	104	12	130	

1)

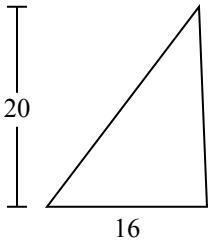

2)

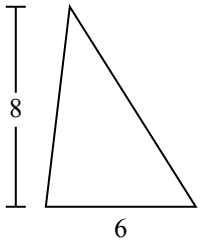

3)

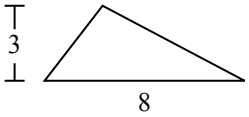

4)

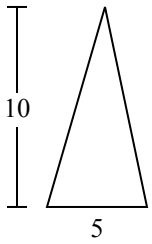

5)

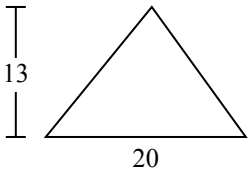

6)

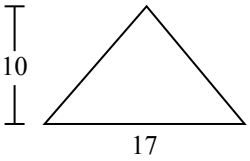

7)

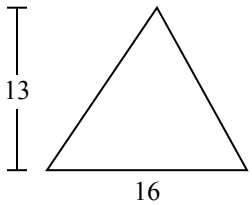

8)

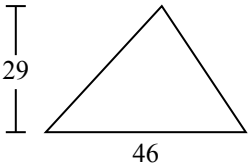

9)

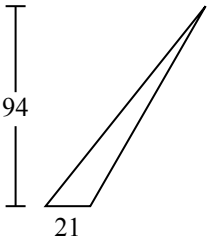

Ответы

1. _____
2. _____
3. _____
4. _____
5. _____
6. _____
7. _____
8. _____
9. _____

1-9	89	78	67	56	44	33	22	11	0

Определение площади треугольника. Имя:

Определите площадь каждого треугольника.Единицы не являются шкалами.

1)

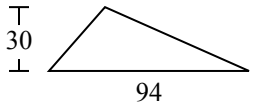

2)

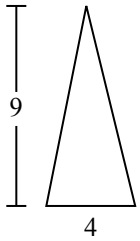

3)

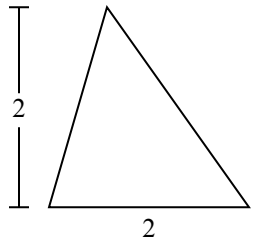

4)

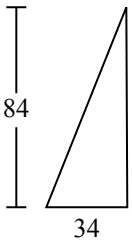

5)

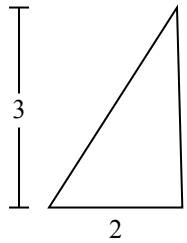

6)

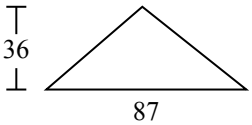

7)

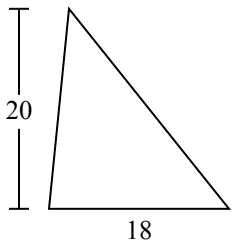

8)

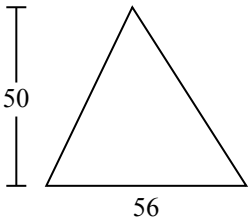

9)

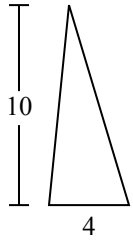

10)

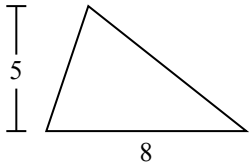

Ответы

1. _____
2. _____
3. _____
4. _____
5. _____
6. _____
7. _____
8. _____
9. _____
10. _____

1-10	90	80	70	60	50	40	30	20	10	0

Определение площади треугольника. Имя: Ключ к правильным ответам

Определите площадь каждого треугольника.Единицы не являются шкалами.

1)

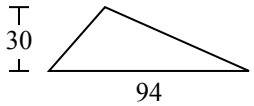

2)

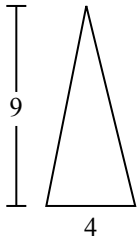

3)

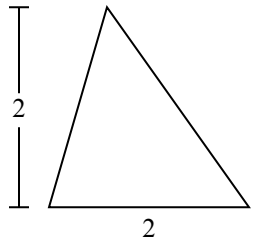

4)

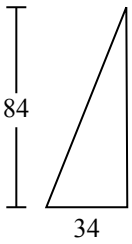

5)

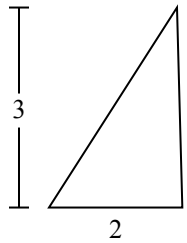

6)

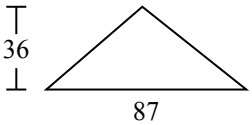

7)

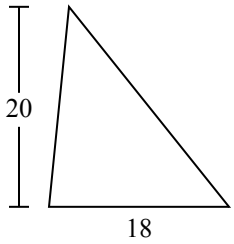

8)

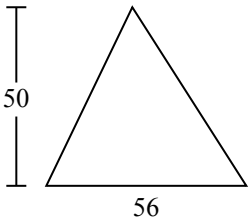

9)

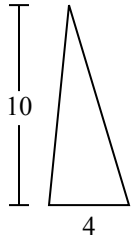

10)

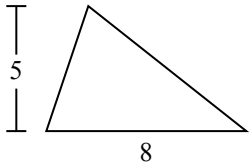

Ответы

1. 1 410
2. 18
3. 2
4. 1 428
5. 3
6. 1 566
7. 180
8. 1 400
9. 20
10. 20

1-10	90	80	70	60	50	40	30	20	10	0

Определение площади треугольника. Имя:

Определите площадь каждого треугольника.Единицы не являются шкалами.

180	1 428	18	1 566	1 400
3	2	20	1 410	

1)

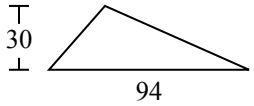

2)

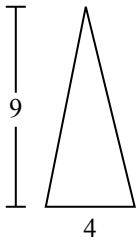

3)

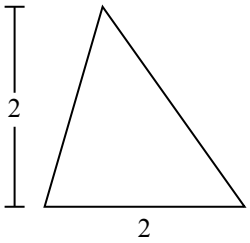

4)

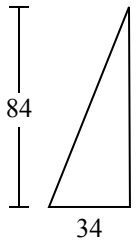

5)

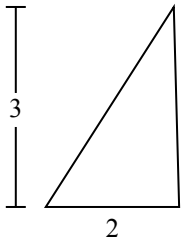

6)

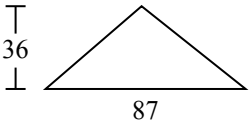

7)

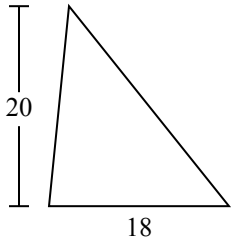

8)

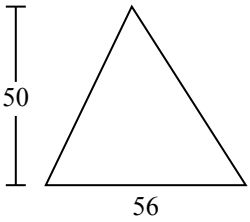

9)

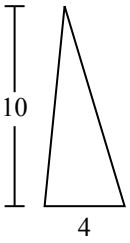

Ответы

1. _____
2. _____
3. _____
4. _____
5. _____
6. _____
7. _____
8. _____
9. _____

1-9	89	78	67	56	44	33	22	11	0

Определение площади треугольника. Имя:

Определите площадь каждого треугольника.Единицы не являются шкалами.

1)

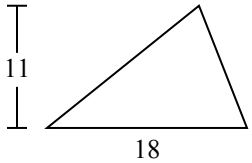

2)

3)

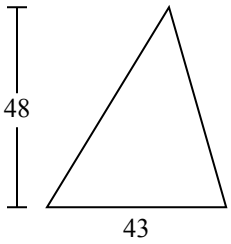

4)

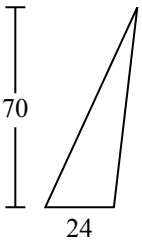

5)

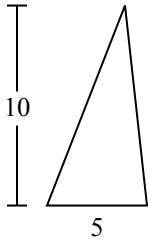

6)

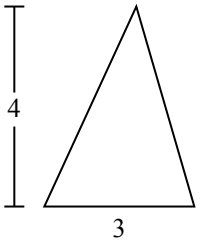

7)

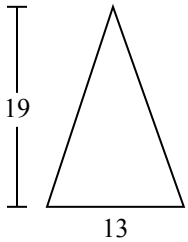

8)

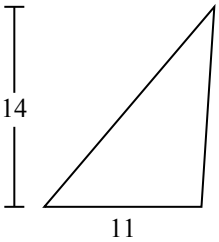

9)

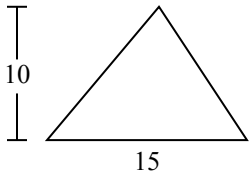

10)

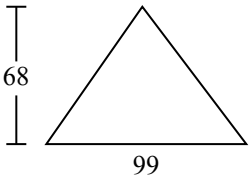

Ответы

1. _____
2. _____
3. _____
4. _____
5. _____
6. _____
7. _____
8. _____
9. _____
10. _____

1-10	90	80	70	60	50	40	30	20	10	0

Определение площади треугольника. Имя: Ключ к правильным ответам

Определите площадь каждого треугольника.Единицы не являются шкалами.

1)

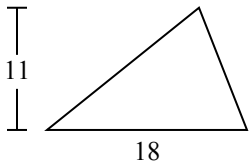

2)

3)

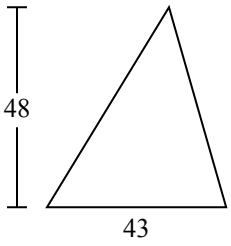

4)

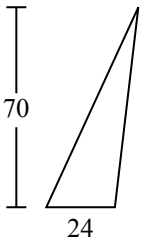

5)

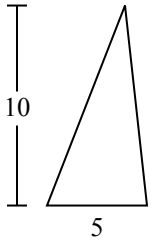

6)

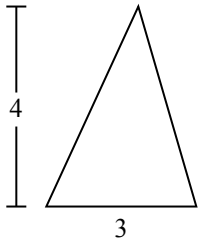

7)

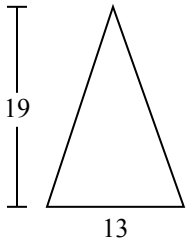

8)

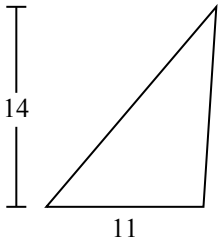

9)

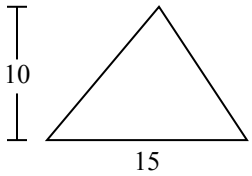

10)

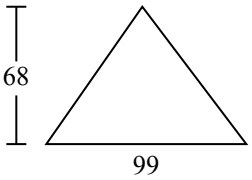

Ответы

1. **99**
2. **7**
3. **1 032**
4. **840**
5. **25**
6. **6**
7. **123,5**
8. **77**
9. **75**
10. **3 366**

1-10	90	80	70	60	50	40	30	20	10	0

Определение площади треугольника. Имя:

Определите площадь каждого треугольника.Единицы не являются шкалами.

77	6	99	1 032	25
840	75	123,5	7	

1)

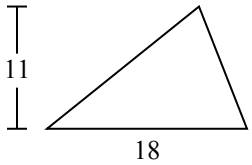

2)

3)

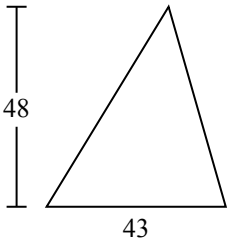

4)

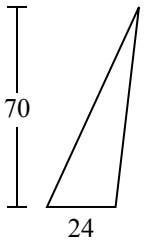

5)

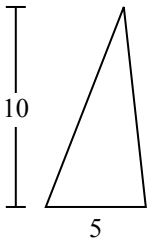

6)

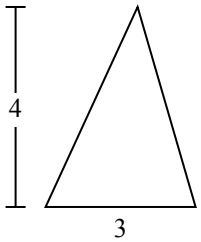

7)

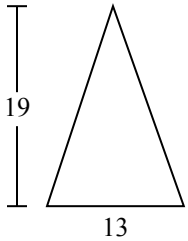

8)

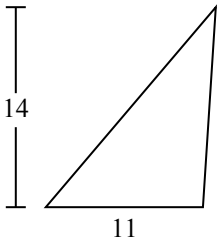

9)

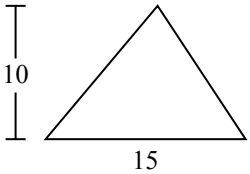

Ответы

1. _____
2. _____
3. _____
4. _____
5. _____
6. _____
7. _____
8. _____
9. _____

1-9	89	78	67	56	44	33	22	11	0