Определение площади треугольника. Имя:

Определите площадь каждого треугольника.Единицы не являются шкалами.

1)

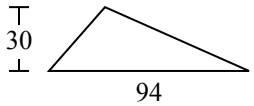

2)

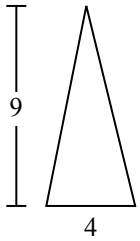

3)

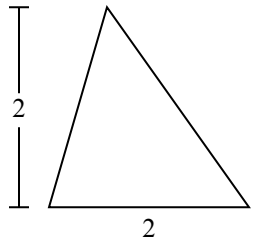

4)

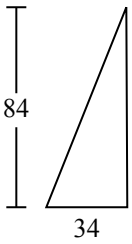

5)

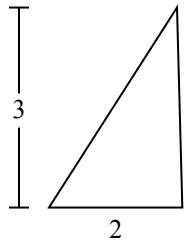

6)

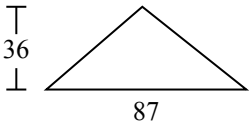

7)

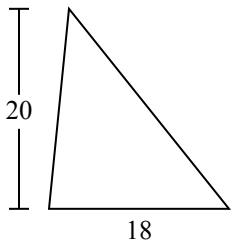

8)

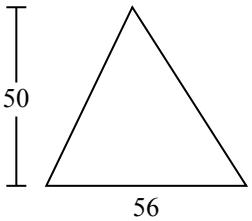

9)

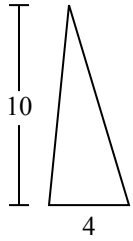

10)

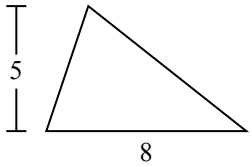

Ответы

1. _____
2. _____
3. _____
4. _____
5. _____
6. _____
7. _____
8. _____
9. _____
10. _____

1-10	90	80	70	60	50	40	30	20	10	0

Определение площади треугольника. Имя: Ключ к правильным ответам

Определите площадь каждого треугольника.Единицы не являются шкалами.

1)

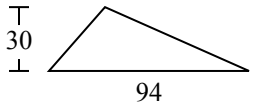

2)

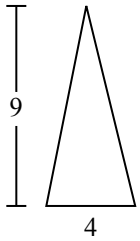

3)

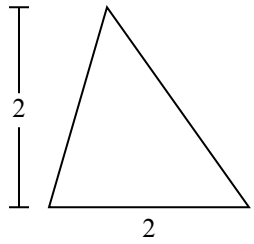

4)

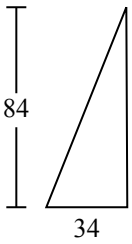

5)

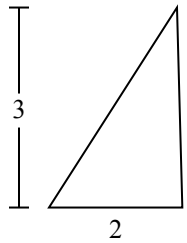

6)

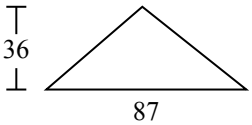

7)

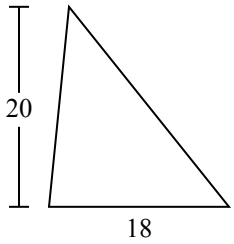

8)

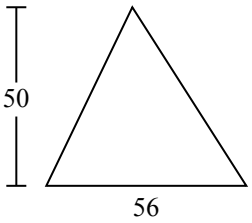

9)

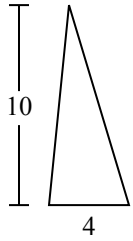

10)

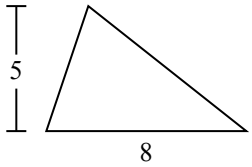

Ответы

1. 1 410
2. 18
3. 2
4. 1 428
5. 3
6. 1 566
7. 180
8. 1 400
9. 20
10. 20

1-10	90	80	70	60	50	40	30	20	10	0

Определение площади треугольника. Имя:

Определите площадь каждого треугольника.Единицы не являются шкалами.

180	1 428	18	1 566	1 400
3	2	20	1 410	

1)

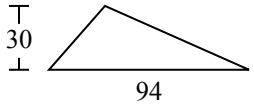

2)

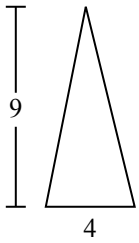

3)

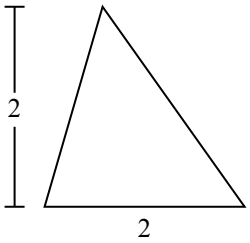

4)

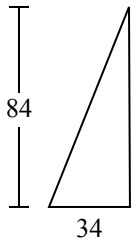

5)

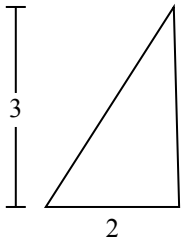

6)

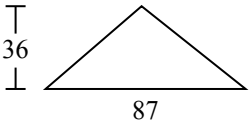

7)

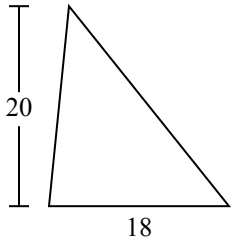

8)

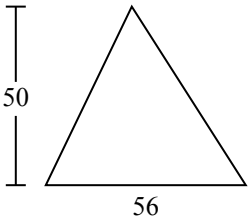

9)

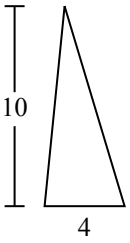

Ответы

1. _____
2. _____
3. _____
4. _____
5. _____
6. _____
7. _____
8. _____
9. _____

1-9	89	78	67	56	44	33	22	11	0