Определение площади треугольника. Имя:

Определите площадь каждого треугольника.Единицы не являются шкалами.

1)

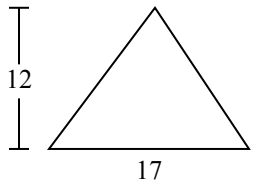

2)

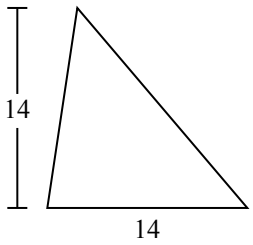

3)

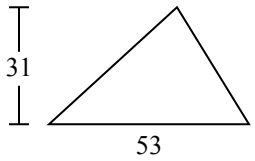

4)

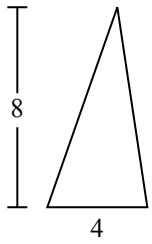

5)

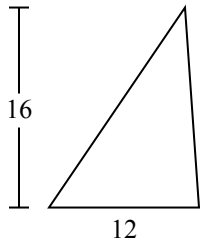

6)

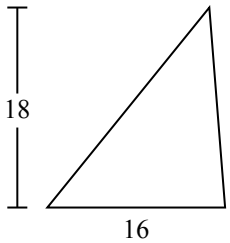

7)

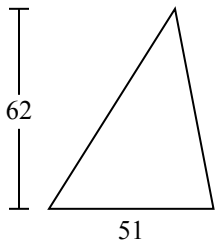

8)

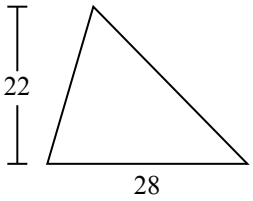

9)

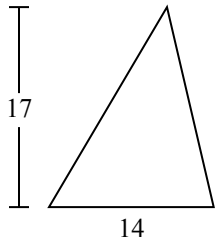

10)

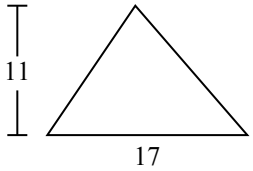

Ответы

1. _____
2. _____
3. _____
4. _____
5. _____
6. _____
7. _____
8. _____
9. _____
10. _____

1-10	90	80	70	60	50	40	30	20	10	0

Определение площади треугольника. Имя: Ключ к правильным ответам

Определите площадь каждого треугольника.Единицы не являются шкалами.

1)

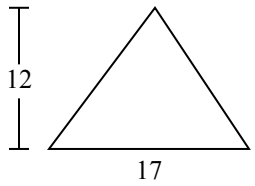

2)

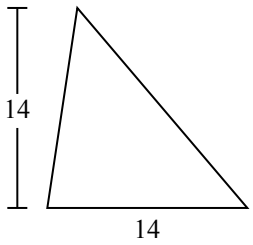

3)

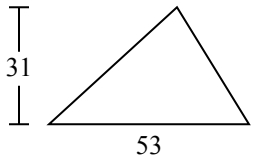

4)

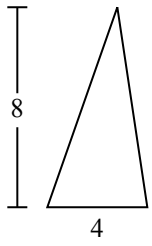

5)

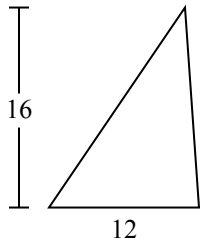

6)

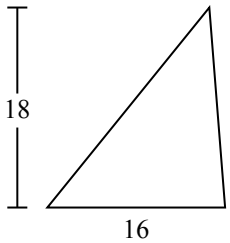

7)

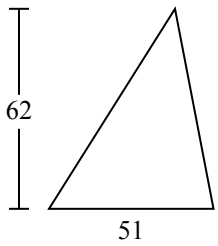

8)

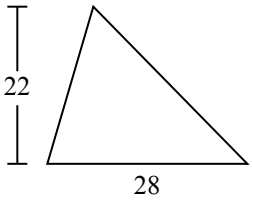

9)

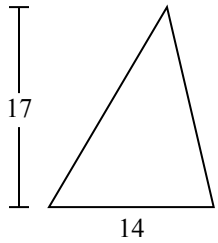

10)

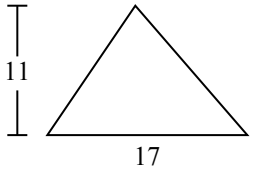

Ответы

1. 102
2. 98
3. 821,5
4. 16
5. 96
6. 144
7. 1 581
8. 308
9. 119
10. 93,5

1-10	90	80	70	60	50	40	30	20	10	0

Определение площади треугольника. Имя:

Определите площадь каждого треугольника.Единицы не являются шкалами.

102	1 581	308	144	16
119	821,5	98	96	

1)

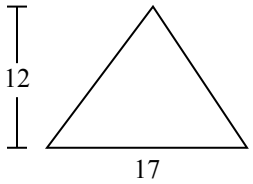

2)

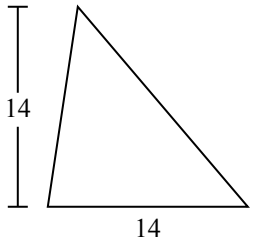

3)

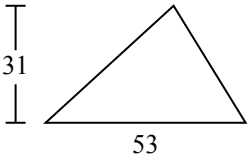

4)

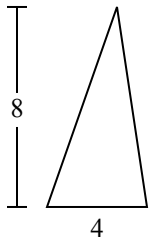

5)

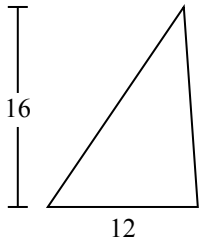

6)

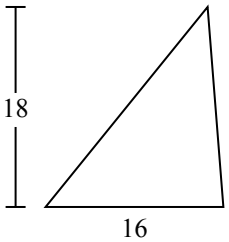

7)

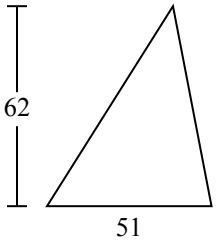

8)

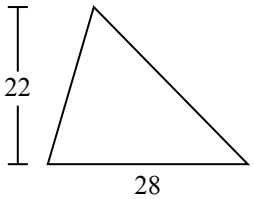

9)

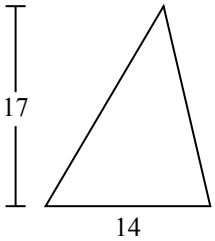

Ответы

1. _____
2. _____
3. _____
4. _____
5. _____
6. _____
7. _____
8. _____
9. _____

1-9	89	78	67	56	44	33	22	11	0