Определение площади треугольника. Имя:

Определите площадь каждого треугольника.Единицы не являются шкалами.

1)

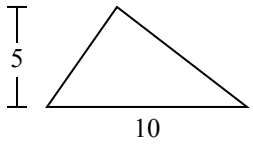

2)

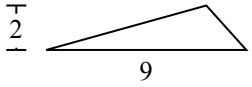

3)

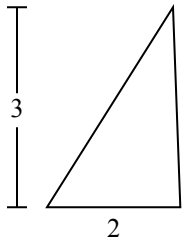

4)

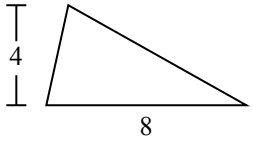

5)

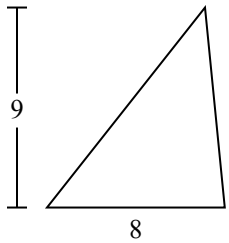

6)

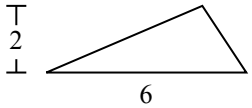

7)

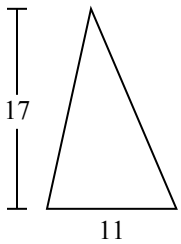

8)

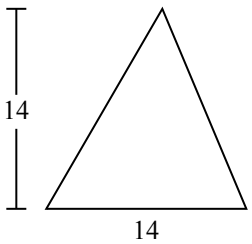

9)

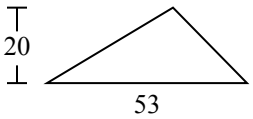

10)

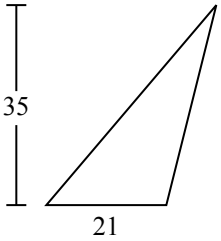

Ответы

1. _____
2. _____
3. _____
4. _____
5. _____
6. _____
7. _____
8. _____
9. _____
10. _____

1-10	90	80	70	60	50	40	30	20	10	0

Определение площади треугольника. Имя: Ключ к правильным ответам

Определите площадь каждого треугольника.Единицы не являются шкалами.

1)

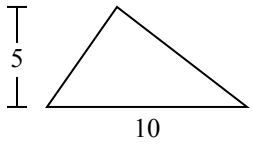

2)

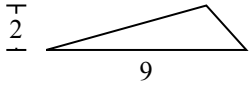

3)

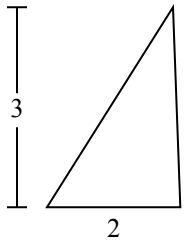

4)

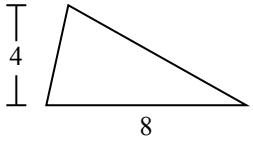

5)

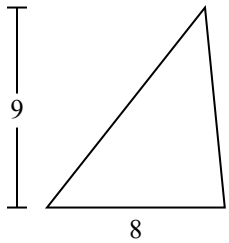

6)

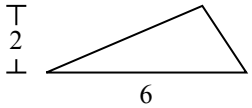

7)

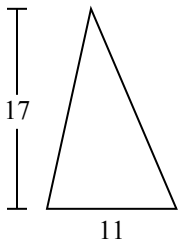

8)

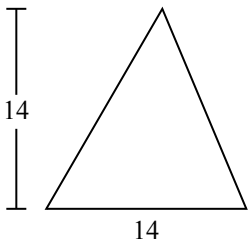

9)

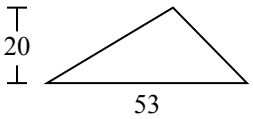

10)

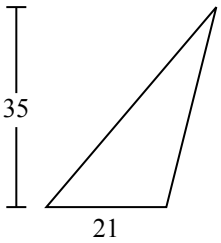

Ответы

1. 25
2. 9
3. 3
4. 16
5. 36
6. 6
7. 93,5
8. 98
9. 530
10. 367,5

1-10	90	80	70	60	50	40	30	20	10	0

Определение площади треугольника. Имя:

Определите площадь каждого треугольника.Единицы не являются шкалами.

93,5	98	530	25	9
6	36	16	3	

1)

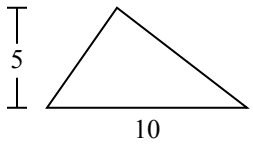

2)

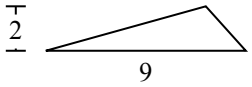

3)

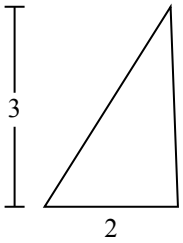

4)

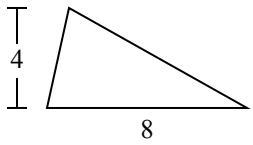

5)

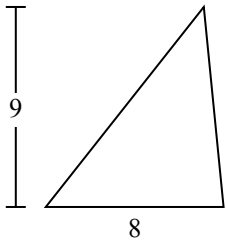

6)

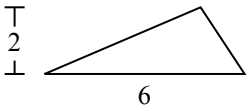

7)

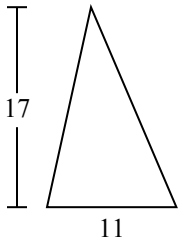

8)

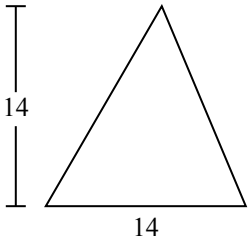

9)

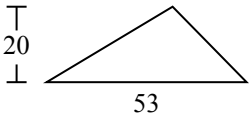

Ответы

1. _____
2. _____
3. _____
4. _____
5. _____
6. _____
7. _____
8. _____
9. _____

1-9	89	78	67	56	44	33	22	11	0