Определение площади круга Имя:

Определите площадь каждого круга. Круги не являются шкалами.

1)

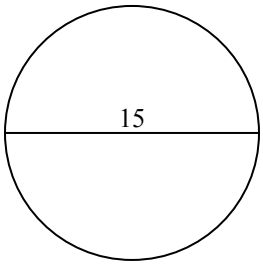

2)

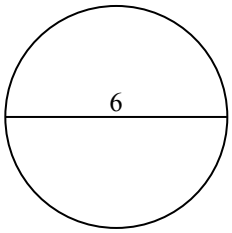

3)

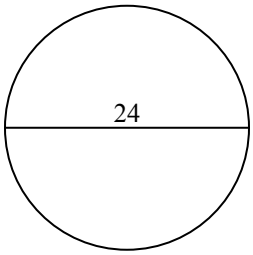

4)

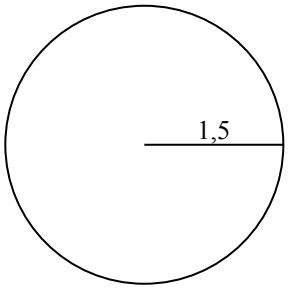

5)

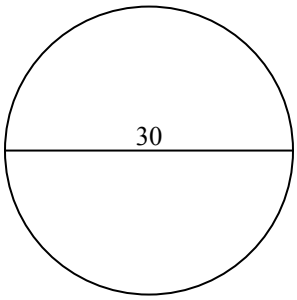

6)

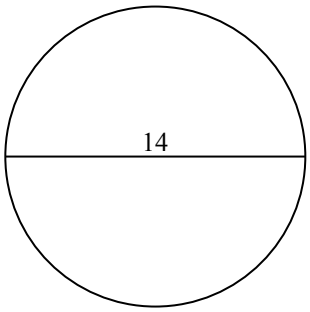

7)

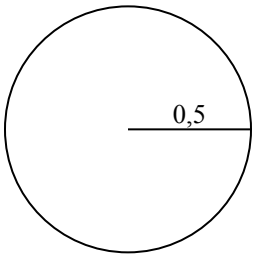

8)

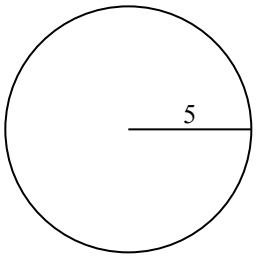

9)

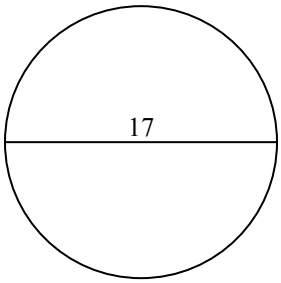

10)

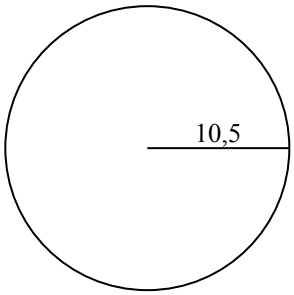

Ответы

1. _____
2. _____
3. _____
4. _____
5. _____
6. _____
7. _____
8. _____
9. _____
10. _____

1-10	90	80	70	60	50	40	30	20	10	0

Определение площади круга Имя: Ключ к правильным ответам

Определите площадь каждого круга. Круги не являются шкалами.

1)

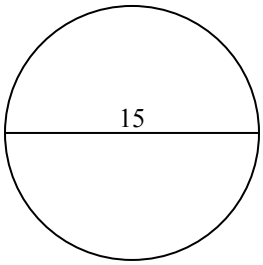

2)

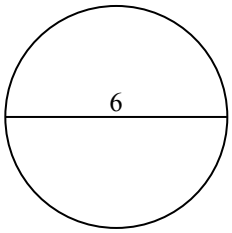

3)

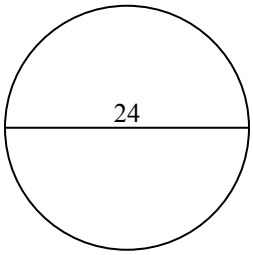

4)

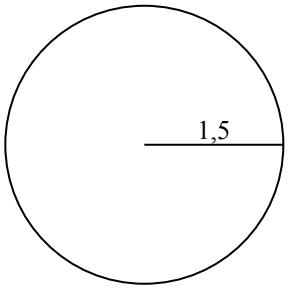

5)

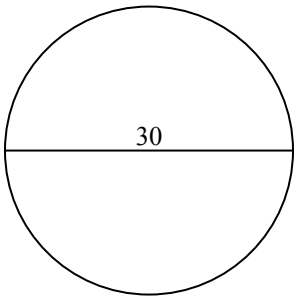

6)

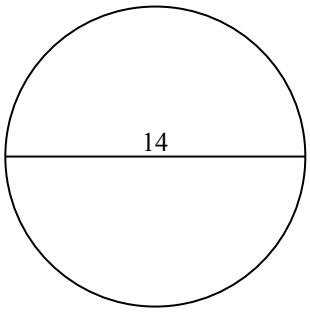

7)

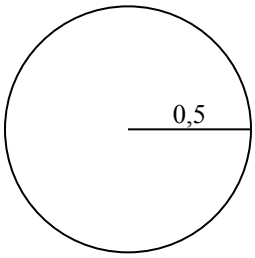

8)

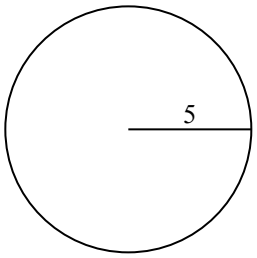

9)

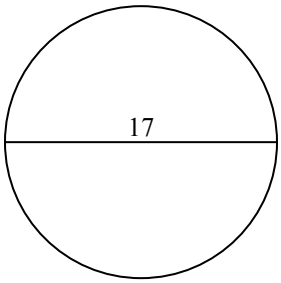

10)

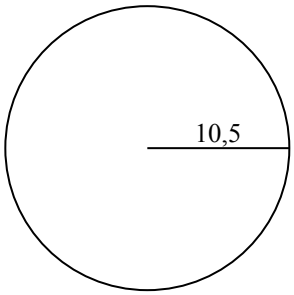

Ответы

1. 176,7
2. 28,3
3. 452,4
4. 7,1
5. 706,9
6. 153,9
7. 0,8
8. 78,5
9. 227
10. 346,4

1-10	90	80	70	60	50	40	30	20	10	0

Определение площади круга Имя:

Определите площадь каждого круга. Круги не являются шкалами.

452,4	0,8	153,9	7,1	227
28,3	78,5	706,9	176,7	

1)

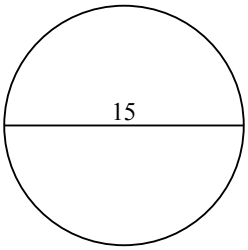

2)

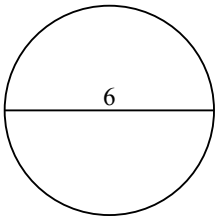

3)

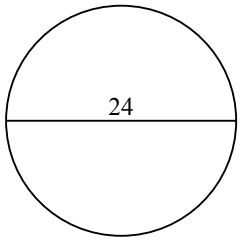

4)

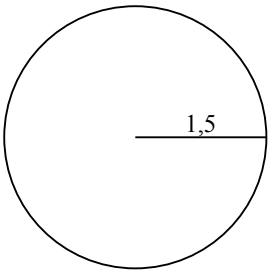

5)

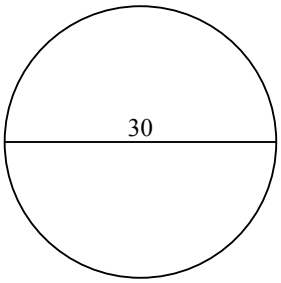

6)

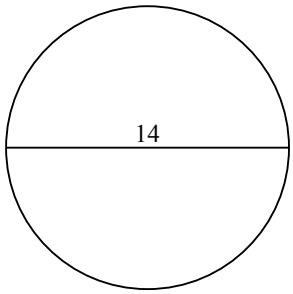

7)

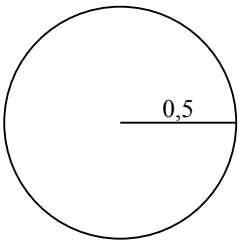

8)

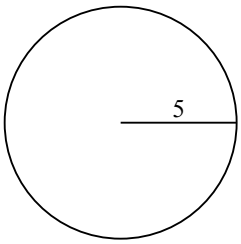

9)

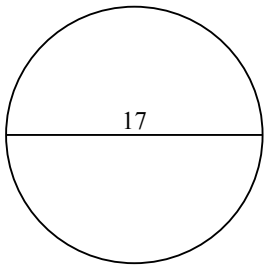

Ответы

1. _____
2. _____
3. _____
4. _____
5. _____
6. _____
7. _____
8. _____
9. _____

1-9	89	78	67	56	44	33	22	11	0