Нахождение объема при помощи малых кубов Имя:

Определите все при измерения параллелепипеда. Затем найдите объем.

об)

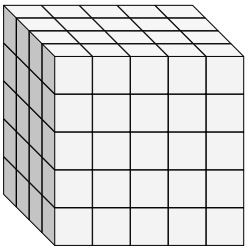

1)

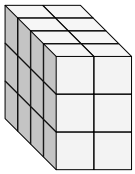

2)

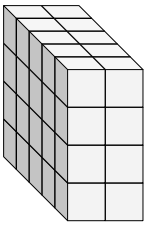

3)

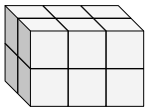

4)

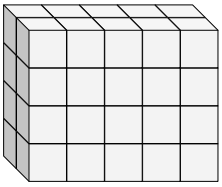

5)

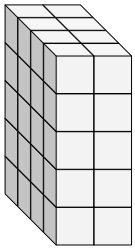

6)

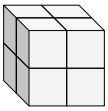

7)

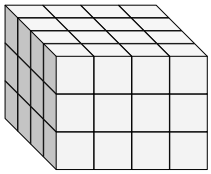

8)

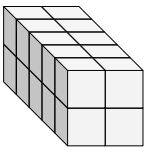

9)

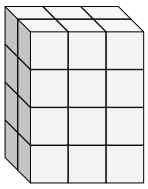

Ответы

об.	4	5	5	100
1.				
2.				
3.				
4.				
5.				
6.				
7.				
8.				
9.				

1-9	89	78	67	56	44	33	22	11	0

Нахождение объема при помощи малых кубов Имя: Ключ к правильным ответам

Определите все при измерения параллелепипеда. Затем найдите объем.

об)

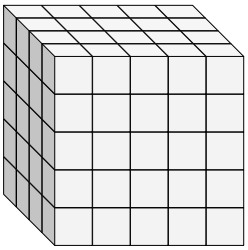

1)

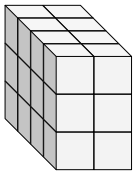

2)

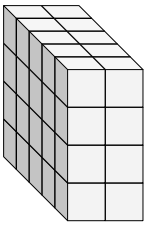

3)

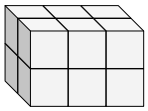

4)

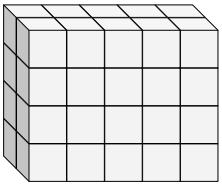

5)

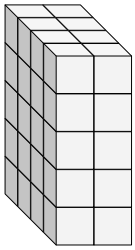

6)

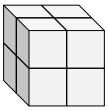

7)

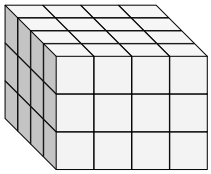

8)

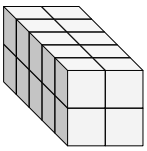

9)

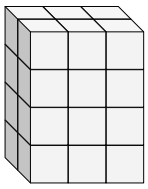

Ответы

об.	4	5	5	100
1.	4	2	3	24
2.	5	2	4	40
3.	2	3	2	12
4.	2	5	4	40
5.	4	2	5	40
6.	2	2	2	8
7.	4	4	3	48
8.	5	2	2	20
9.	2	3	4	24

1-9	89	78	67	56	44	33	22	11	0