Объем параллелепипеда Имя:

Найдите объем каждого прямоугольного параллелепипеда.

1)

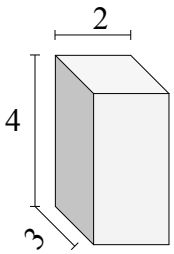

2)

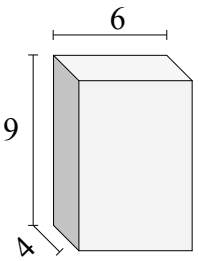

3)

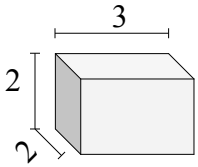

4)

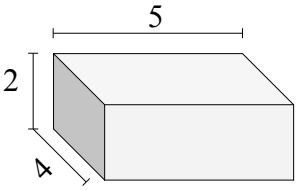

5)

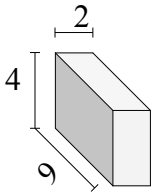

6)

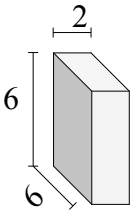

7)

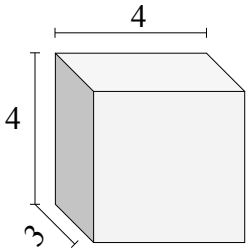

8)

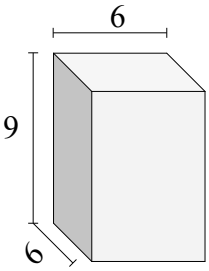

9)

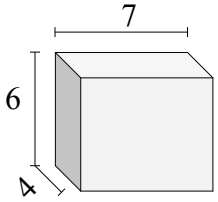

10)

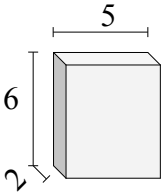

Ответы

1. _____
2. _____
3. _____
4. _____
5. _____
6. _____
7. _____
8. _____
9. _____
10. _____

1-10	90	80	70	60	50	40	30	20	10	0

Объем параллелепипеда

Имя: Ключ к правильным ответам

Найдите объем каждого прямоугольного параллелепипеда.

1)

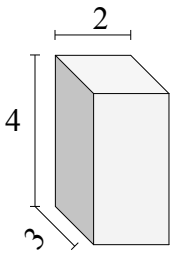

2)

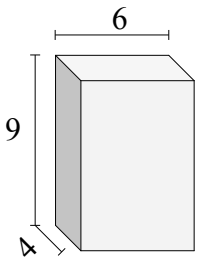

3)

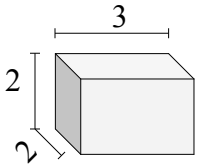

4)

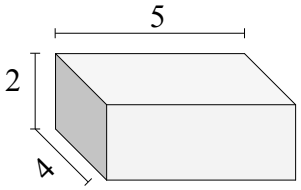

5)

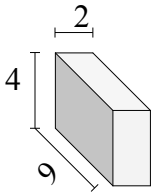

6)

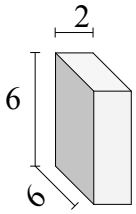

7)

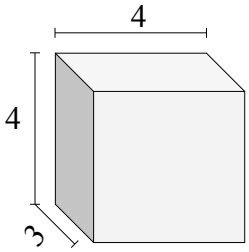

8)

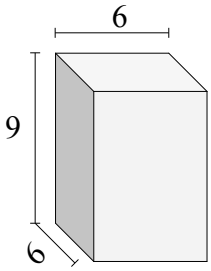

9)

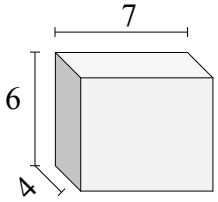

10)

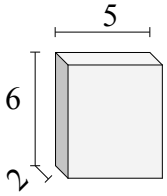

Ответы

1. 24
2. 216
3. 12
4. 40
5. 72
6. 72
7. 48
8. 324
9. 168
10. 60

1-10	90	80	70	60	50	40	30	20	10	0