Определение объема по малым частицам Имя:

Заполните каждый куб малыми кубами и подсчитайте объем. Измерения проводить в сантиметрах.

об)

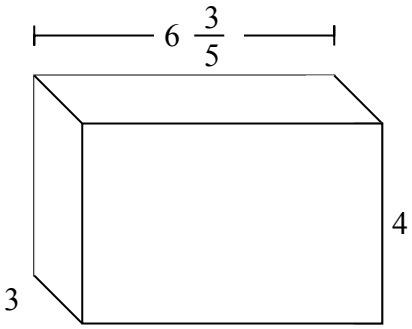

1)

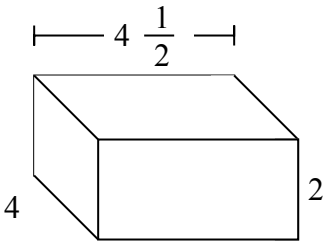

2)

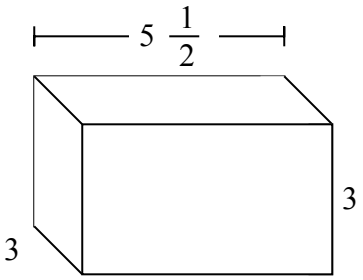

3)

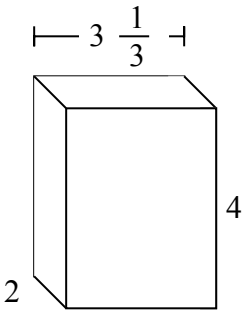

4)

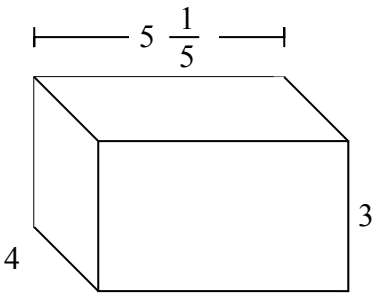

5)

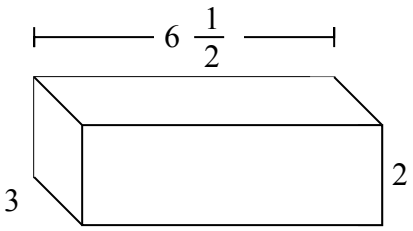

6)

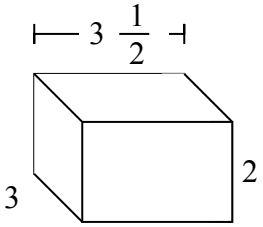

7)

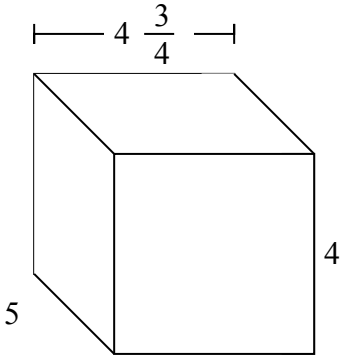

Ответы

об. $79\ ^{1}/_{5}$ cm

1. _____

2. _____

3. _____

4. _____

5. _____

6. _____

7. _____

1-7	86	71	57	43	29	14	0

Определение объема по малым частицам Имя: Ключ к правильным ответам

Заполните каждый куб малыми кубами и подсчитайте объем. Измерения проводить в сантиметрах.

об)

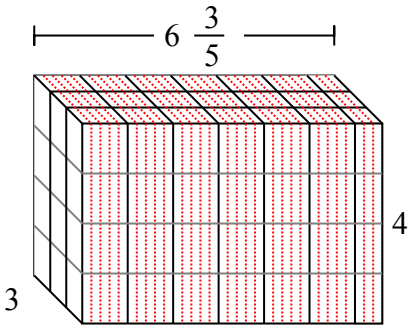

1)

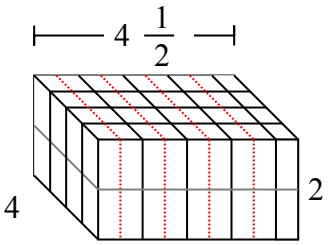

2)

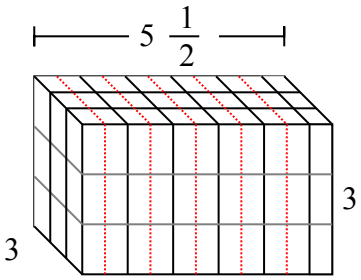

3)

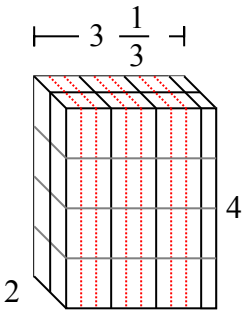

4)

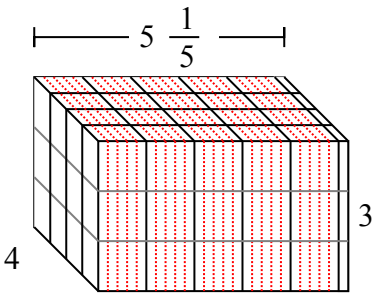

5)

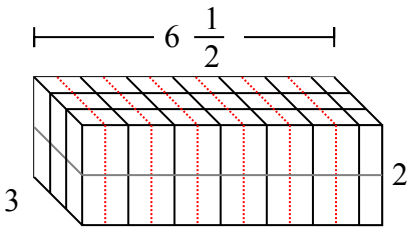

6)

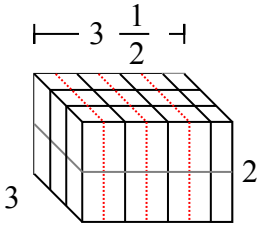

7)

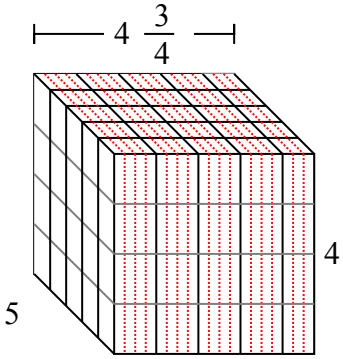

Ответы

об.	79 $^{1}/_{5}$ cm
1.	36 cm
2.	49 $^{1}/_{2}$ cm
3.	26 $^{2}/_{3}$ cm
4.	62 $^{2}/_{5}$ cm
5.	39 cm
6.	21 cm
7.	95 cm

1-7	86	71	57	43	29	14	0