Определение малых единиц Имя:

Определите количество малых единиц в задачах.

об) $5\frac{1}{3}$



1) $5\frac{3}{4}$

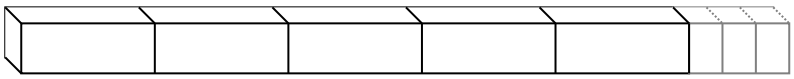

2) $6\frac{1}{2}$

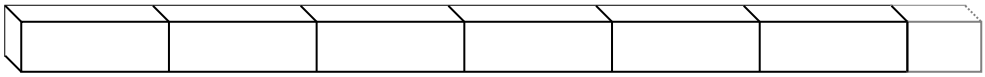

3) $3\frac{1}{2}$



4) $4\frac{2}{5}$

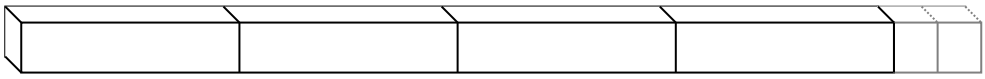

5) $2\frac{3}{5}$



6) $7\frac{2}{3}$

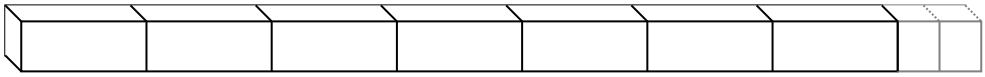

7) $4\frac{2}{3}$



8) $4\frac{2}{3}$

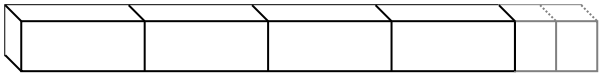

9) $3\frac{1}{2}$



10) $6\frac{1}{2}$

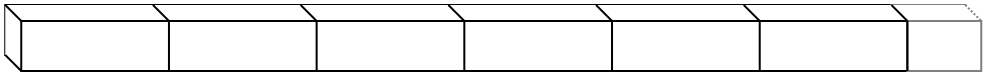

Ответы

об. 16

1. _____

2. _____

3. _____

4. _____

5. _____

6. _____

7. _____

8. _____

9. _____

10. _____

Определение малых единиц

Имя: Ключ к правильным ответам

Определите количество малых единиц в задачах.

об) $5\frac{1}{3}$

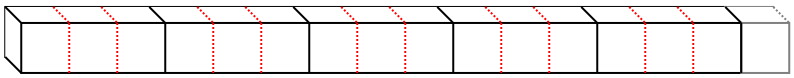

1) $5\frac{3}{4}$

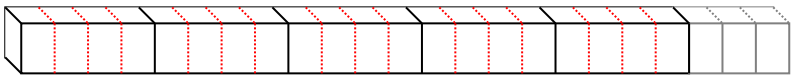

2) $6\frac{1}{2}$

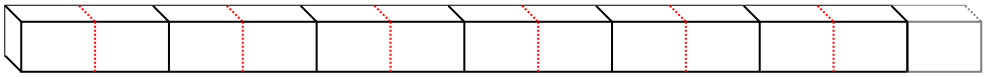

3) $3\frac{1}{2}$



4) $4\frac{2}{5}$

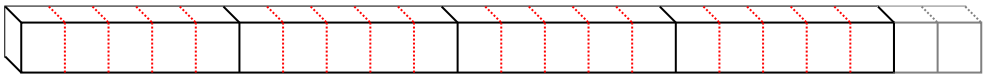

5) $2\frac{3}{5}$

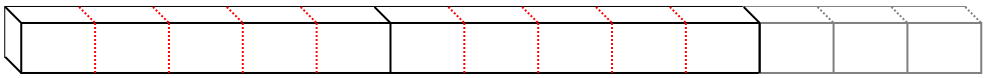

6) $7\frac{2}{3}$

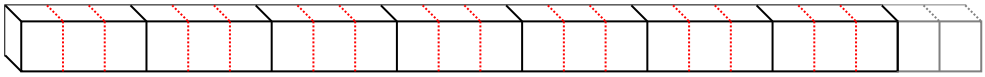

7) $4\frac{2}{3}$

8) $4\frac{2}{3}$

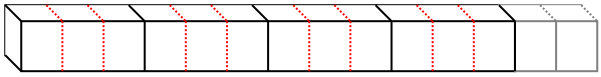

9) $3\frac{1}{2}$



10) $6\frac{1}{2}$

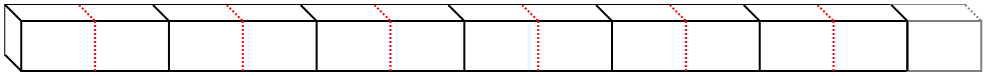

Ответы

об.	16
1.	23
2.	13
3.	7
4.	22
5.	13
6.	23
7.	14
8.	14
9.	7
10.	13

1-10	90	80	70	60	50	40	30	20	10	0