Определение малых единиц Имя:

Определите количество малых единиц в задачах.

об) $6\frac{2}{3}$

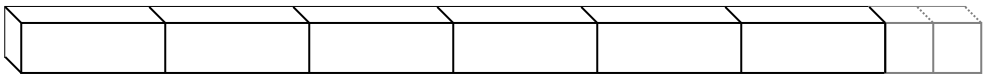

1) $8\frac{1}{5}$

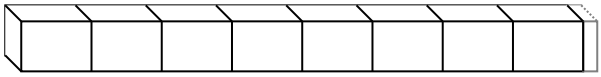

2) $5\frac{2}{3}$

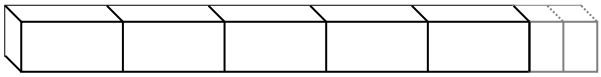

3) $8\frac{2}{3}$

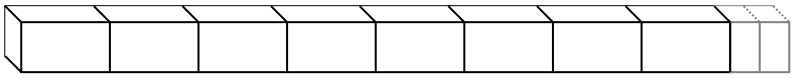

4) $5\frac{1}{2}$

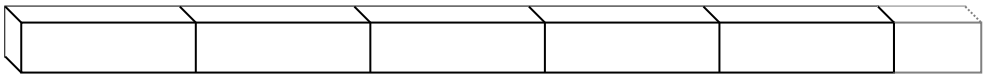

5) $8\frac{2}{3}$

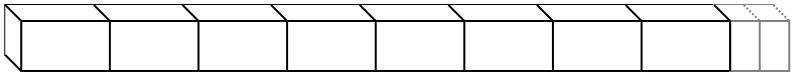

6) $5\frac{2}{4}$

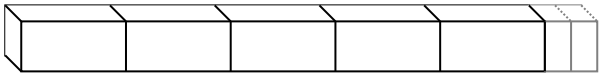

7) $6\frac{2}{4}$

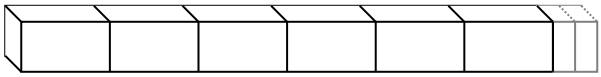

8) $3\frac{1}{4}$



9) $4\frac{3}{5}$

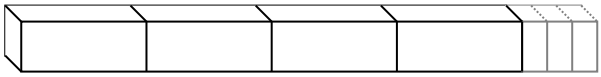

10) $1\frac{3}{5}$



Ответы

об. 20

1. _____

2. _____

3. _____

4. _____

5. _____

6. _____

7. _____

8. _____

9. _____

10. _____

1-10	90	80	70	60	50	40	30	20	10	0

Определение малых единиц

Имя: Ключ к правильным ответам

Определите количество малых единиц в задачах.

об) $6\frac{2}{3}$

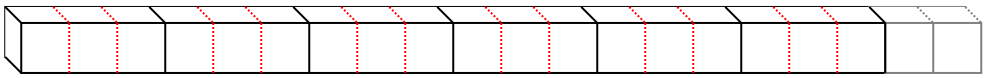

1) $8\frac{1}{5}$

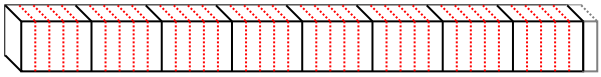

2) $5\frac{2}{3}$

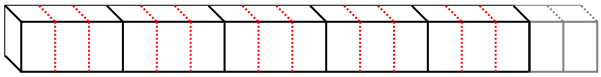

3) $8\frac{2}{3}$

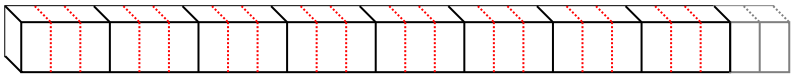

4) $5\frac{1}{2}$

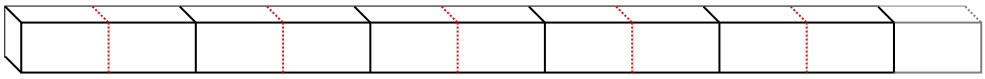

5) $8\frac{2}{3}$

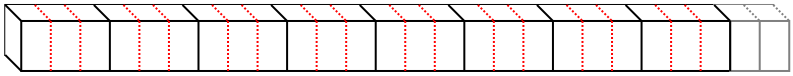

6) $5\frac{2}{4}$

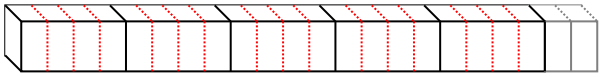

7) $6\frac{2}{4}$

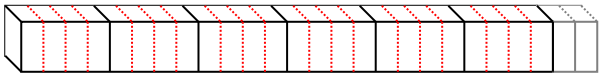

8) $3\frac{1}{4}$

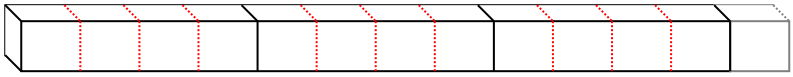

9) $4\frac{3}{5}$

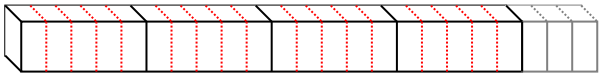

10) $1\frac{3}{5}$

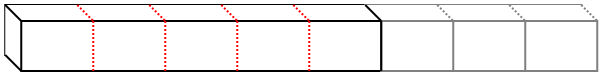

Ответы

об.	20
1.	41
2.	17
3.	26
4.	11
5.	26
6.	22
7.	26
8.	13
9.	23
10.	8

1-10	90	80	70	60	50	40	30	20	10	0

Определите количество малых единиц в задачах.

об) $4\frac{1}{2}$



1) $9\frac{1}{3}$

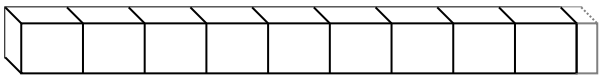

2) $3\frac{1}{2}$



3) $1\frac{1}{2}$



4) $2\frac{1}{3}$

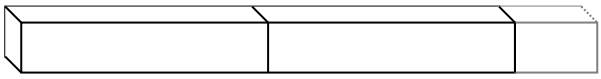

5) $6\frac{1}{2}$

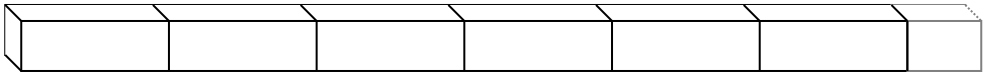

6) $3\frac{2}{4}$



7) $1\frac{3}{5}$



8) $7\frac{3}{5}$

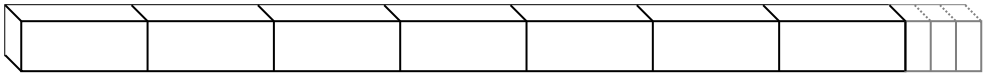

9) $6\frac{1}{4}$

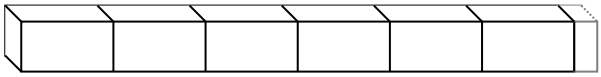

10) $3\frac{3}{4}$

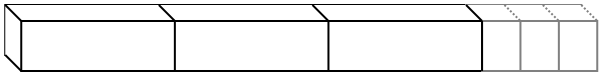

Ответы

об. 9

1. _____
2. _____
3. _____
4. _____
5. _____
6. _____
7. _____
8. _____
9. _____
10. _____

1-10	90	80	70	60	50	40	30	20	10	0

Определите количество малых единиц в задачах.

об) $4\frac{1}{2}$



1) $9\frac{1}{3}$

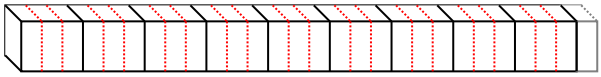

2) $3\frac{1}{2}$



3) $1\frac{1}{2}$



4) $2\frac{1}{3}$

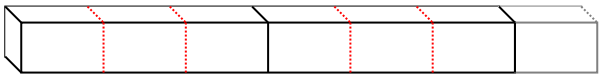

5) $6\frac{1}{2}$

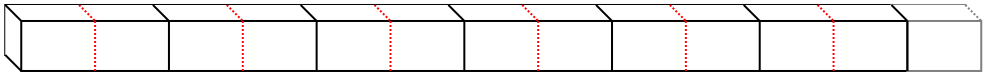

6) $3\frac{2}{4}$

7) $1\frac{3}{5}$

8) $7\frac{3}{5}$

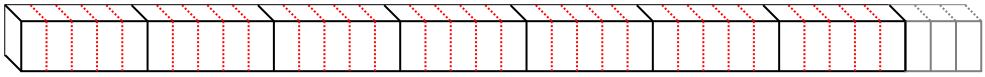

9) $6\frac{1}{4}$

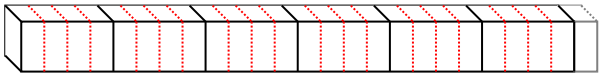

10) $3\frac{3}{4}$

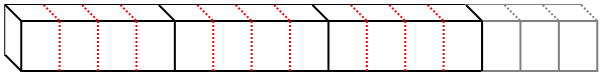

Ответы

об.	9
1.	28
2.	7
3.	3
4.	7
5.	13
6.	14
7.	8
8.	38
9.	25
10.	15

1-10	90	80	70	60	50	40	30	20	10	0

Определение малых единиц Имя:

Определите количество малых единиц в задачах.

об) $1\frac{3}{5}$



1) $5\frac{1}{2}$



2) $2\frac{1}{2}$



3) $9\frac{1}{3}$

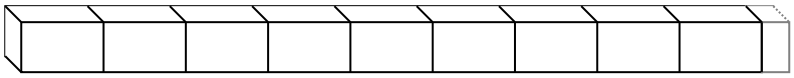

4) $2\frac{1}{5}$

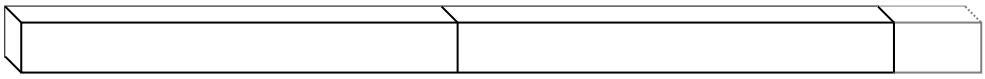

5) $6\frac{1}{2}$

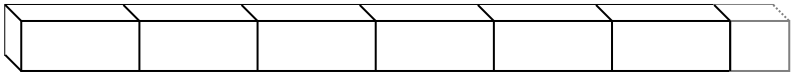

6) $8\frac{1}{2}$

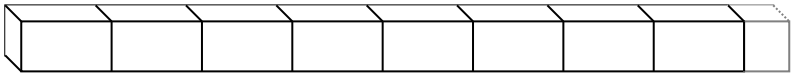

7) $8\frac{3}{4}$

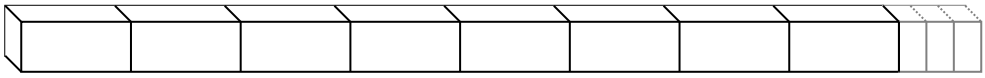

8) $3\frac{1}{2}$



9) $5\frac{1}{3}$



10) $5\frac{1}{5}$



Ответы

об. 8

1. _____

2. _____

3. _____

4. _____

5. _____

6. _____

7. _____

8. _____

9. _____

10. _____

1-10	90	80	70	60	50	40	30	20	10	0

Определение малых единиц

Имя: **Ключ к правильным ответам**

Определите количество малых единиц в задачах.

об) $1\frac{3}{5}$

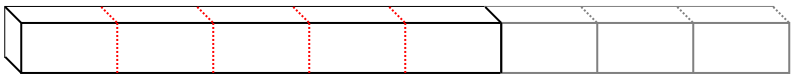

1) $5\frac{1}{2}$

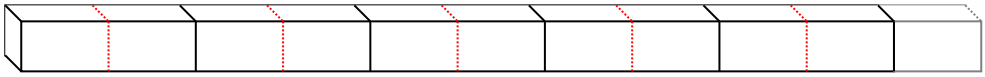

2) $2\frac{1}{2}$



3) $9\frac{1}{3}$

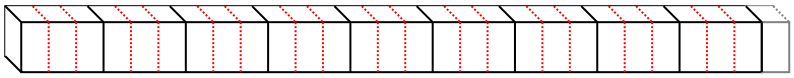

4) $2\frac{1}{5}$

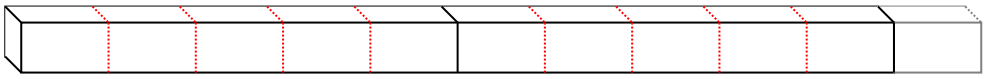

5) $6\frac{1}{2}$

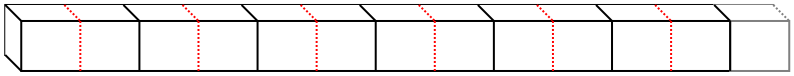

6) $8\frac{1}{2}$

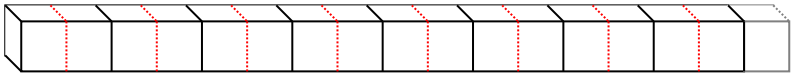

7) $8\frac{3}{4}$

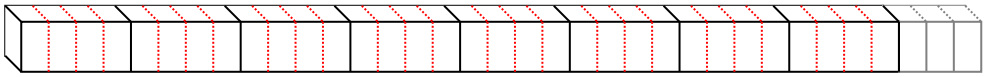

8) $3\frac{1}{2}$



9) $5\frac{1}{3}$

10) $5\frac{1}{5}$

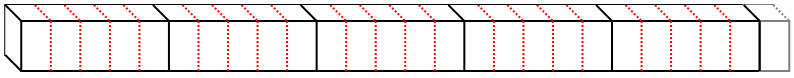

Ответы

об.	8
1.	11
2.	5
3.	28
4.	11
5.	13
6.	17
7.	35
8.	7
9.	16
10.	26

1-10	90	80	70	60	50	40	30	20	10	0

Определите количество малых единиц в задачах.

об) $7\frac{1}{3}$

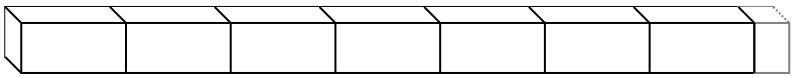

1) $8\frac{2}{3}$

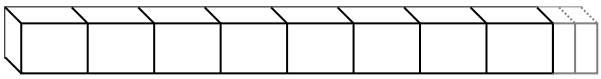

2) $3\frac{1}{3}$



3) $4\frac{1}{2}$

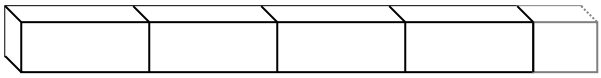

4) $9\frac{3}{4}$

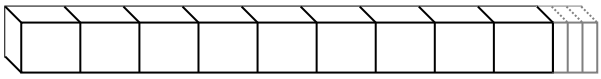

5) $4\frac{1}{2}$



6) $8\frac{2}{4}$

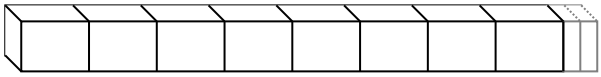

7) $7\frac{2}{3}$

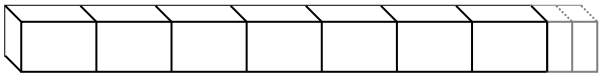

8) $4\frac{3}{4}$



9) $1\frac{1}{3}$



10) $8\frac{1}{3}$

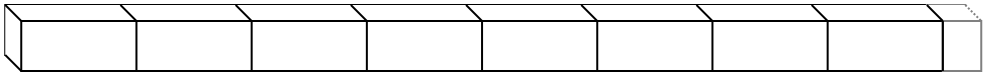

Ответы

об. 22

1. _____
2. _____
3. _____
4. _____
5. _____
6. _____
7. _____
8. _____
9. _____
10. _____

1-10	90	80	70	60	50	40	30	20	10	0

Определите количество малых единиц в задачах.

об) $7\frac{1}{3}$

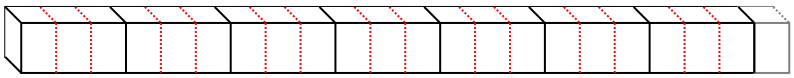

1) $8\frac{2}{3}$

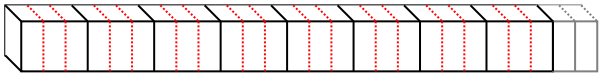

2) $3\frac{1}{3}$

3) $4\frac{1}{2}$

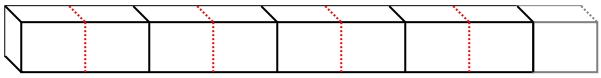

4) $9\frac{3}{4}$

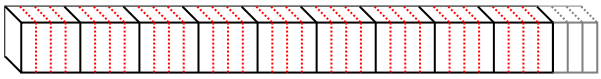

5) $4\frac{1}{2}$



6) $8\frac{2}{4}$

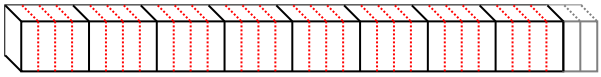

7) $7\frac{2}{3}$

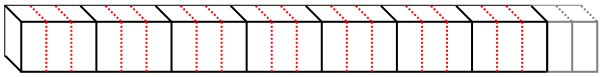

8) $4\frac{3}{4}$

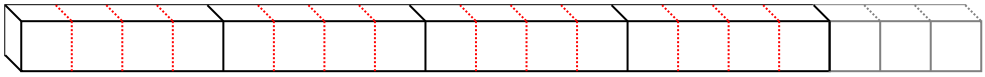

9) $1\frac{1}{3}$

10) $8\frac{1}{3}$

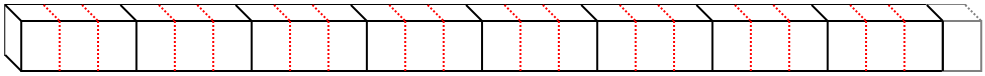

Ответы

об.	22
1.	26
2.	10
3.	9
4.	39
5.	9
6.	34
7.	23
8.	19
9.	4
10.	25

1-10	90	80	70	60	50	40	30	20	10	0

Определите количество малых единиц в задачах.

об) $9\frac{1}{2}$

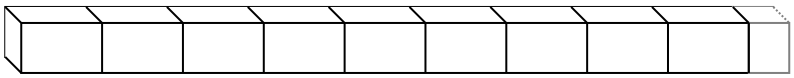

1) $9\frac{1}{2}$

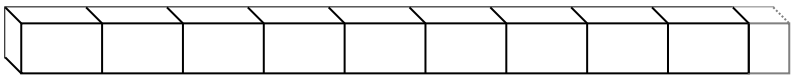

2) $3\frac{2}{3}$

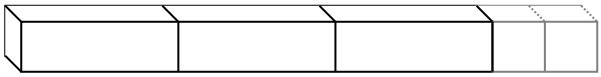

3) $9\frac{2}{3}$

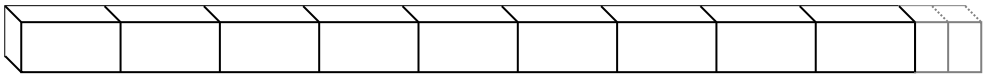

4) $7\frac{2}{4}$

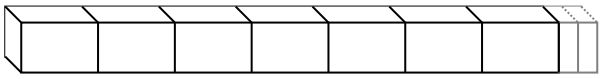

5) $2\frac{1}{2}$



6) $5\frac{2}{4}$

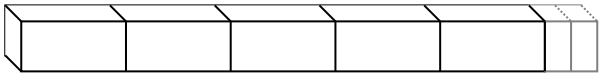

7) $4\frac{2}{4}$

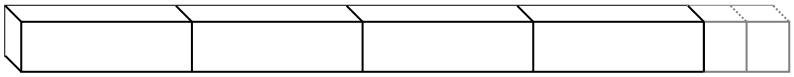

8) $4\frac{2}{3}$



9) $4\frac{1}{5}$

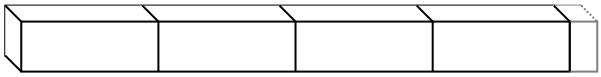

10) $8\frac{2}{3}$

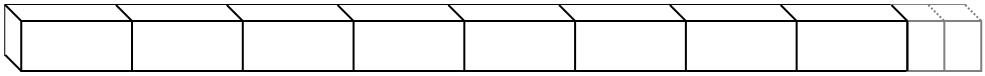

Ответы

об. 19

1. _____

2. _____

3. _____

4. _____

5. _____

6. _____

7. _____

8. _____

9. _____

10. _____

1-10	90	80	70	60	50	40	30	20	10	0

Определите количество малых единиц в задачах.

об) $9\frac{1}{2}$

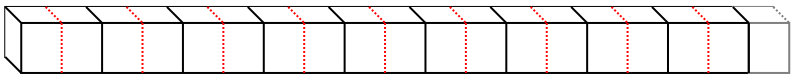

1) $9\frac{1}{2}$

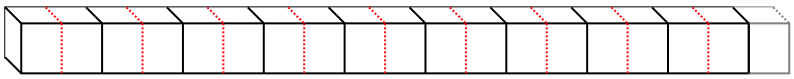

2) $3\frac{2}{3}$

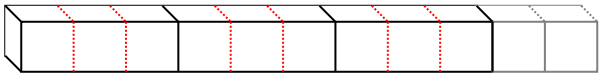

3) $9\frac{2}{3}$

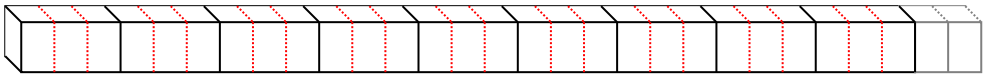

4) $7\frac{2}{4}$

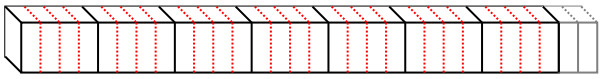

5) $2\frac{1}{2}$



6) $5\frac{2}{4}$

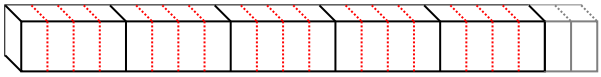

7) $4\frac{2}{4}$

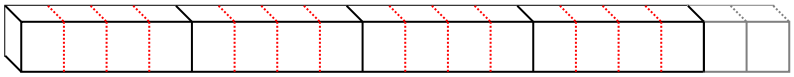

8) $4\frac{2}{3}$

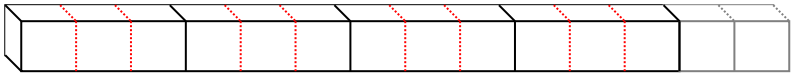

9) $4\frac{1}{5}$

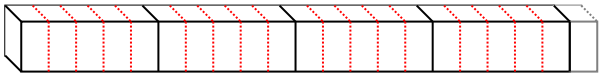

10) $8\frac{2}{3}$

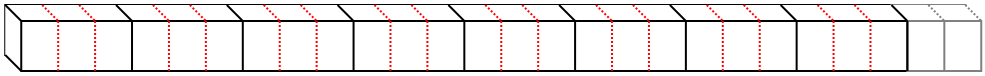

Ответы

об.	19
1.	19
2.	11
3.	29
4.	30
5.	5
6.	22
7.	18
8.	14
9.	21
10.	26

1-10	90	80	70	60	50	40	30	20	10	0

Определите количество малых единиц в задачах.

об) $8\frac{1}{4}$

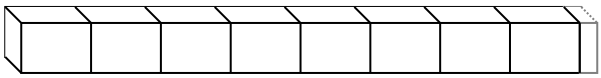

1) $6\frac{1}{4}$

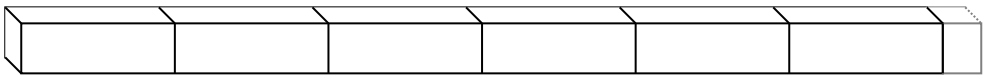

2) $6\frac{1}{2}$

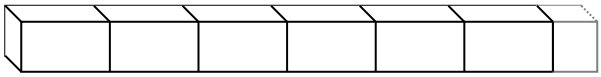

3) $7\frac{1}{4}$

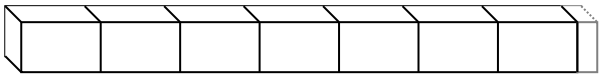

4) $3\frac{3}{5}$

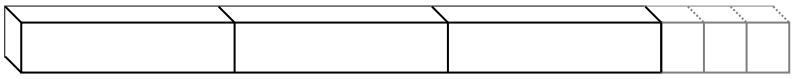

5) $3\frac{1}{3}$



6) $2\frac{2}{5}$

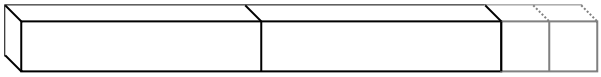

7) $9\frac{1}{3}$

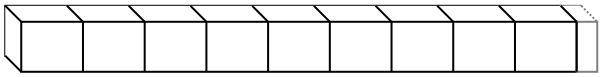

8) $3\frac{3}{5}$

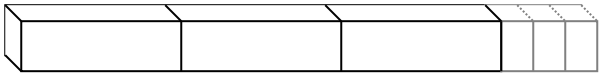

9) $2\frac{1}{5}$

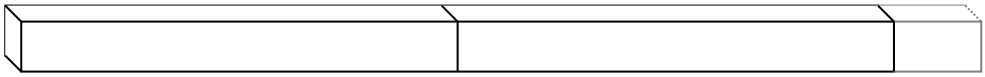

10) $9\frac{1}{2}$

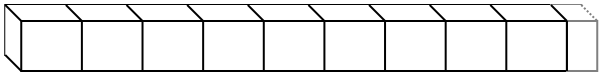

Ответы

об. 33

1. _____

2. _____

3. _____

4. _____

5. _____

6. _____

7. _____

8. _____

9. _____

10. _____

1-10	90	80	70	60	50	40	30	20	10	0

Определение малых единиц

Имя: Ключ к правильным ответам

Определите количество малых единиц в задачах.

об) $8\frac{1}{4}$

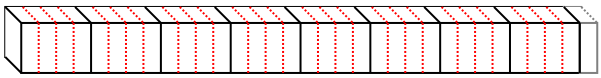

1) $6\frac{1}{4}$

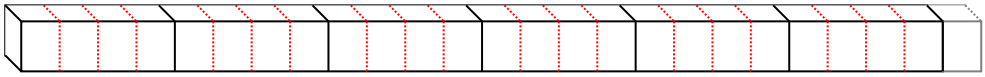

2) $6\frac{1}{2}$

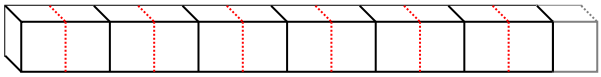

3) $7\frac{1}{4}$

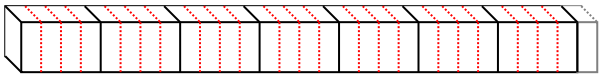

4) $3\frac{3}{5}$

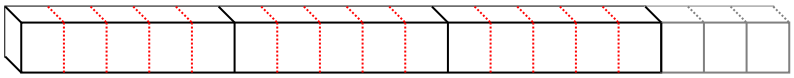

5) $3\frac{1}{3}$

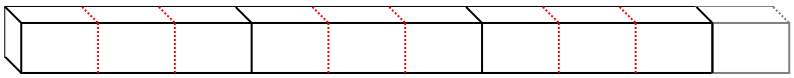

6) $2\frac{2}{5}$

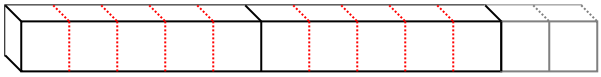

7) $9\frac{1}{3}$

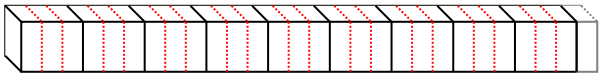

8) $3\frac{3}{5}$

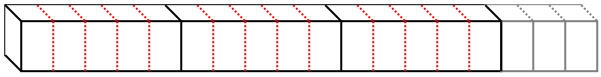

9) $2\frac{1}{5}$

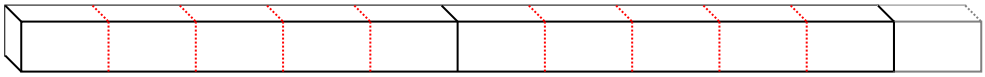

10) $9\frac{1}{2}$

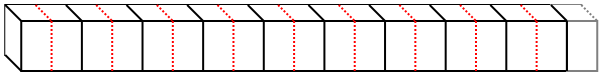

Ответы

об.	33
1.	25
2.	13
3.	29
4.	18
5.	10
6.	12
7.	28
8.	18
9.	11
10.	19

1-10	90	80	70	60	50	40	30	20	10	0

Определение малых единиц Имя:

Определите количество малых единиц в задачах.

об) $6\frac{3}{4}$

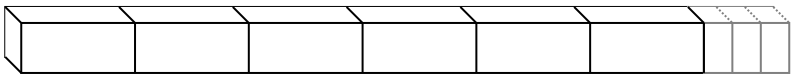

1) $7\frac{1}{2}$

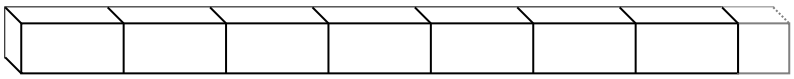

2) $5\frac{1}{2}$



3) $4\frac{1}{3}$

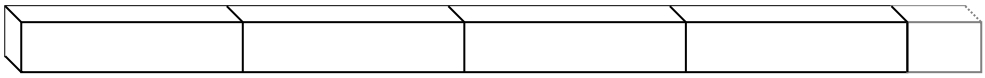

4) $9\frac{3}{4}$

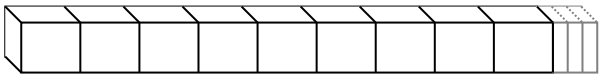

5) $7\frac{1}{2}$

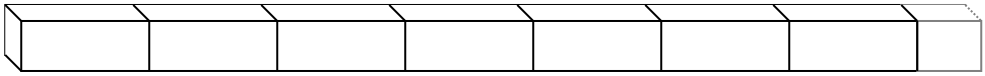

6) $8\frac{2}{3}$

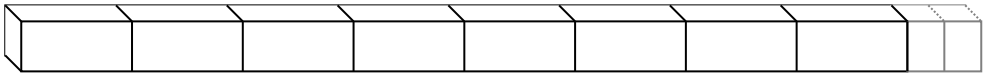

7) $2\frac{1}{2}$



8) $7\frac{1}{2}$

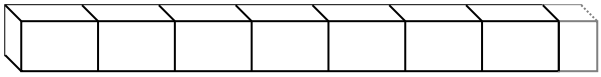

9) $2\frac{1}{3}$



10) $8\frac{1}{3}$

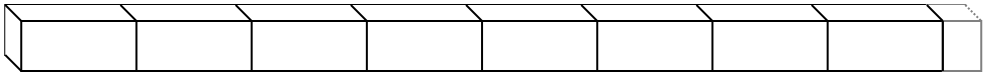

Ответы

об. 27

1. _____

2. _____

3. _____

4. _____

5. _____

6. _____

7. _____

8. _____

9. _____

10. _____

1-10	90	80	70	60	50	40	30	20	10	0

Определите количество малых единиц в задачах.

об) $6\frac{3}{4}$

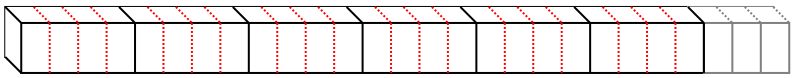

1) $7\frac{1}{2}$

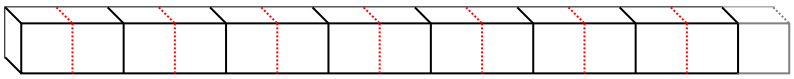

2) $5\frac{1}{2}$

3) $4\frac{1}{3}$

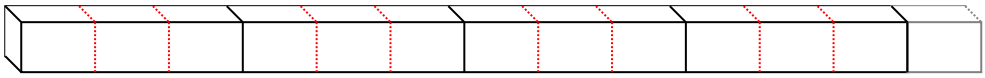

4) $9\frac{3}{4}$

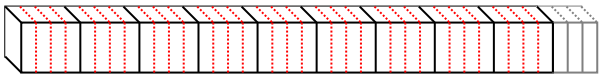

5) $7\frac{1}{2}$

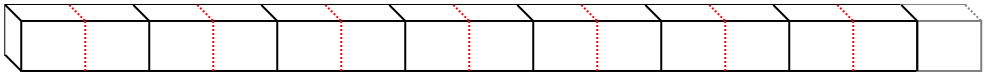

6) $8\frac{2}{3}$

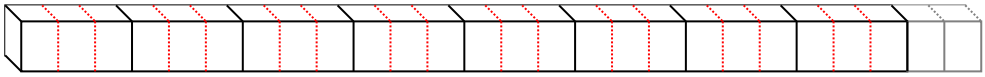

7) $2\frac{1}{2}$



8) $7\frac{1}{2}$

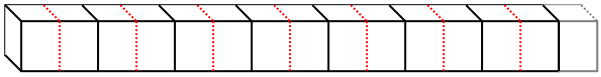

9) $2\frac{1}{3}$



10) $8\frac{1}{3}$

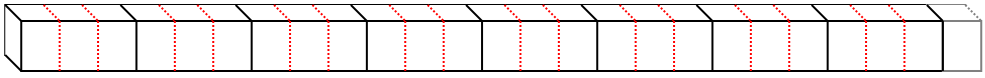

Ответы

об.	27
1.	15
2.	11
3.	13
4.	39
5.	15
6.	26
7.	5
8.	15
9.	7
10.	25

1-10	90	80	70	60	50	40	30	20	10	0

Определите количество малых единиц в задачах.

об) $5\frac{2}{4}$

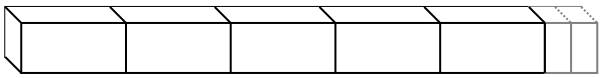

1) $6\frac{2}{4}$

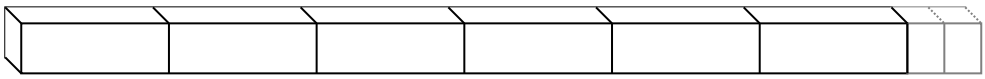

2) $2\frac{1}{5}$

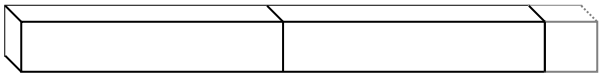

3) $2\frac{1}{3}$



4) $5\frac{1}{3}$



5) $6\frac{1}{5}$

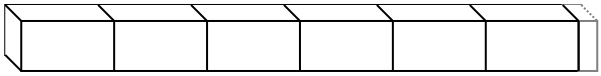

6) $3\frac{1}{5}$



7) $3\frac{1}{3}$



8) $1\frac{2}{5}$



9) $7\frac{2}{4}$

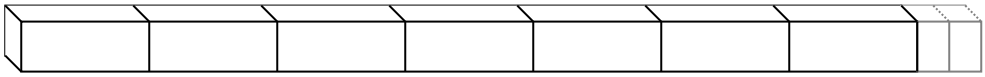

10) $3\frac{1}{4}$



Ответы

об. 22

1. _____
2. _____
3. _____
4. _____
5. _____
6. _____
7. _____
8. _____
9. _____
10. _____

1-10	90	80	70	60	50	40	30	20	10	0

Определите количество малых единиц в задачах.

об) $5\frac{2}{4}$

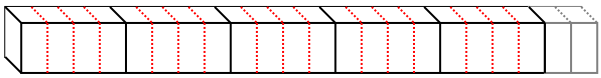

1) $6\frac{2}{4}$

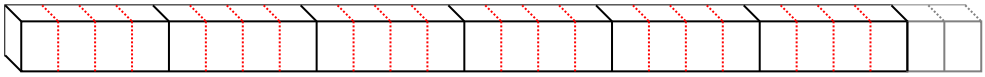

2) $2\frac{1}{5}$

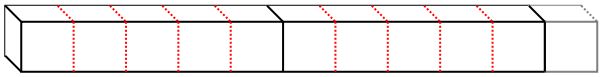

3) $2\frac{1}{3}$



4) $5\frac{1}{3}$

5) $6\frac{1}{5}$

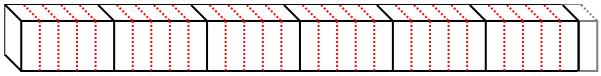

6) $3\frac{1}{5}$

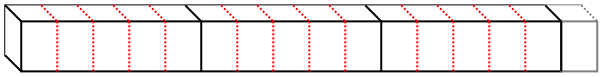

7) $3\frac{1}{3}$

8) $1\frac{2}{5}$

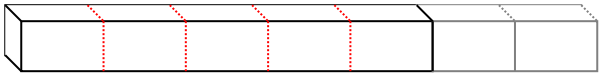

9) $7\frac{2}{4}$

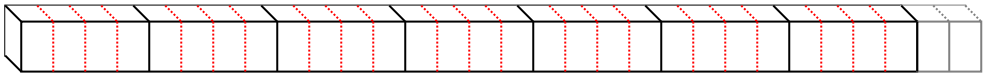

10) $3\frac{1}{4}$

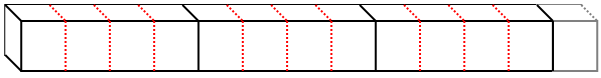

Ответы

об.	22
1.	26
2.	11
3.	7
4.	16
5.	31
6.	16
7.	10
8.	7
9.	30
10.	13

1-10	90	80	70	60	50	40	30	20	10	0

Определение малых единиц Имя:

Определите количество малых единиц в задачах.

об) $8\frac{2}{3}$

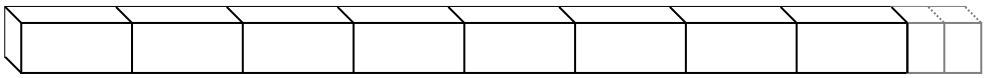

1) $7\frac{2}{3}$

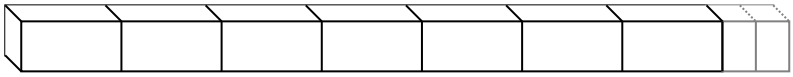

2) $5\frac{1}{3}$



3) $2\frac{1}{3}$

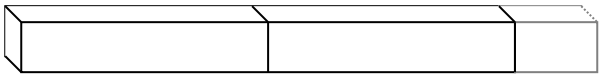

4) $1\frac{3}{4}$



5) $2\frac{2}{5}$



6) $7\frac{1}{2}$

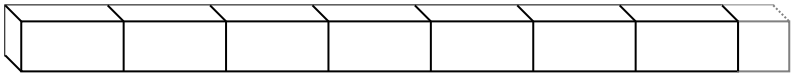

7) $9\frac{1}{4}$

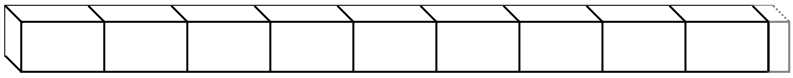

8) $1\frac{1}{2}$



9) $5\frac{2}{3}$

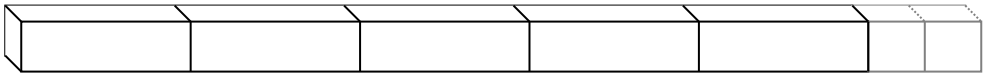

10) $2\frac{1}{3}$

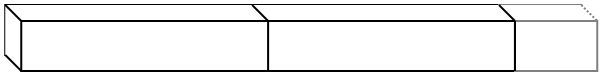

Ответы

об. 26

1. _____

2. _____

3. _____

4. _____

5. _____

6. _____

7. _____

8. _____

9. _____

10. _____

1-10	90	80	70	60	50	40	30	20	10	0

Определите количество малых единиц в задачах.

об) $8\frac{2}{3}$

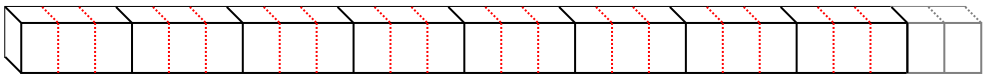

1) $7\frac{2}{3}$

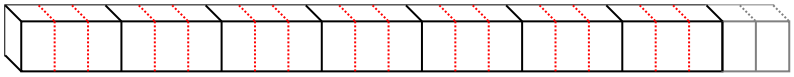

2) $5\frac{1}{3}$

3) $2\frac{1}{3}$

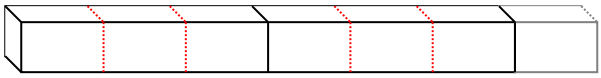

4) $1\frac{3}{4}$



5) $2\frac{2}{5}$

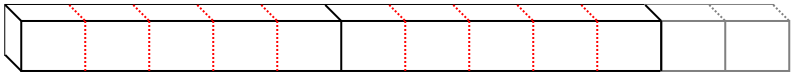

6) $7\frac{1}{2}$

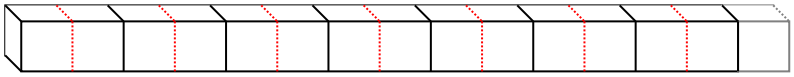

7) $9\frac{1}{4}$

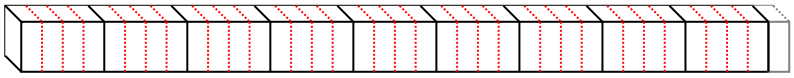

8) $1\frac{1}{2}$



9) $5\frac{2}{3}$

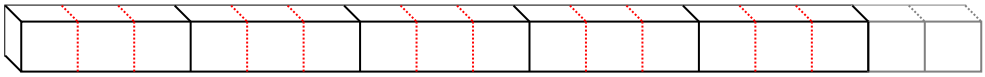

10) $2\frac{1}{3}$

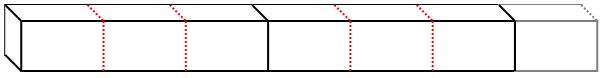

Ответы

об.	26
1.	23
2.	16
3.	7
4.	7
5.	12
6.	15
7.	37
8.	3
9.	17
10.	7

1-10	90	80	70	60	50	40	30	20	10	0

Определение малых единиц Имя:

Определите количество малых единиц в задачах.

об) $5\frac{3}{4}$

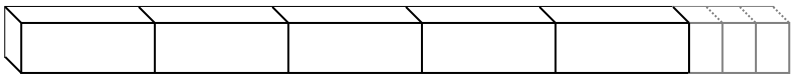

1) $9\frac{1}{5}$



2) $8\frac{4}{5}$

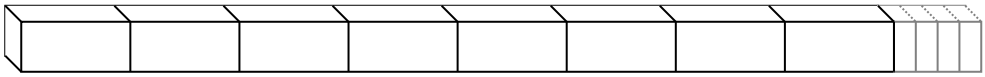

3) $4\frac{2}{5}$

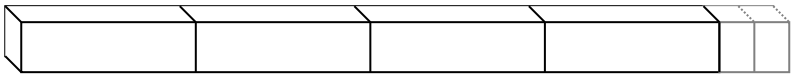

4) $7\frac{1}{3}$

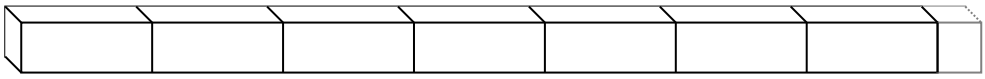

5) $8\frac{2}{3}$

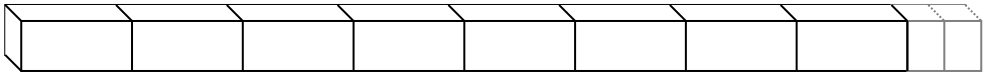

6) $2\frac{1}{3}$



7) $3\frac{2}{5}$



8) $9\frac{1}{5}$



9) $9\frac{3}{4}$

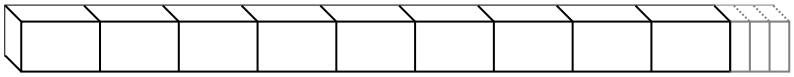

10) $1\frac{1}{2}$



Ответы

об. 23

1. _____
2. _____
3. _____
4. _____
5. _____
6. _____
7. _____
8. _____
9. _____
10. _____

1-10	90	80	70	60	50	40	30	20	10	0

Определение малых единиц

Имя: Ключ к правильным ответам

Определите количество малых единиц в задачах.

об) $5\frac{3}{4}$

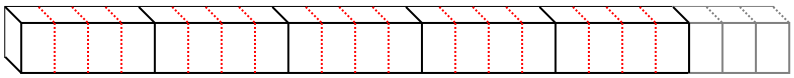

1) $9\frac{1}{5}$

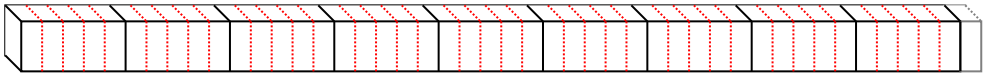

2) $8\frac{4}{5}$

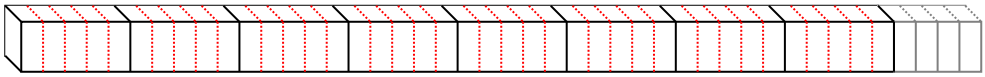

3) $4\frac{2}{5}$

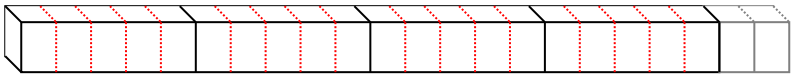

4) $7\frac{1}{3}$

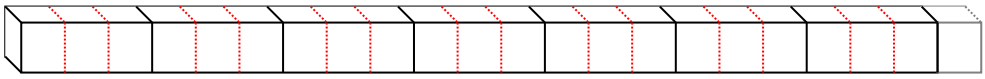

5) $8\frac{2}{3}$

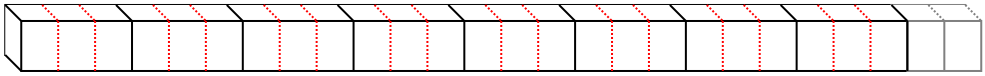

6) $2\frac{1}{3}$



7) $3\frac{2}{5}$

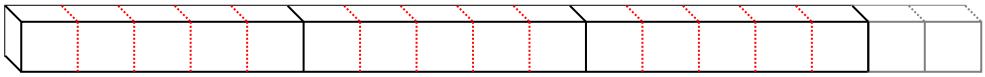

8) $9\frac{1}{5}$

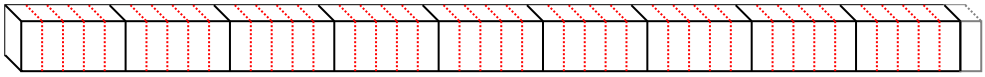

9) $9\frac{3}{4}$

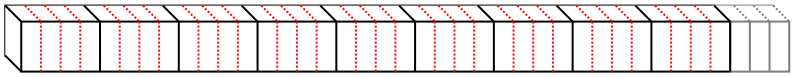

10) $1\frac{1}{2}$



Ответы

об.	23
1.	46
2.	44
3.	22
4.	22
5.	26
6.	7
7.	17
8.	46
9.	39
10.	3

1-10	90	80	70	60	50	40	30	20	10	0