Определение объема соединенных прямоугольных призм. Имя:

**Найдите общий объем каждой фигуры. Размеры указаны в сантиметрах (без учета масштаба).**

**Ответы**

1. _____

2. _____

3. _____

4. _____

5. _____

**1)**

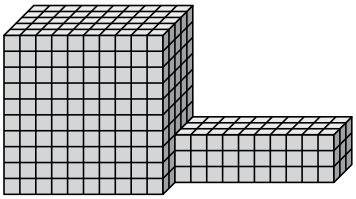

**2)**

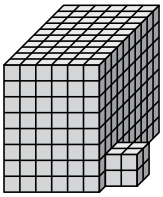

**3)**

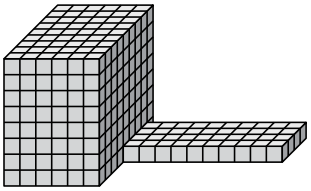

**4)**

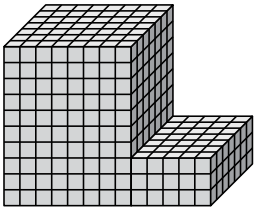

**5)**

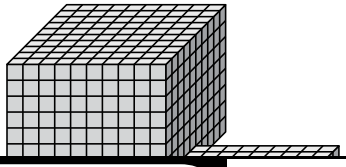

| 1-5 | 80 | 60 | 40 | 20 | 0 |
|---|---|---|---|---|---|

Определение объема соединенных прямоугольных призм. Имя: **Ключ к правильным ответам**

**Найдите общий объем каждой фигуры. Размеры указаны в сантиметрах (без учета масштаба).**

**1)**

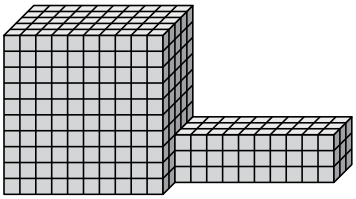

$10 \times 5 \times 10 = 500$
$10 \times 3 \times 3 = 90$

**2)**

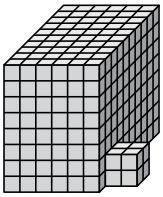

$6 \times 10 \times 8 = 480$
$2 \times 2 \times 2 = 8$

**3)**

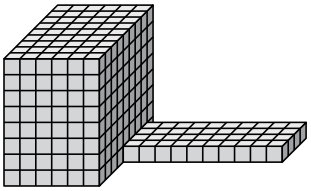

$6 \times 9 \times 8 = 432$
$10 \times 4 \times 1 = 40$

**4)**

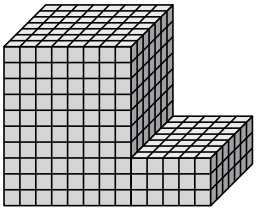

$8 \times 7 \times 10 = 560$
$5 \times 7 \times 3 = 105$

**5)**

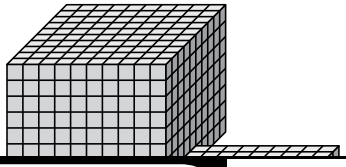

$10 \times 10 \times 8 = 800$
$9 \times 4 \times 1 = 36$

## Ответы

1. **590 cm$^3$**
2. **488 cm$^3$**
3. **472 cm$^3$**
4. **665 cm$^3$**
5. **836 cm$^3$**



| 1-5 | 80 | 60 | 40 | 20 | 0 |
|---|---|---|---|---|---|