Найдите значение X.

1) Периметр = 18,8 u

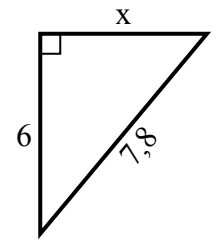

2) Периметр = 8,6 u

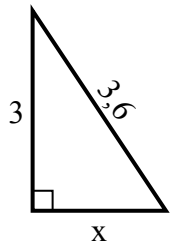

3) Периметр = 14,3 u

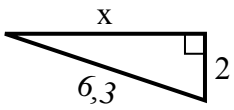

4) Периметр = 17,1 u

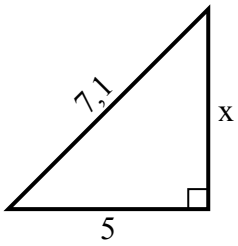

5) Периметр = 22,2 u

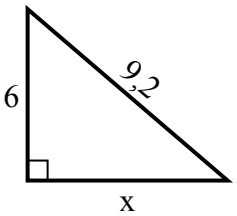

6) Периметр = 13,8 u

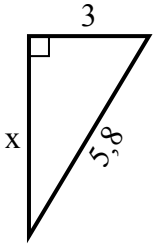

7) Периметр = 25,8 u

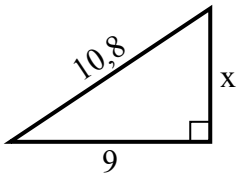

8) Периметр = 20,9 u

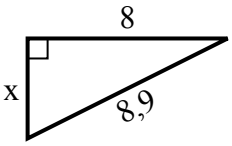

9) Периметр = 25,6 u

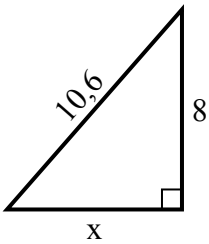

10) Периметр = 29 u

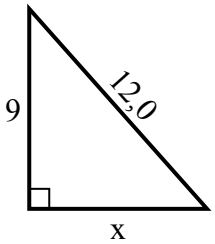

11) Периметр = 15,4 u

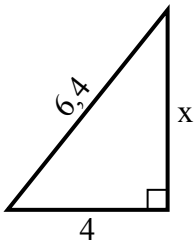

12) Периметр = 10,5 u

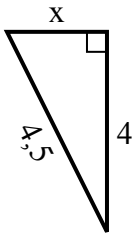

Ответы

1. _____
2. _____
3. _____
4. _____
5. _____
6. _____
7. _____
8. _____
9. _____
10. _____
11. _____
12. _____

1-10	92	83	75	67	58	50	42	33	25	17
11-12	8	0								

Найдите значение X.

1) Периметр = 18,8 u

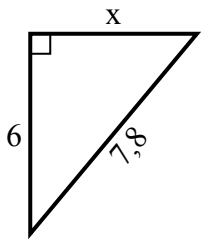

2) Периметр = 8,6 u

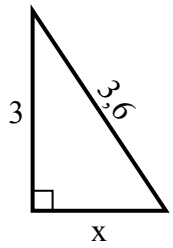

3) Периметр = 14,3 u

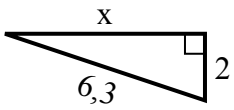

4) Периметр = 17,1 u

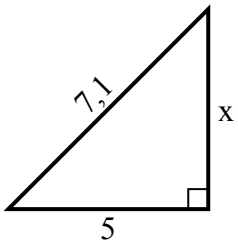

5) Периметр = 22,2 u

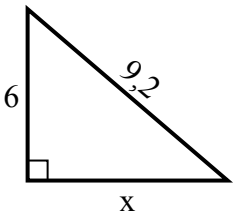

6) Периметр = 13,8 u

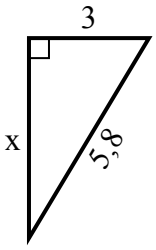

7) Периметр = 25,8 u

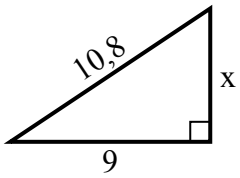

8) Периметр = 20,9 u

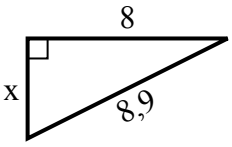

9) Периметр = 25,6 u

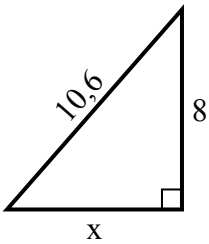

10) Периметр = 29 u

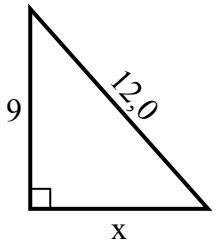

11) Периметр = 15,4 u

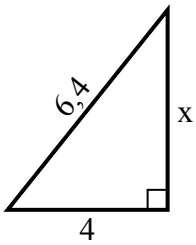

12) Периметр = 10,5 u

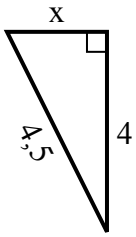

Ответы

1. 5
2. 2
3. 6
4. 5
5. 7
6. 5
7. 6
8. 4
9. 7
10. 8
11. 5
12. 2

1-10	92	83	75	67	58	50	42	33	25	17
11-12	8	0								