Найдите значение X.

1) Периметр = 16,3 u

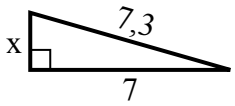

2) Периметр = 17,2 u

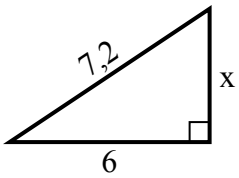

3) Периметр = 15,4 u

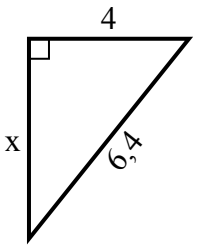

4) Периметр = 20,9 u

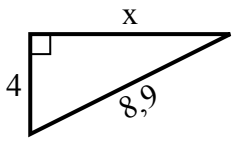

5) Периметр = 22,8 u

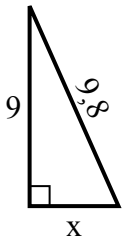

6) Периметр = 17,6 u

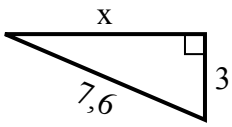

7) Периметр = 24,3 u

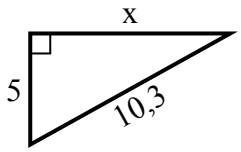

8) Периметр = 22,4 u

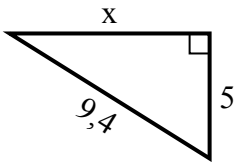

9) Периметр = 12,4 u

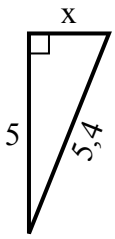

10) Периметр = 20,6 u

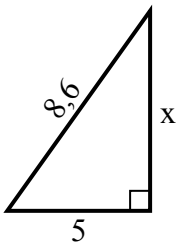

11) Периметр = 13,8 u

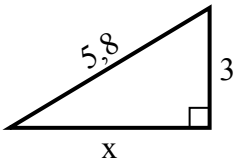

12) Периметр = 19,5 u

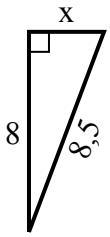

Ответы

1. _____
2. _____
3. _____
4. _____
5. _____
6. _____
7. _____
8. _____
9. _____
10. _____
11. _____
12. _____

1-10	92	83	75	67	58	50	42	33	25	17
11-12	8	0								

Найдите значение X.

1) Периметр = 16,3 u

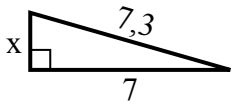

2) Периметр = 17,2 u

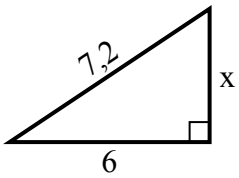

3) Периметр = 15,4 u

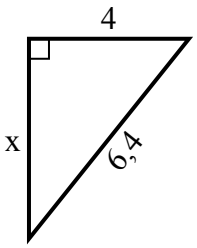

4) Периметр = 20,9 u

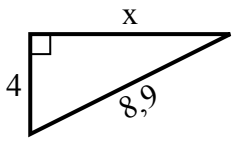

5) Периметр = 22,8 u

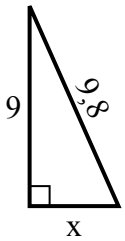

6) Периметр = 17,6 u

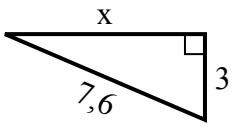

7) Периметр = 24,3 u

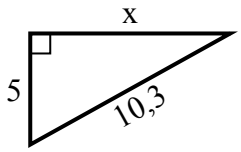

8) Периметр = 22,4 u

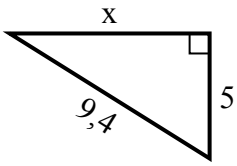

9) Периметр = 12,4 u

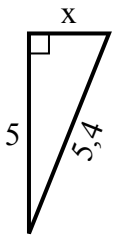

10) Периметр = 20,6 u

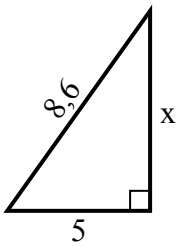

11) Периметр = 13,8 u

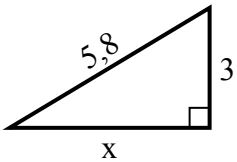

12) Периметр = 19,5 u

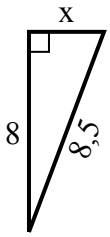

Ответы

1. 2
2. 4
3. 5
4. 8
5. 4
6. 7
7. 9
8. 8
9. 2
10. 7
11. 5
12. 3

1-10	92	83	75	67	58	50	42	33	25	17
11-12	8	0								