Найдите значение X.

1) Периметр = 20,9 u

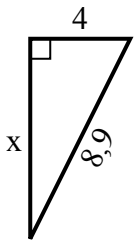

2) Периметр = 21,5 u

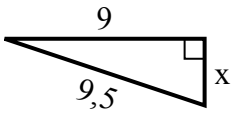

3) Периметр = 14,3 u

4) Периметр = 18,2 u

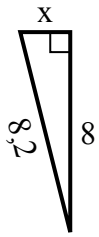

5) Периметр = 19,1 u

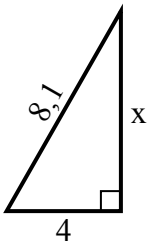

6) Периметр = 22,2 u

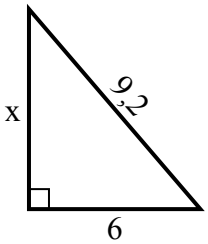

7) Периметр = 22,8 u

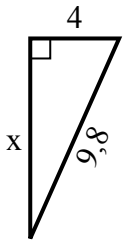

8) Периметр = 29 u

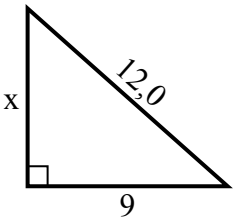

9) Периметр = 25,8 u

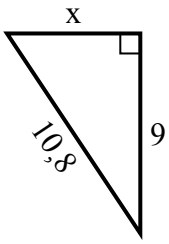

10) Периметр = 20,6 u

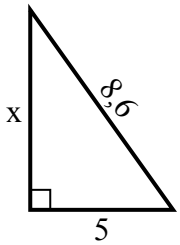

11) Периметр = 6,8 u

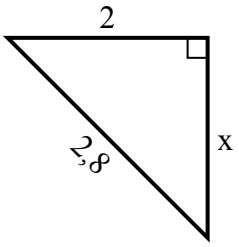

12) Периметр = 21,5 u

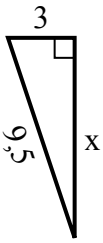

Ответы

1. _____
2. _____
3. _____
4. _____
5. _____
6. _____
7. _____
8. _____
9. _____
10. _____
11. _____
12. _____

1-10	92	83	75	67	58	50	42	33	25	17
11-12	8	0								

Найдите значение X.

1) Периметр = 20,9 u

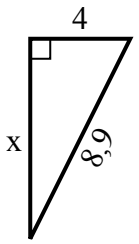

2) Периметр = 21,5 u

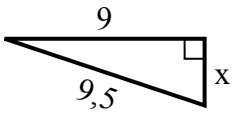

3) Периметр = 14,3 u

4) Периметр = 18,2 u

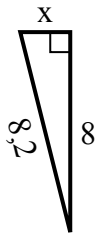

5) Периметр = 19,1 u

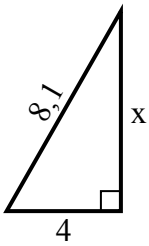

6) Периметр = 22,2 u

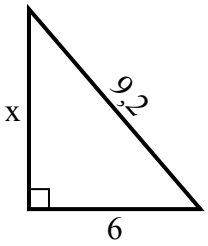

7) Периметр = 22,8 u

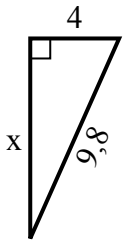

8) Периметр = 29 u

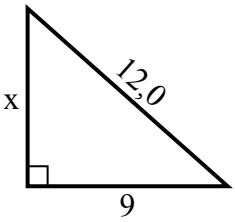

9) Периметр = 25,8 u

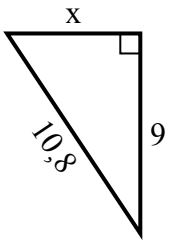

10) Периметр = 20,6 u

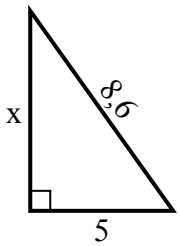

11) Периметр = 6,8 u

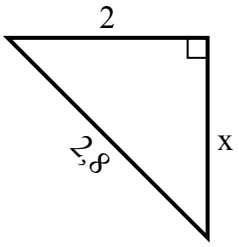

12) Периметр = 21,5 u

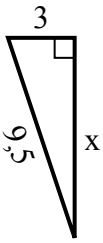

Ответы

1. 8
2. 3
3. 2
4. 2
5. 7
6. 7
7. 9
8. 8
9. 6
10. 7
11. 2
12. 9

1-10	92	83	75	67	58	50	42	33	25	17
11-12	8	0								