Умножение дробей (визуальное)

Имя:

Используйте поля с фигурами, показывающие примеры умножения.

обр) $\frac{1}{3} \times \frac{4}{9} =$

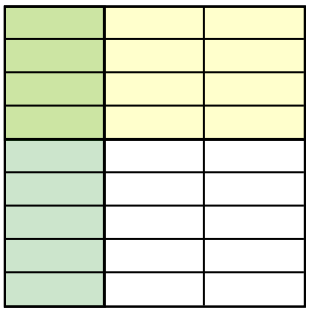

1) $\frac{1}{2} \times \frac{6}{7} =$

2) $\frac{1}{5} \times \frac{8}{9} =$

3) $\frac{3}{4} \times \frac{1}{4} =$

4) $\frac{5}{6} \times \frac{1}{2} =$

5) $\frac{5}{8} \times \frac{1}{2} =$

6) $\frac{4}{8} \times \frac{1}{4} =$

7) $\frac{7}{9} \times \frac{1}{2} =$

8) $\frac{1}{2} \times \frac{1}{7} =$

9) $\frac{3}{9} \times \frac{1}{2} =$

10) $\frac{1}{6} \times \frac{3}{4} =$

11) $\frac{4}{8} \times \frac{1}{2} =$

Ответы

обр $4/27$

1. _____
2. _____
3. _____
4. _____
5. _____
6. _____
7. _____
8. _____
9. _____
10. _____
11. _____

Умножение дробей (визуальное)

Имя: **Ключ к правильным ответам**

Используйте поля с фигурами, показывающие примеры умножения.

обр) $\frac{1}{3} \times \frac{4}{9} =$

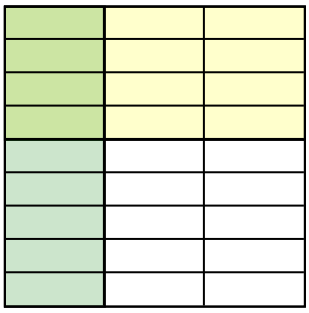

1) $\frac{1}{2} \times \frac{6}{7} =$

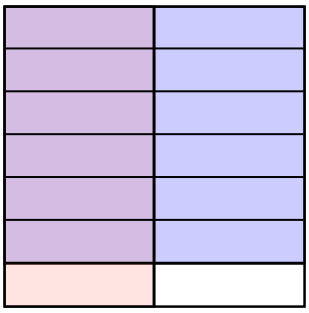

2) $\frac{1}{5} \times \frac{8}{9} =$

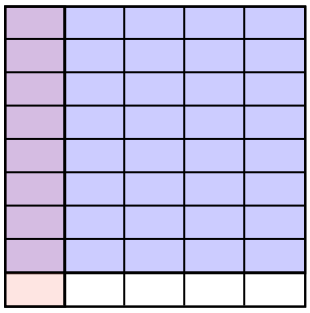

3) $\frac{3}{4} \times \frac{1}{4} =$



4) $\frac{5}{6} \times \frac{1}{2} =$

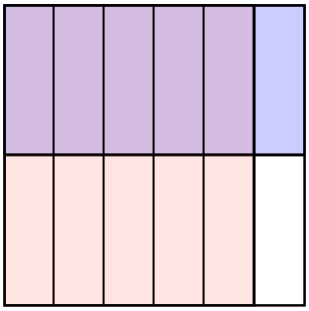

5) $\frac{5}{8} \times \frac{1}{2} =$

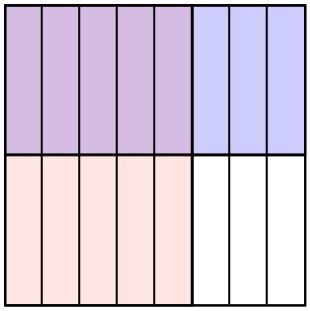

6) $\frac{4}{8} \times \frac{1}{4} =$

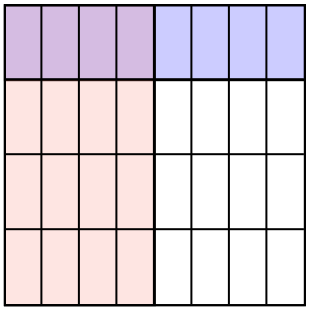

7) $\frac{7}{9} \times \frac{1}{2} =$

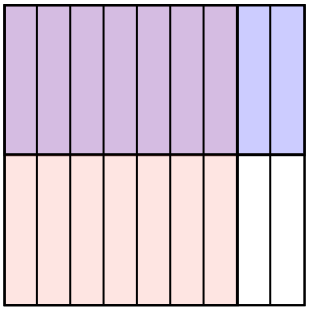

8) $\frac{1}{2} \times \frac{1}{7} =$

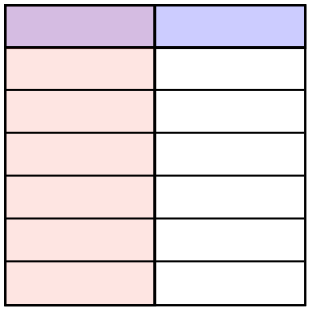

9) $\frac{3}{9} \times \frac{1}{2} =$

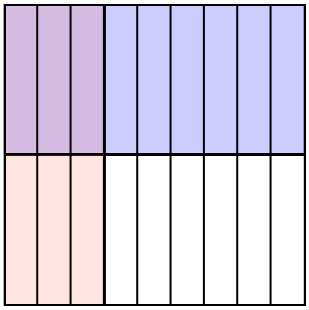

10) $\frac{1}{6} \times \frac{3}{4} =$

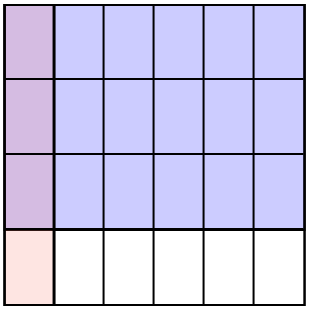

11) $\frac{4}{8} \times \frac{1}{2} =$

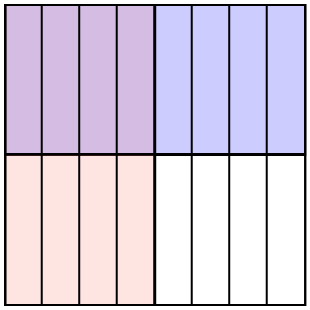

Ответы

обр	4/27
1.	6/14
2.	8/45
3.	3/16
4.	5/12
5.	5/16
6.	4/32
7.	7/18
8.	1/14
9.	3/18
10.	3/24
11.	4/16