Умножение дробей (визуальное)

Имя:

Используйте поля с фигурами, показывающие примеры умножения.

обр) $\frac{1}{9} \times \frac{4}{7} =$

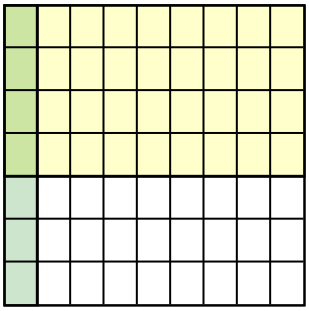

1) $\frac{2}{4} \times \frac{6}{7} =$

2) $\frac{1}{8} \times \frac{1}{5} =$

3) $\frac{5}{9} \times \frac{1}{4} =$

4) $\frac{1}{2} \times \frac{1}{2} =$

5) $\frac{1}{5} \times \frac{1}{2} =$

6) $\frac{4}{5} \times \frac{1}{3} =$

7) $\frac{2}{5} \times \frac{4}{8} =$

8) $\frac{2}{7} \times \frac{1}{7} =$

9) $\frac{5}{7} \times \frac{1}{4} =$

10) $\frac{3}{7} \times \frac{2}{4} =$

11) $\frac{1}{2} \times \frac{2}{3} =$

Ответы

обр. $4/63$

1. _____
2. _____
3. _____
4. _____
5. _____
6. _____
7. _____
8. _____
9. _____
10. _____
11. _____

1-10	91	82	73	64	55	45	36	27	18	9
11	0									

Умножение дробей (визуальное)

Имя: **Ключ к правильным ответам**

Используйте поля с фигурами, показывающие примеры умножения.

обр) $\frac{1}{9} \times \frac{4}{7} =$

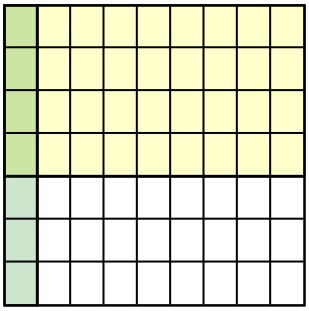

1) $\frac{2}{4} \times \frac{6}{7} =$



2) $\frac{1}{8} \times \frac{1}{5} =$

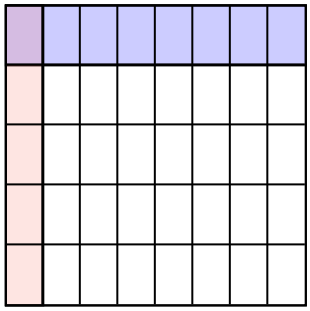

3) $\frac{5}{9} \times \frac{1}{4} =$

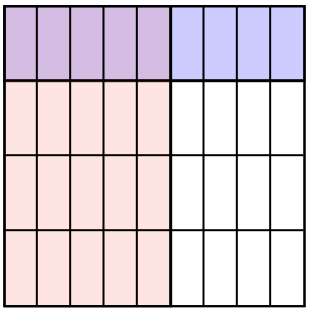

4) $\frac{1}{2} \times \frac{1}{2} =$



5) $\frac{1}{5} \times \frac{1}{2} =$

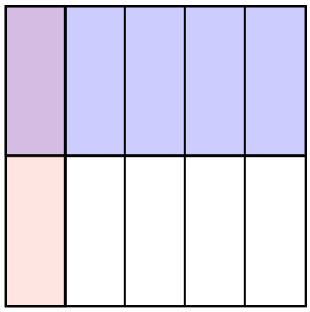

6) $\frac{4}{5} \times \frac{1}{3} =$

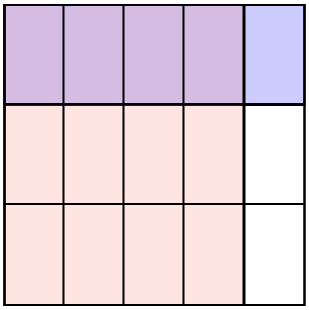

7) $\frac{2}{5} \times \frac{4}{8} =$

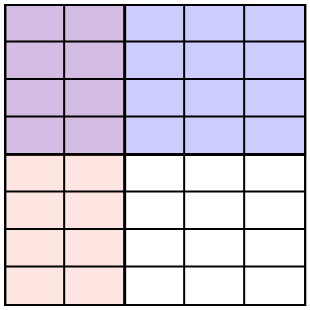

8) $\frac{2}{7} \times \frac{1}{7} =$

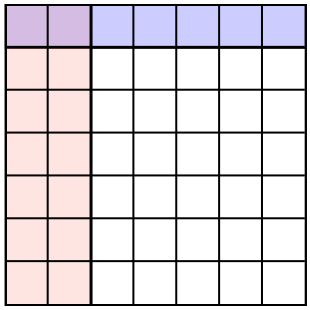

9) $\frac{5}{7} \times \frac{1}{4} =$

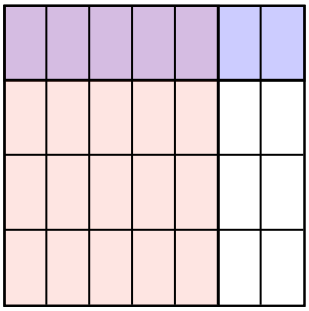

10) $\frac{3}{7} \times \frac{2}{4} =$

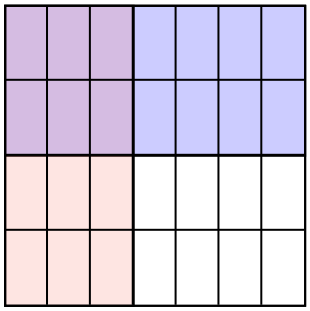

11) $\frac{1}{2} \times \frac{2}{3} =$



Ответы

обр.	$\frac{4}{63}$
1.	$\frac{12}{28}$
2.	$\frac{1}{40}$
3.	$\frac{5}{36}$
4.	$\frac{1}{4}$
5.	$\frac{1}{10}$
6.	$\frac{4}{15}$
7.	$\frac{8}{40}$
8.	$\frac{2}{49}$
9.	$\frac{5}{28}$
10.	$\frac{6}{28}$
11.	$\frac{2}{6}$

1-10	91	82	73	64	55	45	36	27	18	9
11	0									