Умножение дробей (визуальное)

Имя:

Используйте поля с фигурами, показывающие примеры умножения.

обр) $\frac{7}{8} \times \frac{5}{6} =$

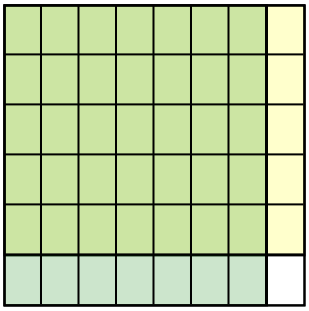

1) $\frac{4}{5} \times \frac{4}{8} =$

2) $\frac{4}{5} \times \frac{4}{8} =$

3) $\frac{2}{4} \times \frac{1}{3} =$

4) $\frac{2}{3} \times \frac{4}{5} =$

5) $\frac{3}{5} \times \frac{2}{3} =$

6) $\frac{2}{5} \times \frac{1}{3} =$

7) $\frac{3}{6} \times \frac{1}{7} =$

8) $\frac{1}{2} \times \frac{2}{7} =$

9) $\frac{4}{6} \times \frac{2}{5} =$

10) $\frac{5}{9} \times \frac{6}{8} =$

11) $\frac{7}{9} \times \frac{1}{2} =$

Ответы

обр. $\frac{35}{48}$

1. _____
2. _____
3. _____
4. _____
5. _____
6. _____
7. _____
8. _____
9. _____
10. _____
11. _____

1-10	91	82	73	64	55	45	36	27	18	9
11	0									

Умножение дробей (визуальное) Имя: **Ключ к правильным ответам**

Используйте поля с фигурами, показывающие примеры умножения.

обр) $\frac{7}{8} \times \frac{5}{6} =$

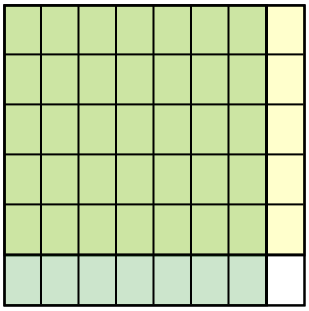

1) $\frac{4}{5} \times \frac{4}{8} =$

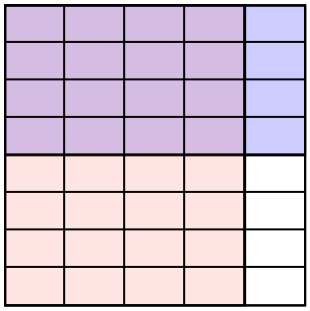

2) $\frac{4}{5} \times \frac{4}{8} =$

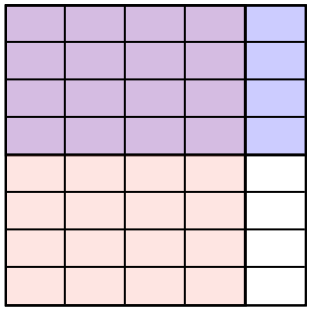

3) $\frac{2}{4} \times \frac{1}{3} =$



4) $\frac{2}{3} \times \frac{4}{5} =$

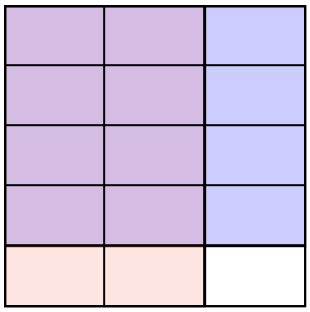

5) $\frac{3}{5} \times \frac{2}{3} =$

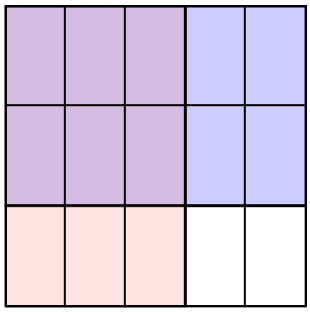

6) $\frac{2}{5} \times \frac{1}{3} =$

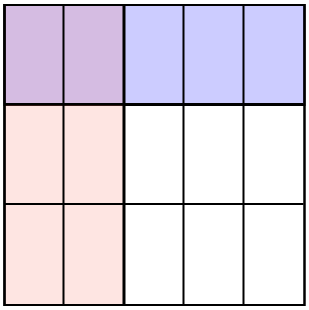

7) $\frac{3}{6} \times \frac{1}{7} =$

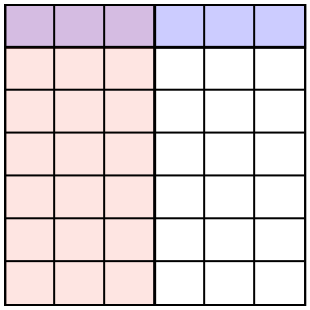

8) $\frac{1}{2} \times \frac{2}{7} =$

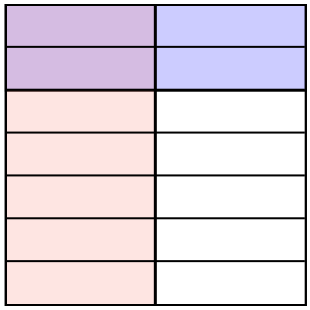

9) $\frac{4}{6} \times \frac{2}{5} =$

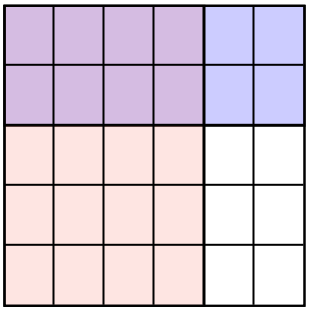

10) $\frac{5}{9} \times \frac{6}{8} =$

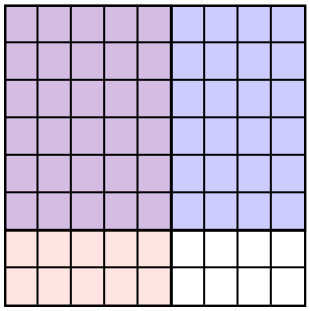

11) $\frac{7}{9} \times \frac{1}{2} =$

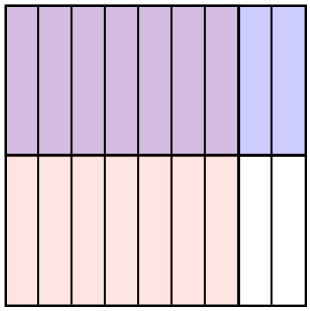

Ответы

обр.	35/48
1.	16/40
2.	16/40
3.	2/12
4.	8/15
5.	6/15
6.	2/15
7.	3/42
8.	2/14
9.	8/30
10.	30/72
11.	7/18

1-10	91	82	73	64	55	45	36	27	18	9
11	0									