Неправильные и смешанные дроби визуально

Имя:

Напишите каждый ряд фигур в виде смешанного числа.

1) 

2) 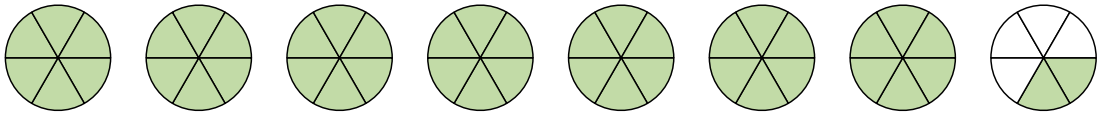

3) 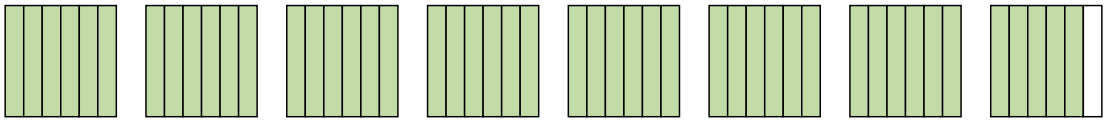

4) 

5) 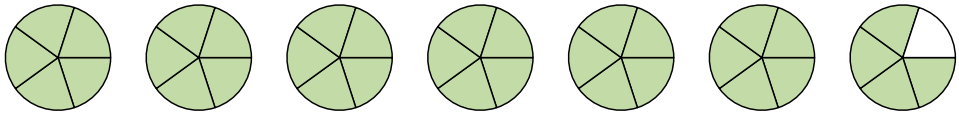

Напишите каждое число в виде неправильной дроби.

6) 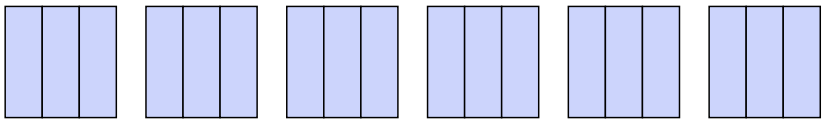

7) 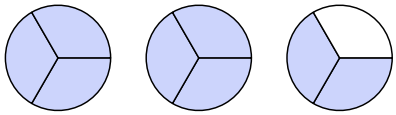

8) 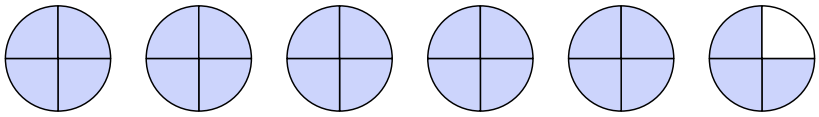

9) 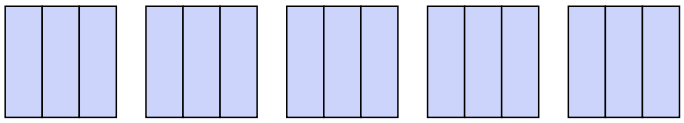

10) 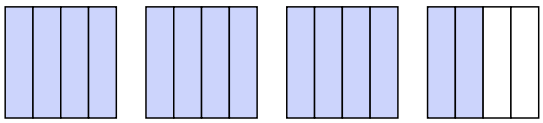

11) 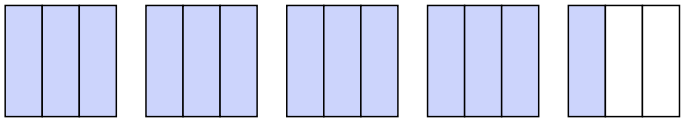

Ответы

1. _____
2. _____
3. _____
4. _____
5. _____
6. _____
7. _____
8. _____
9. _____
10. _____
11. _____

Неправильные и смешанные дроби визуально

Имя: **Ключ к правильным ответам**

Напишите каждый ряд фигур в виде смешанного числа.

1) 

2) 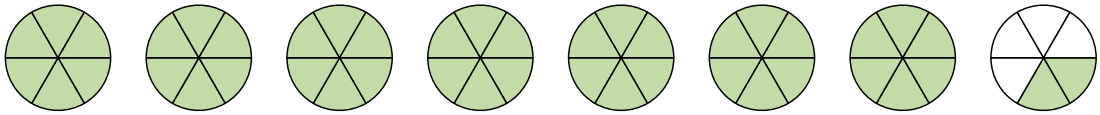

3) 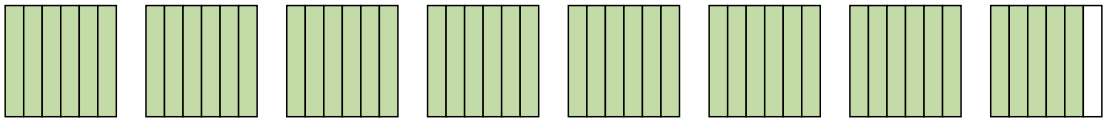

4) 

5) 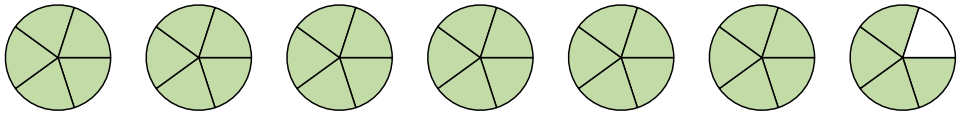

Напишите каждое число в виде неправильной дроби.

6) 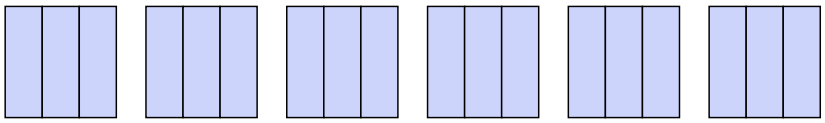

7) 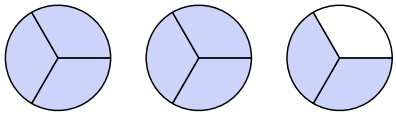

8) 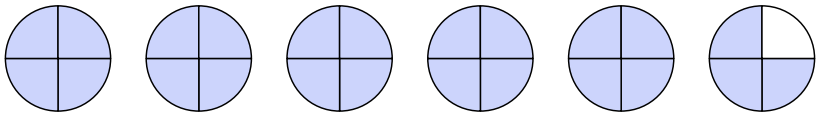

9) 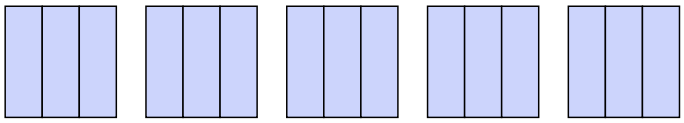

10) 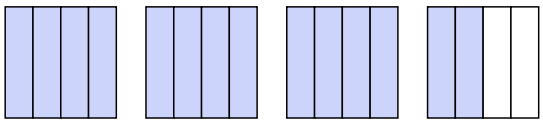

11) 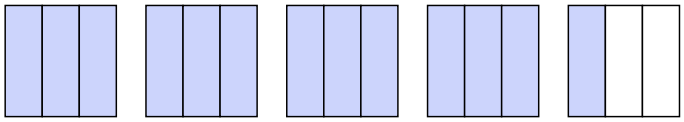

Ответы

1. $4\frac{1}{2}$
2. $7\frac{2}{6}$
3. $7\frac{5}{6}$
4. $6\frac{1}{2}$
5. $6\frac{4}{5}$
6. $\frac{18}{3}$
7. $\frac{8}{3}$
8. $\frac{23}{4}$
9. $\frac{15}{3}$
10. $\frac{14}{4}$
11. $\frac{13}{3}$