Неправильные и смешанные дроби визуально

Имя:

Напишите каждый ряд фигур в виде смешанного числа.

1) 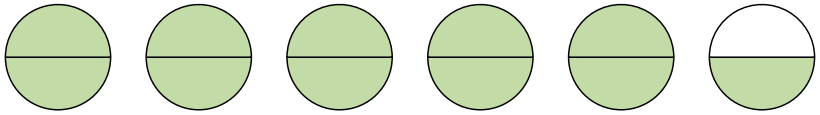

2) 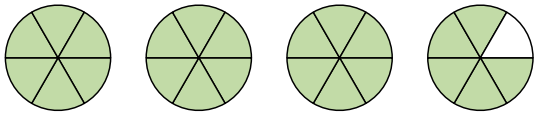

3) 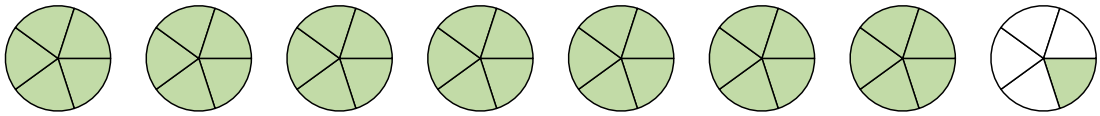

4) 

5) 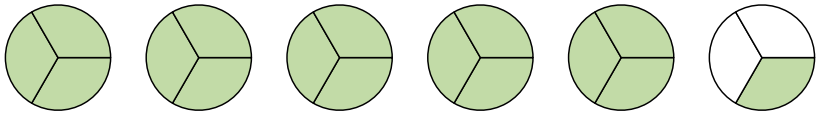

Напишите каждое число в виде неправильной дроби.

6) 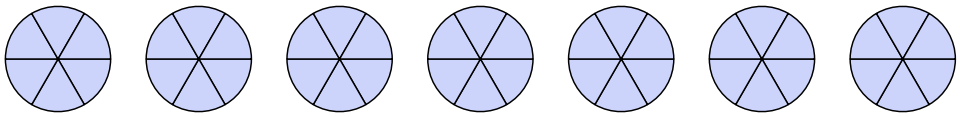

7) 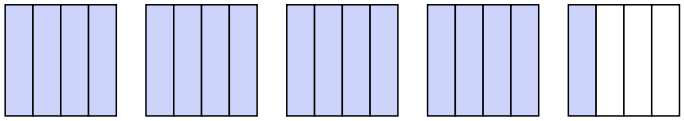

8) 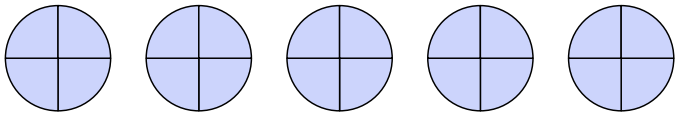

9) 

10) 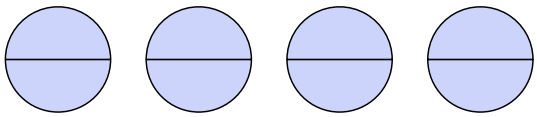

11) 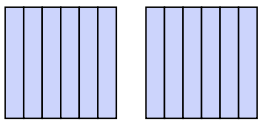

Ответы

1. _____
2. _____
3. _____
4. _____
5. _____
6. _____
7. _____
8. _____
9. _____
10. _____
11. _____

1-10	91	82	73	64	55	45	36	27	18	9
11	0									

Неправильные и смешанные дроби визуально

Имя:

Ключ к правильным ответам

Напишите каждый ряд фигур в виде смешанного числа.

1) 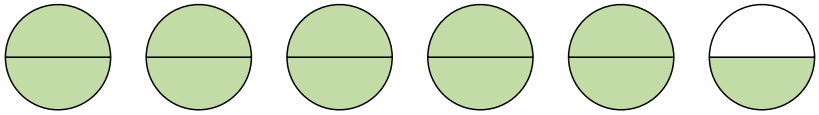

2) 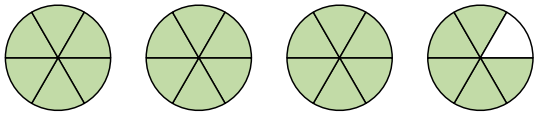

3) 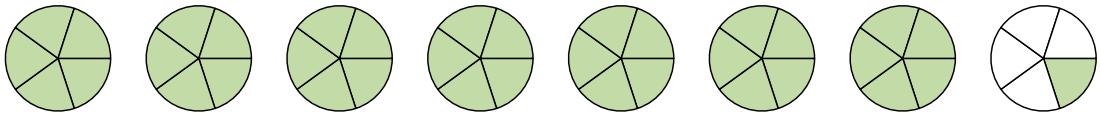

4) 

5) 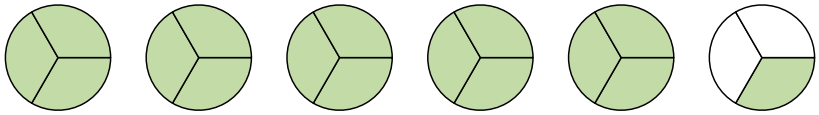

Напишите каждое число в виде неправильной дроби.

6) 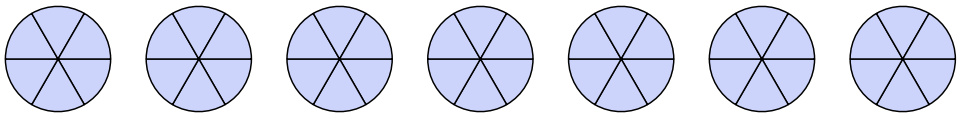

7) 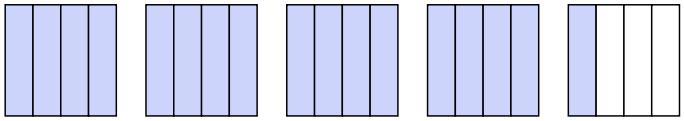

8) 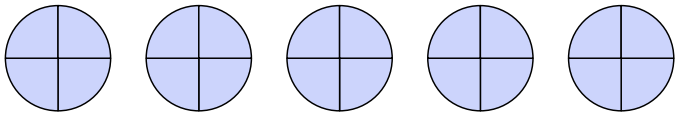

9) 

10) 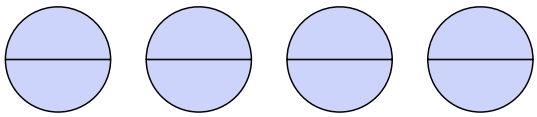

11) 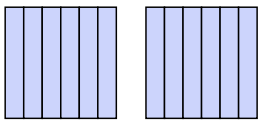

Ответы

1. $5\frac{1}{2}$
2. $3\frac{5}{6}$
3. $7\frac{1}{5}$
4. $6\frac{1}{2}$
5. $5\frac{1}{3}$
6. $\frac{42}{6}$
7. $\frac{17}{4}$
8. $\frac{20}{4}$
9. $\frac{5}{2}$
10. $\frac{8}{2}$
11. $\frac{12}{6}$

1-10	91	82	73	64	55	45	36	27	18	9
11	0									