Написание задач на умножение (визуальное)

Имя:

Перепишите каждую матрицу в виде умножения и решите.

обр)



1)



2)

3)



4)



5)

6)

7)

8)

9)



10)



11)



Ответы

обр $10 \times 8 = 80$

1. _____
2. _____
3. _____
4. _____
5. _____
6. _____
7. _____
8. _____
9. _____
10. _____
11. _____

Написание задач на умножение (визуальное)

Имя: **Ключ к правильным ответам**

Перепишите каждую матрицу в виде умножения и решите.

обр)



1)



2)

3)



4)



5)

6)

7)

8)

9)



10)



11)



Ответы

обр	10 × 8 = 80
1.	10 × 9 = 90
2.	5 × 5 = 25
3.	9 × 4 = 36
4.	5 × 8 = 40
5.	5 × 9 = 45
6.	9 × 5 = 45
7.	8 × 4 = 32
8.	4 × 2 = 8
9.	2 × 5 = 10
10.	6 × 10 = 60
11.	6 × 5 = 30