Написание задач на умножение (визуальное)

Имя:

Перепишите каждую матрицу в виде умножения и решите.

обр)



1)



2)

3)



4)

5)

6)



7)

8)



9)

10)



11)



Ответы

обр. 6 × 10 = 60

1. _____
2. _____
3. _____
4. _____
5. _____
6. _____
7. _____
8. _____
9. _____
10. _____
11. _____

1-10	91	82	73	64	55	45	36	27	18	9
11	0									

Написание задач на умножение (визуальное) Имя: **Ключ к правильным ответам**

Перепишите каждую матрицу в виде умножения и решите.

обр) 

1) 

2)

3) 

4)

5)

6) 

7)

8) 

9)

10) 

11) 

Ответы

обр. 6 × 10 = 60

1. 9 × 2 = 18
2. 7 × 5 = 35
3. 5 × 10 = 50
4. 3 × 3 = 9
5. 8 × 4 = 32
6. 8 × 7 = 56
7. 4 × 2 = 8
8. 8 × 8 = 64
9. 3 × 9 = 27
10. 8 × 9 = 72
11. 10 × 4 = 40

1-10	91	82	73	64	55	45	36	27	18	9
11	0									