# Написание задач на умножение (визуальное)

Имя:

**Перепишите каждую матрицу в виде умножения и решите.**

обр) 

1) 

2)

3) 

4)

5) 

6)

7)

8)

9) 

10)

11) 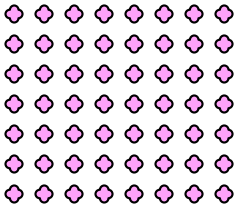

## Ответы

обр. $2 \times 6 = 12$

1. _____
2. _____
3. _____
4. _____
5. _____
6. _____
7. _____
8. _____
9. _____
10. _____
11. _____



| | | | | | | | | | | |
|---|---|---|---|---|---|---|---|---|---|---|
| 1-10 | 91 | 82 | 73 | 64 | 55 | 45 | 36 | 27 | 18 | 9 |
| 11 | 0 | | | | | | | | | |

# Написание задач на умножение (визуальное)

Имя: **Ключ к правильным ответам**

**Перепишите каждую матрицу в виде умножения и решите.**

**обр)** 

**1)** 

**2)**

**3)** 

**4)**

**5)** 

**6)**

**7)**

**8)**

**9)** 

**10)**

**11)** 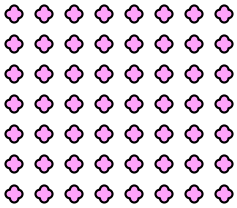

## Ответы

обр. **2 × 6 = 12**

1. **2 × 5 = 10**
2. **4 × 4 = 16**
3. **5 × 8 = 40**
4. **2 × 10 = 20**
5. **8 × 6 = 48**
6. **4 × 2 = 8**
7. **8 × 3 = 24**
8. **4 × 8 = 32**
9. **8 × 5 = 40**
10. **4 × 7 = 28**
11. **7 × 8 = 56**



| | | | | | | | | | | |
|---|---|---|---|---|---|---|---|---|---|---|
| 1-10 | 91 | 82 | 73 | 64 | 55 | 45 | 36 | 27 | 18 | 9 |
| 11 | 0 | | | | | | | | | |