Написание задач на умножение (визуальное)

Имя:

Перепишите каждую матрицу в виде умножения и решите.

обр) 

1) 

2)

3) 

4)

5) 

6)

7)

8) 

9)

10) 

11)

Ответы

обр. 5 × 4 = 20

1. _____
2. _____
3. _____
4. _____
5. _____
6. _____
7. _____
8. _____
9. _____
10. _____
11. _____

1-10	91	82	73	64	55	45	36	27	18	9
11	0									

Написание задач на умножение (визуальное) Имя: **Ключ к правильным ответам**

Перепишите каждую матрицу в виде умножения и решите.

обр) 

1) 

2)

3) 

4)

5) 

6)

7)

8) 

9)

10) 

11)

Ответы

обр. 5 × 4 = 20

1. 8 × 10 = 80
2. 3 × 5 = 15
3. 6 × 5 = 30
4. 4 × 2 = 8
5. 6 × 8 = 48
6. 5 × 7 = 35
7. 3 × 4 = 12
8. 6 × 7 = 42
9. 2 × 8 = 16
10. 8 × 7 = 56
11. 8 × 3 = 24

1-10	91	82	73	64	55	45	36	27	18	9
11	0									