Написание задач на умножение (визуальное)

Имя:

Перепишите каждую матрицу в виде умножения и решите.

обр)



1)



2)

3)



4)



5)

6)



7)

8)

9)



10)



11)



Ответы

обр. 10 × 8 = 80

1. _____
2. _____
3. _____
4. _____
5. _____
6. _____
7. _____
8. _____
9. _____
10. _____
11. _____

1-10	91	82	73	64	55	45	36	27	18	9
11	0									

Написание задач на умножение (визуальное)

Имя: **Ключ к правильным ответам**

Перепишите каждую матрицу в виде умножения и решите.

обр)



1)



2)

3)



4)



5)

6)



7)

8)

9)



10)



11)



Ответы

обр. **10 × 8 = 80**

1. **6 × 6 = 36**
2. **7 × 9 = 63**
3. **7 × 5 = 35**
4. **9 × 7 = 63**
5. **4 × 2 = 8**
6. **6 × 7 = 42**
7. **3 × 10 = 30**
8. **3 × 2 = 6**
9. **7 × 8 = 56**
10. **8 × 6 = 48**
11. **5 × 10 = 50**

1-10	91	82	73	64	55	45	36	27	18	9
11	0									